Identificazione del volume di una scatola

Nome:

Determina il volume di ciascuna scatola. Ogni blocco è 1 unità cubica (u 3).

1)

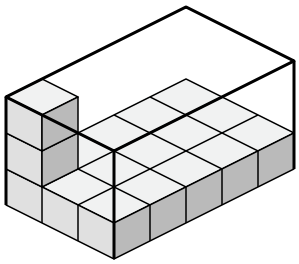

2)

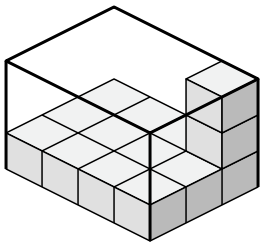

3)

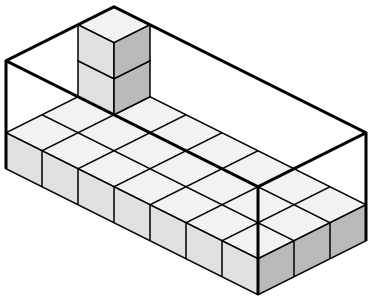

4)

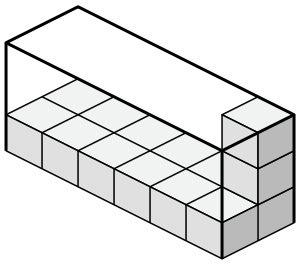

5)

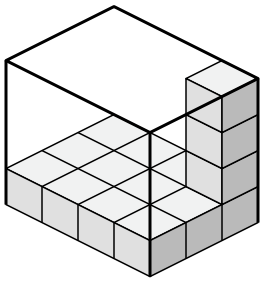

6)

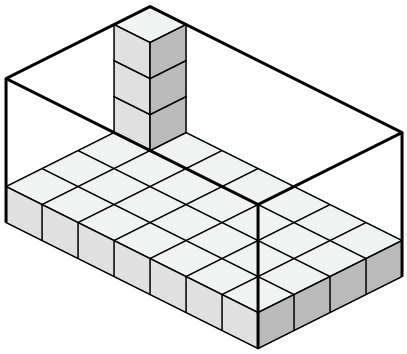

7)

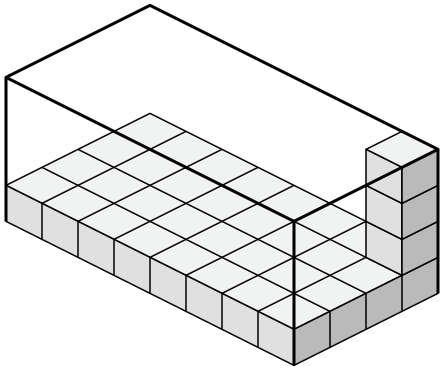

8)

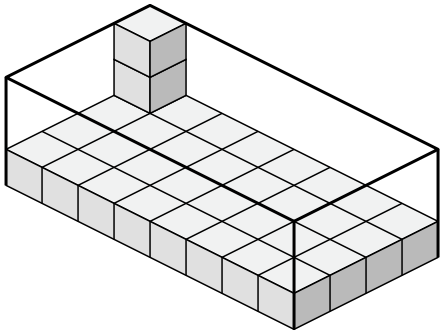

Risposte

1. _____
2. _____
3. _____
4. _____
5. _____
6. _____
7. _____
8. _____

1-8	88	75	63	50	38	25	13	0

Identificazione del volume di una scatola Nome: **Soluzioni**

Determina il volume di ciascuna scatola. Ogni blocco è 1 unità cubica (u 3).

1)

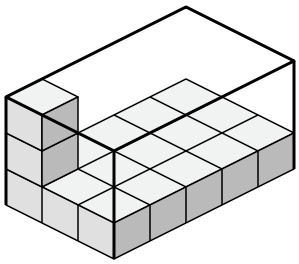

2)

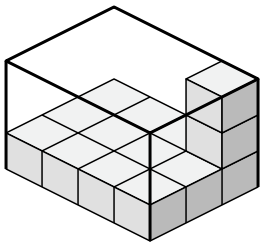

3)

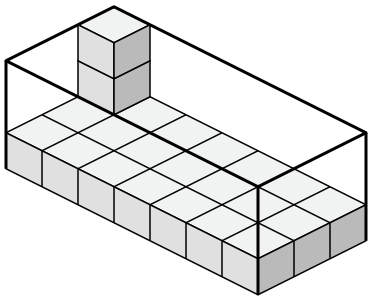

4)

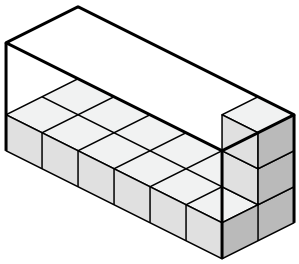

5)

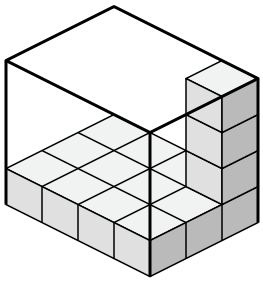

6)

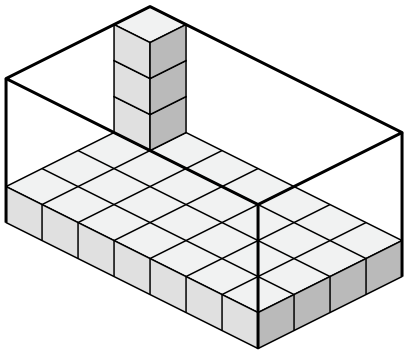

7)

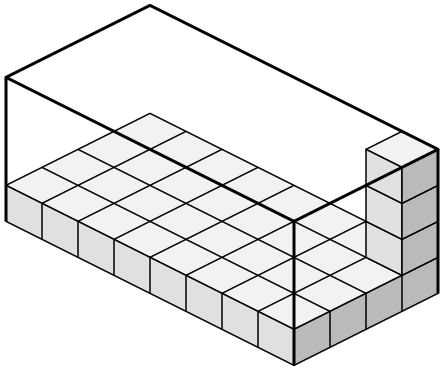

8)

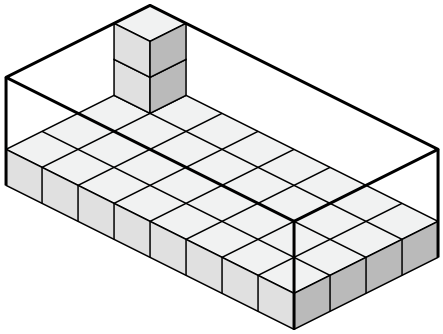

Risposte

1. **45 u^3**
2. **36 u^3**
3. **63 u^3**
4. **36 u^3**
5. **48 u^3**
6. **112 u^3**
7. **128 u^3**
8. **96 u^3**

1-8	88	75	63	50	38	25	13	0