Completamento e corrispondenza delle equazioni di volume Nome:

Collega ogni problema con l'equazione che potrebbe rappresentarlo. Rispondi con il termine e la lettera mancanti.

Es) 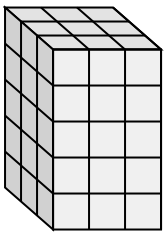

1) 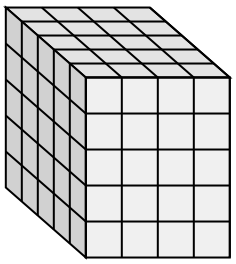

2) 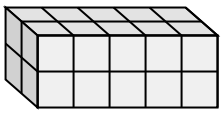

3) 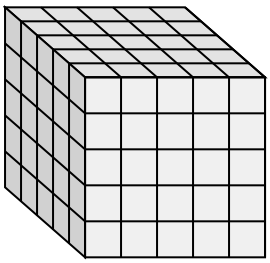

4) 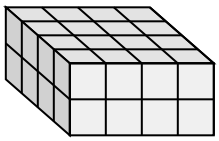

5) 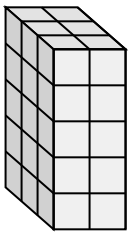

6) 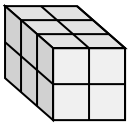

7) 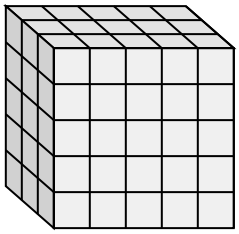

8) 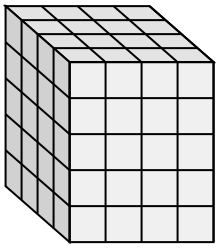

9) 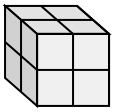

10) 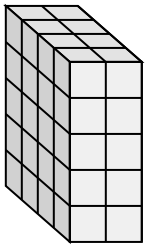

11) 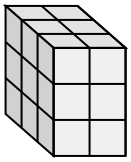

A. 2 × ___ × 2 = 20

B. 4 × 2 × ___ = 40

C. 3 × 5 × 5 = ___

D. ___ × 2 × 5 = 30

E. 2 × 2 × ___ = 8

F. 3 × 2 × 3 = ___

G. 3 × 2 × ___ = 12

H. 5 × 4 × 5 = ___

I. ___ × 4 × 5 = 80

J. 5 × 5 × ___ = 125

K. 4 × ___ × 2 = 32

L. 3 × ___ × 5 = 45

Risposte

Es. L , 3

1. _____

2. _____

3. _____

4. _____

5. _____

6. _____

7. _____

8. _____

9. _____

10. _____

11. _____

1-10	91	82	73	64	55	45	36	27	18	9
11	0									

Completamento e corrispondenza delle equazioni di volume Nome: **Soluzioni**

Collega ogni problema con l'equazione che potrebbe rappresentarlo. Rispondi con il termine e la lettera mancanti.

Es) 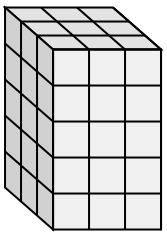

1) 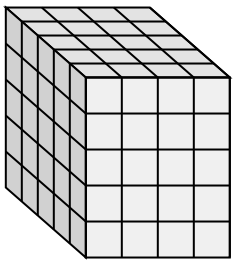

2) 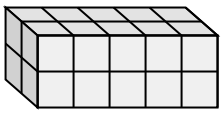

3) 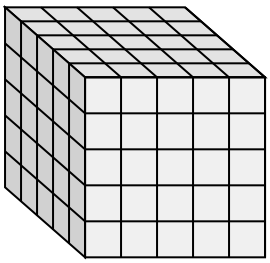

4) 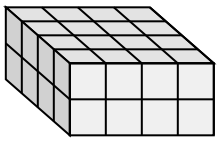

5) 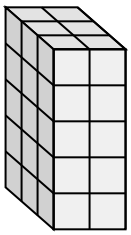

6) 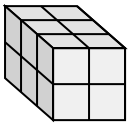

7) 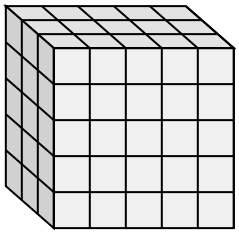

8) 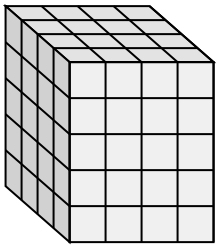

9) 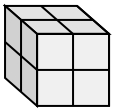

10) 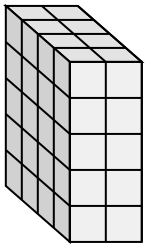

11) 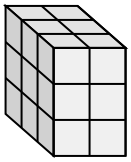

A. 2 × ___ × 2 = 20

B. 4 × 2 × ___ = 40

C. 3 × 5 × 5 = ___

D. ___ × 2 × 5 = 30

E. 2 × 2 × ___ = 8

F. 3 × 2 × 3 = ___

G. 3 × 2 × ___ = 12

H. 5 × 4 × 5 = ___

I. ___ × 4 × 5 = 80

J. 5 × 5 × ___ = 125

K. 4 × ___ × 2 = 32

L. 3 × ___ × 5 = 45

Risposte

Es.	L , 3
1.	H , 100
2.	A , 5
3.	J , 5
4.	K , 4
5.	D , 3
6.	G , 2
7.	C , 75
8.	I , 4
9.	E , 2
10.	B , 5
11.	F , 18

1-10	91	82	73	64	55	45	36	27	18	9
11	0									