Trovare l'angolo mancante

Nome:

Calcola il valore di 'A'.

1)

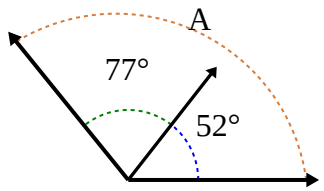

2)

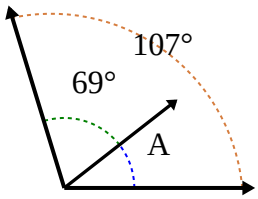

3)

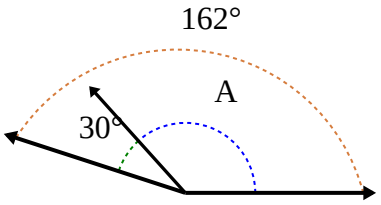

4)

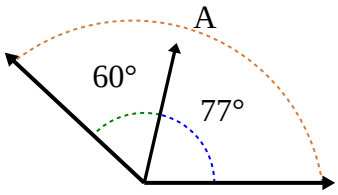

5)

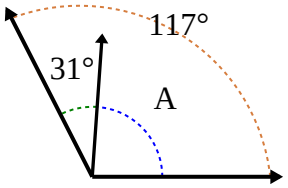

6)

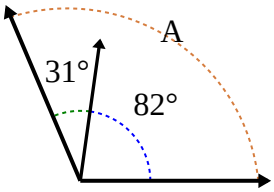

7)

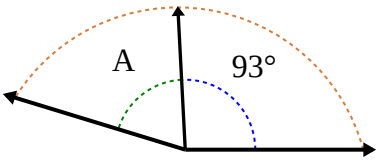

8)

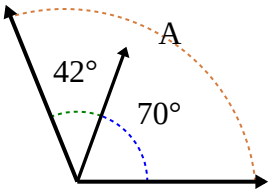

9)

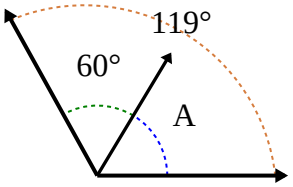

10)

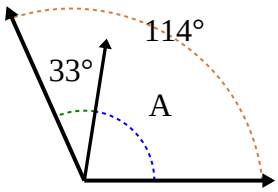

11)

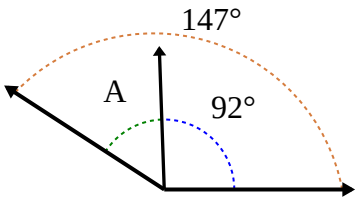

12)

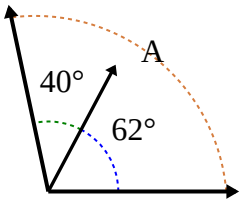

Risposte

1. _____
2. _____
3. _____
4. _____
5. _____
6. _____
7. _____
8. _____
9. _____
10. _____
11. _____
12. _____

1-10	92	83	75	67	58	50	42	33	25	17
11-12	8	0								

Trovare l'angolo mancante

Nome: **Soluzioni**

Calcola il valore di 'A'.

1)

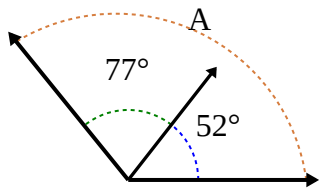

2)

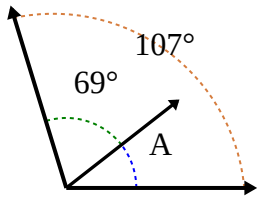

3)

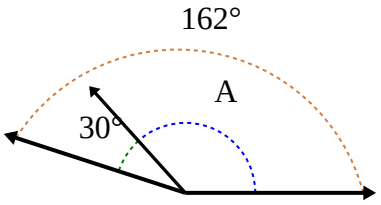

4)

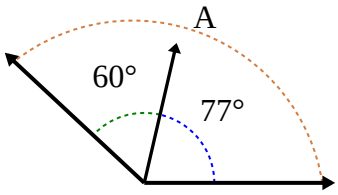

5)

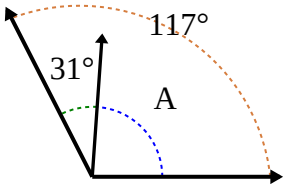

6)

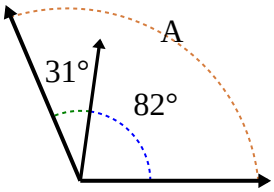

7)

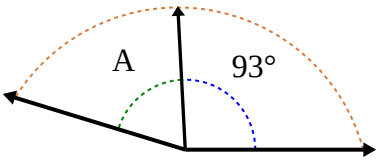

8)

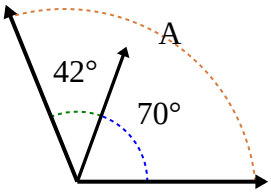

9)

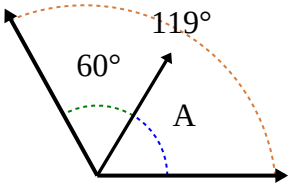

10)

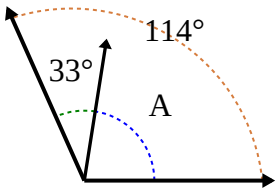

11)

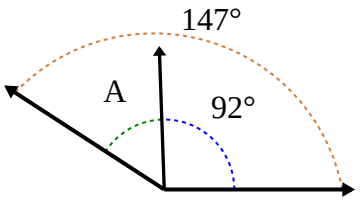

12)

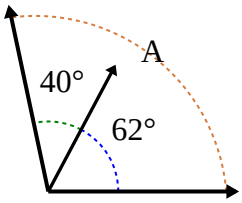

Risposte

1. **129**
2. **38**
3. **132**
4. **137**
5. **86**
6. **113**
7. **70**
8. **112**
9. **59**
10. **81**
11. **55**
12. **102**

1-10	92	83	75	67	58	50	42	33	25	17
11-12	8	0								