Trovare gli angoli nei cerchi

Nome:

Trova l'angolo (in gradi) della parte ombreggiata del cerchio.

1)

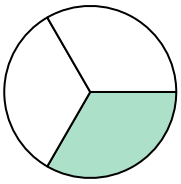

2)

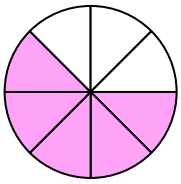

3)

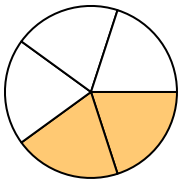

4)

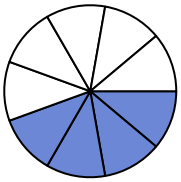

5)

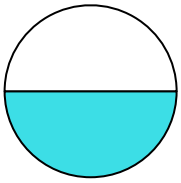

6)

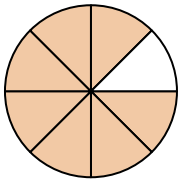

7)

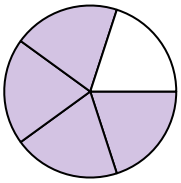

8)

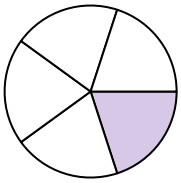

9)

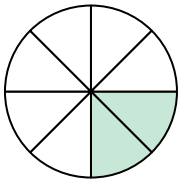

10)

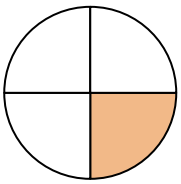

11)

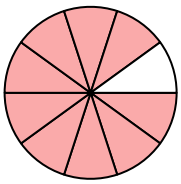

12)

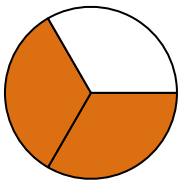

13)

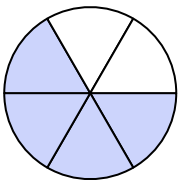

14)

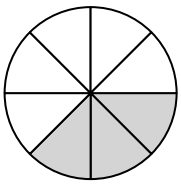

15)

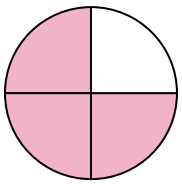

Risposte

1. _____
2. _____
3. _____
4. _____
5. _____
6. _____
7. _____
8. _____
9. _____
10. _____
11. _____
12. _____
13. _____
14. _____
15. _____

1-10	93	87	80	73	67	60	53	47	40	33
11-15	27	20	13	7	0					

Trovare gli angoli nei cerchi

Nome: **Soluzioni**

Trova l'angolo (in gradi) della parte ombreggiata del cerchio.

1)

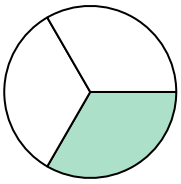

2)

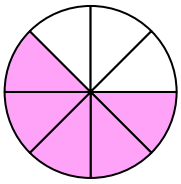

3)

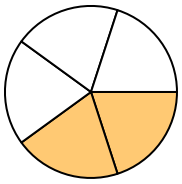

4)

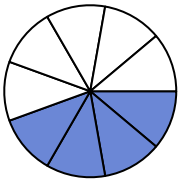

5)

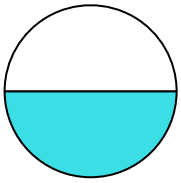

6)

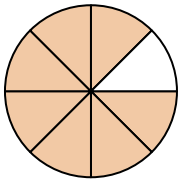

7)

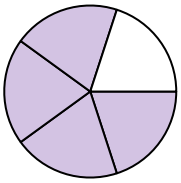

8)

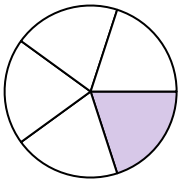

9)

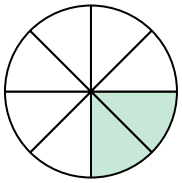

10)

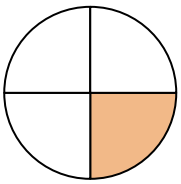

11)

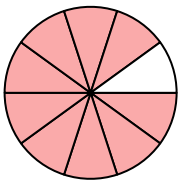

12)

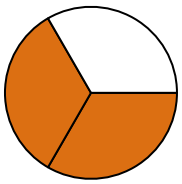

13)

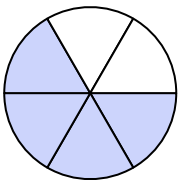

14)

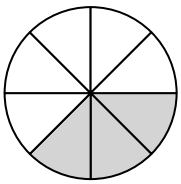

15)

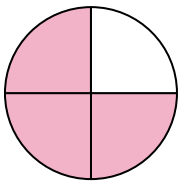

Risposte

1. **120**
2. **225**
3. **144**
4. **160**
5. **180**
6. **315**
7. **288**
8. **72**
9. **90**
10. **90**
11. **324**
12. **240**
13. **240**
14. **135**
15. **270**

1-10	93	87	80	73	67	60	53	47	40	33
11-15	27	20	13	7	0					

Trovare gli angoli nei cerchi

Nome:

Trova l'angolo (in gradi) della parte ombreggiata del cerchio.

315	120	240	72	90
225	324	160	180	288
90	144			

1)

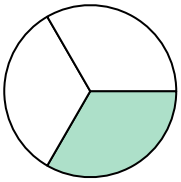

2)

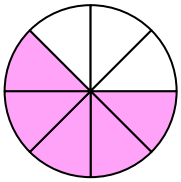

3)

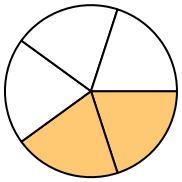

4)

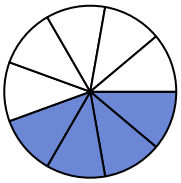

5)

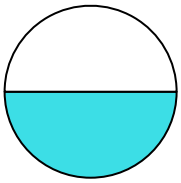

6)

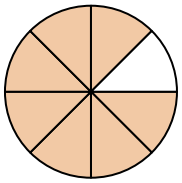

7)

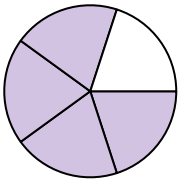

8)

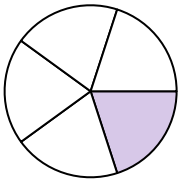

9)

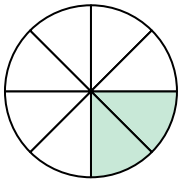

10)

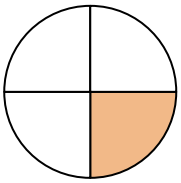

11)

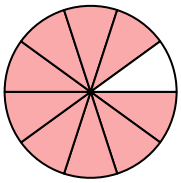

12)

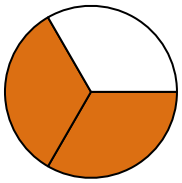

Risposte

1. _____
2. _____
3. _____
4. _____
5. _____
6. _____
7. _____
8. _____
9. _____
10. _____
11. _____
12. _____

1-10	92	83	75	67	58	50	42	33	25	17
11-12	8	0								