Trovare l'angolo tra due punti

Nome:

Calcola l'angolo del cerchio rispetto a (0,0).

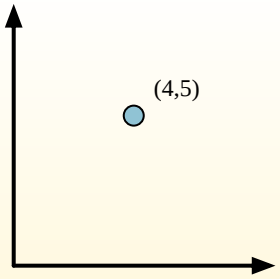

Primero encuentra la pendiente.

$(y_2-y_1)\div(x_2-x_1) = m$

$(5-0)\div(4-0) =$ **1.25**

Em seguida, encontre o arco da tangente (também conhecido como tangente inversa) da inclinação.

arctan(1.25) = **51.34°**

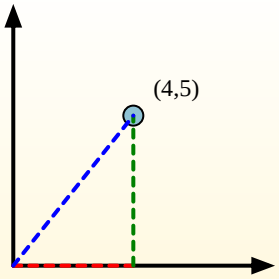

1)

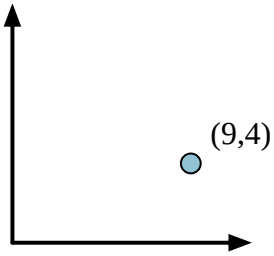

2)

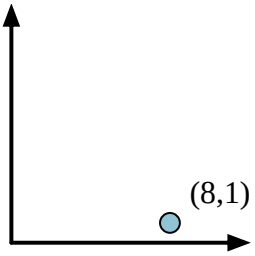

3)

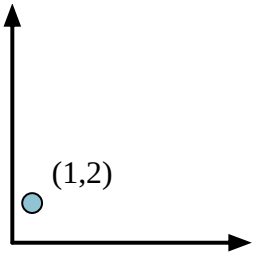

4)

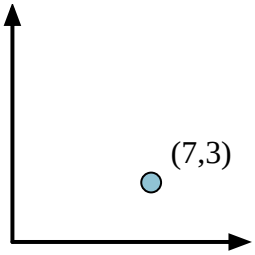

5)

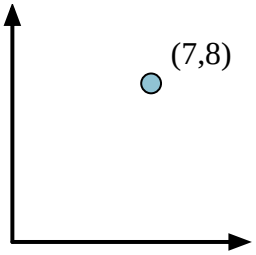

6)

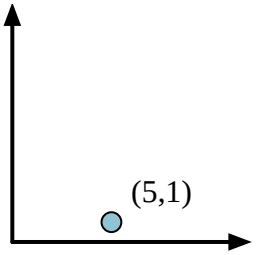

7)

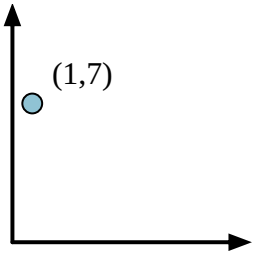

8)

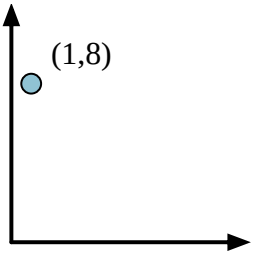

9)

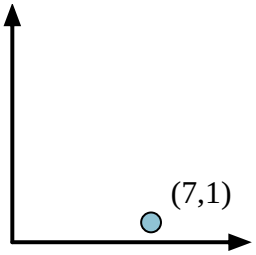

10)

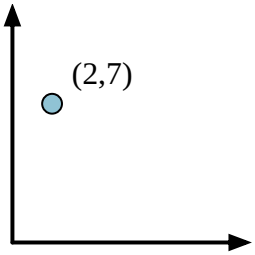

11)

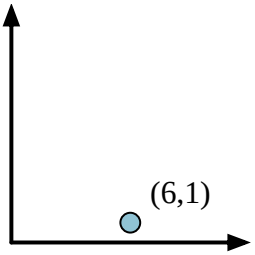

12)

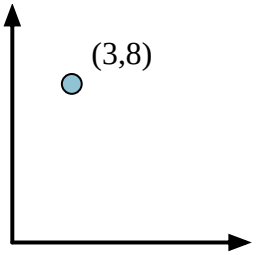

Risposte

1. _____
2. _____
3. _____
4. _____
5. _____
6. _____
7. _____
8. _____
9. _____
10. _____
11. _____
12. _____

1-10	92	83	75	67	58	50	42	33	25	17
11-12	8	0								

Trovare l'angolo tra due punti

Nome: **Soluzioni**

Calcola l'angolo del cerchio rispetto a (0,0).

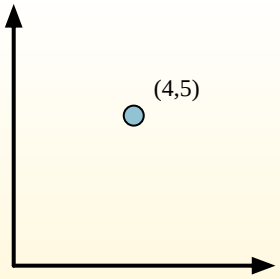

Primero encuentra la pendiente.

$(y_2-y_1)\div(x_2-x_1) = m$

$(5-0)\div(4-0) = \mathbf{1.25}$

Em seguida, encontre o arco da tangente (também conhecido como tangente inversa) da inclinação.

$\arctan(1.25) = \mathbf{51.34°}$

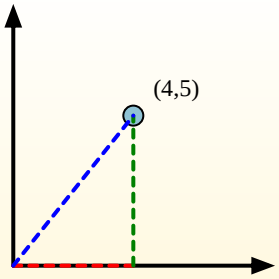

1)

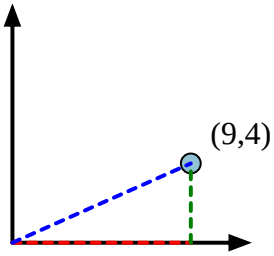

2)

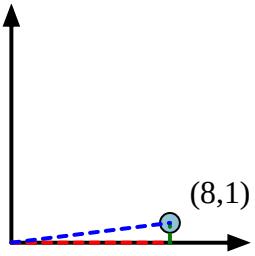

3)

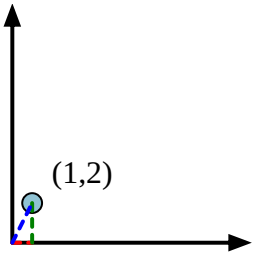

4)

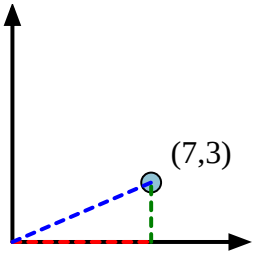

5)

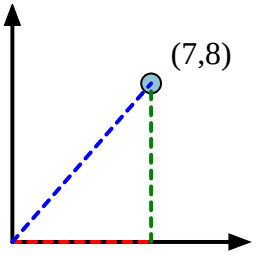

6)

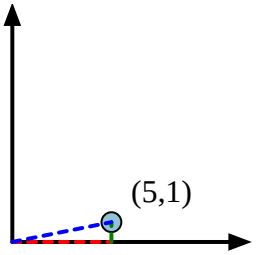

7)

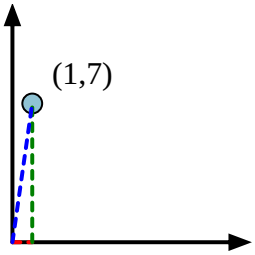

8)

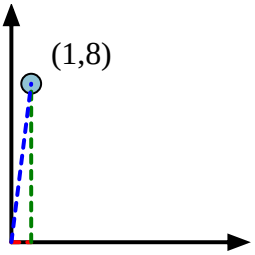

9)

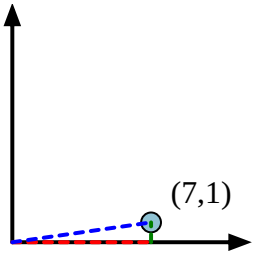

10)

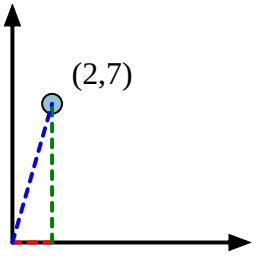

11)

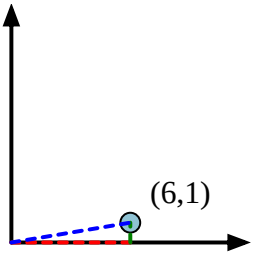

12)

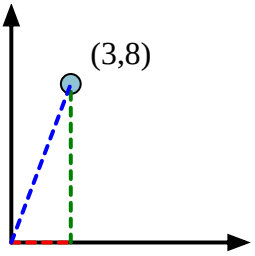

Risposte

1. **23,96**
2. **7,13**
3. **63,43**
4. **23,20**
5. **48,81**
6. **11,31**
7. **81,87**
8. **82,87**
9. **8,13**
10. **74,05**
11. **9,46**
12. **69,44**

1-10	92	83	75	67	58	50	42	33	25	17
11-12	8	0								