Leggere linee numerate non tradizionali

Nome:

**Trova il valore di R.**

**1)**

**2)**

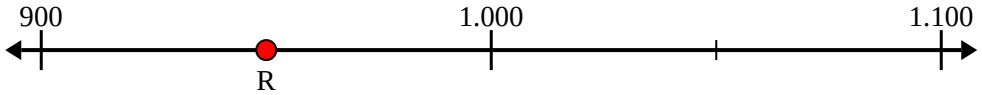


**3)**

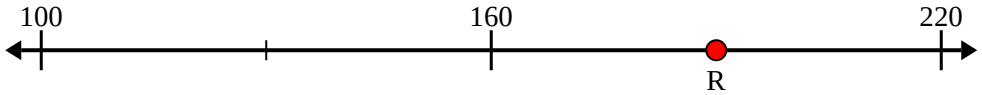


**4)**

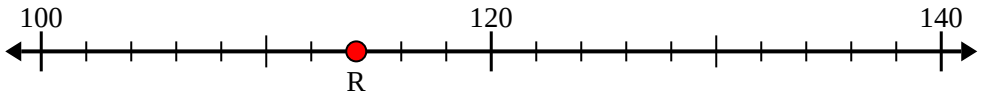


**5)**

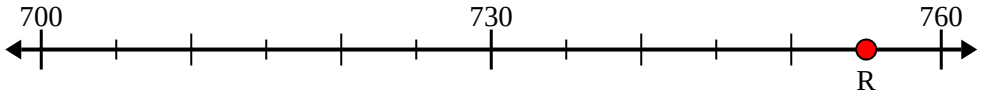


**6)**

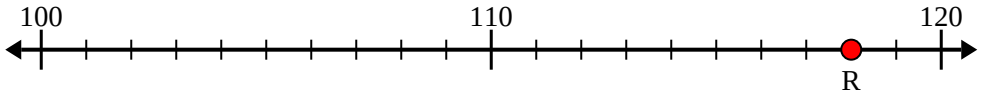


**7)**

**8)**

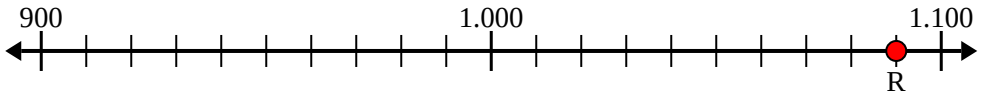


**9)**

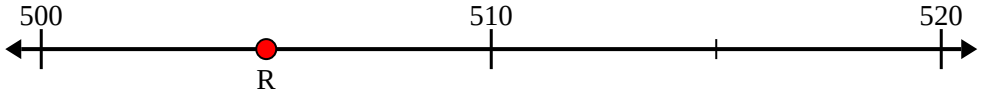


**10)**

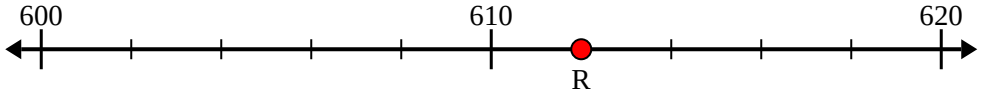


**Risposte**

1. _____
2. _____
3. _____
4. _____
5. _____
6. _____
7. _____
8. _____
9. _____
10. _____

| 1-10 | 90 | 80 | 70 | 60 | 50 | 40 | 30 | 20 | 10 | 0 |
|---|---|---|---|---|---|---|---|---|---|---|

Leggere linee numerate non tradizionali

Nome: **Soluzioni**

**Trova il valore di R.**

**1)**

**2)**

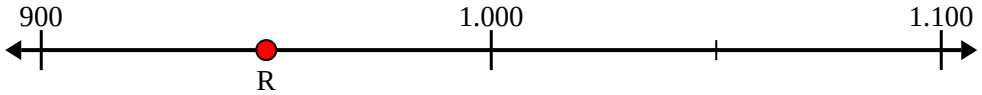


**3)**

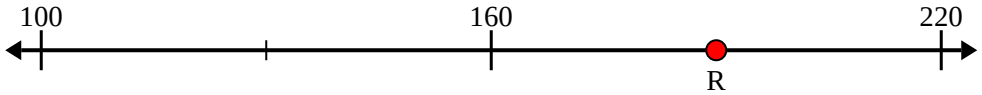


**4)**

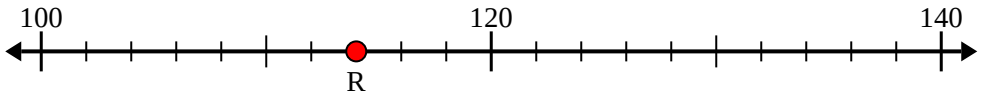


**5)**

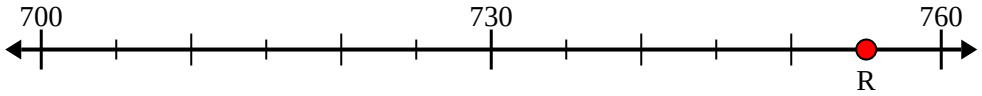


**6)**

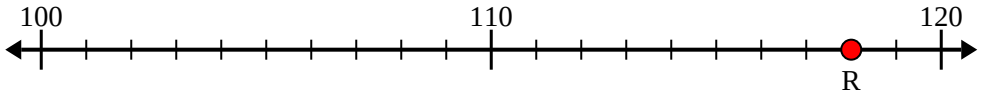


**7)**

**8)**

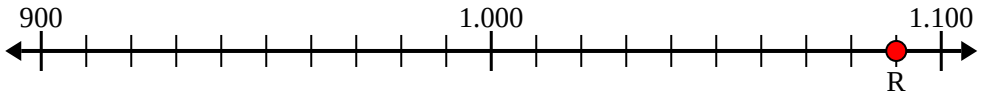


**9)**

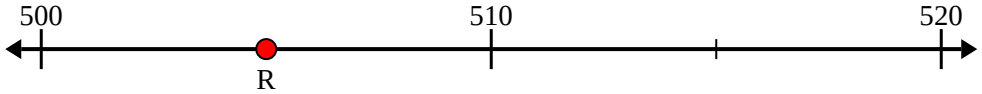


**10)**

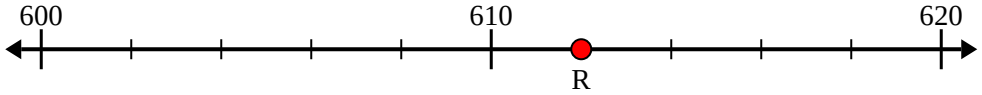


**Risposte**

1. **560**
2. **950**
3. **190**
4. **114**
5. **755**
6. **118**
7. **615**
8. **1.090**
9. **505**
10. **612**



| 1-10 | 90 | 80 | 70 | 60 | 50 | 40 | 30 | 20 | 10 | 0 |
|---|---|---|---|---|---|---|---|---|---|---|