Identificazione della quantità con 100 blocchi Nome:

Utilizzare i blocchi per determinare le quantità totali.

Es) 

5 centinaia = 50 decine = 500 unità

1) 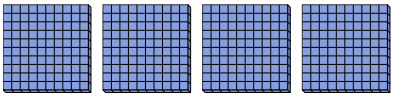

_____ centinaia = _____ decine = _____ unità

2) 

_____ centinaia = _____ decine = _____ unità

3) 

_____ centinaia = _____ decine = _____ unità

4) 

_____ centinaia = _____ decine = _____ unità

5)

_____ centinaia = _____ decine = _____ unità

6) 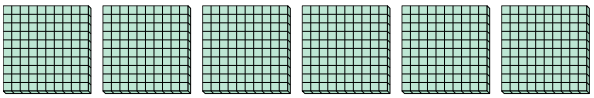

_____ centinaia = _____ decine = _____ unità

7) 

_____ centinaia = _____ decine = _____ unità

8) 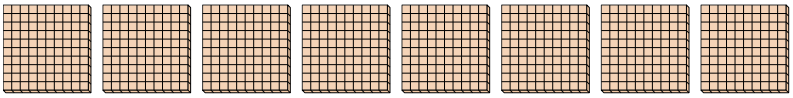

_____ centinaia = _____ decine = _____ unità

Risposte

Es.	5	50	500
1.			
2.			
3.			
4.			
5.			
6.			
7.			
8.			

1-8	88	75	63	50	38	25	13	0

Identificazione della quantità con 100 blocchi

Nome: **Soluzioni**

Utilizzare i blocchi per determinare le quantità totali.

Es) 

5 centinaia = 50 decine = 500 unità

1) 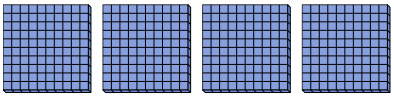

4 centinaia = 40 decine = 400 unità

2) 

3 centinaia = 30 decine = 300 unità

3) 

2 centinaia = 20 decine = 200 unità

4) 

9 centinaia = 90 decine = 900 unità

5)

1 centinaia = 10 decine = 100 unità

6) 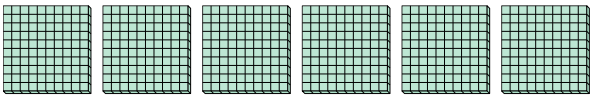

6 centinaia = 60 decine = 600 unità

7) 

7 centinaia = 70 decine = 700 unità

8) 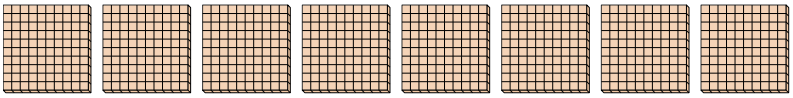

8 centinaia = 80 decine = 800 unità

Risposte

Es.	5	50	500
1.	4	40	400
2.	3	30	300
3.	2	20	200
4.	9	90	900
5.	1	10	100
6.	6	60	600
7.	7	70	700
8.	8	80	800

1-8	88	75	63	50	38	25	13	0