# Creazione di gruppi di 100

Nome:

**Determina quanti gruppi di 100 possono essere creati dai blocchi mostrati.**

**Es)**

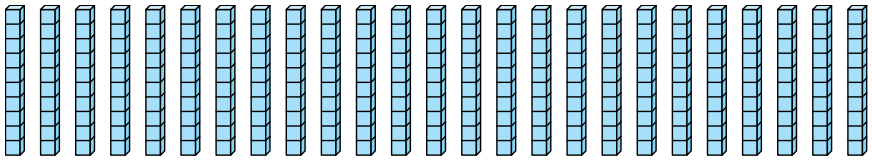

**1)**

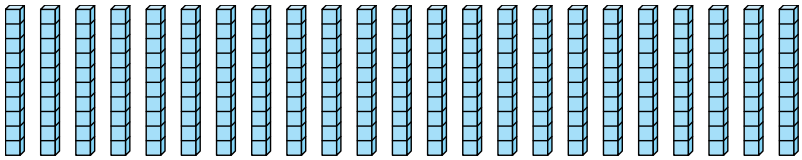

**2)**

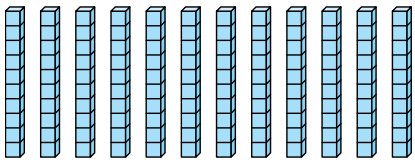

**3)**

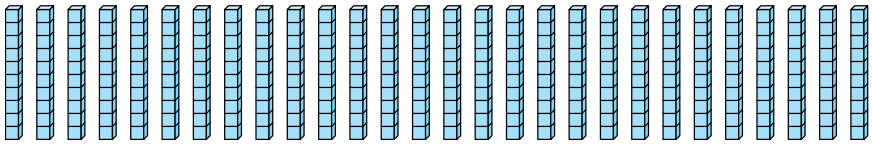

**4)**

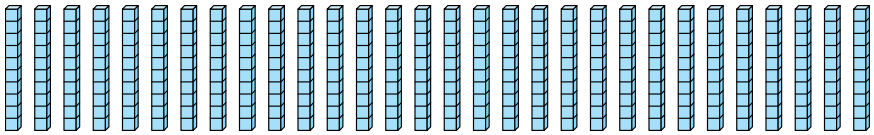

**5)**

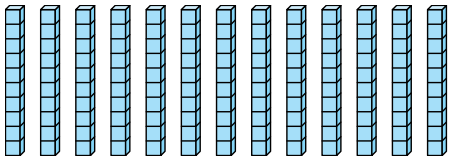

**6)**

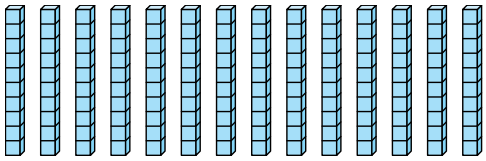

**7)**

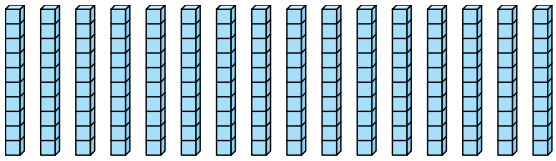

**8)**

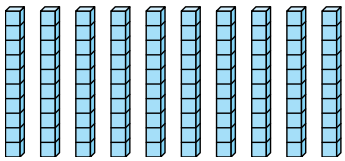

**9)**

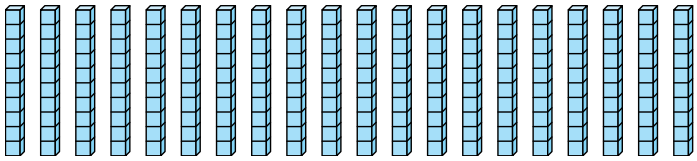

## Risposte

Es. 2

1. _____

2. _____

3. _____

4. _____

5. _____

6. _____

7. _____

8. _____

9. _____



| 1-9 | 89 | 78 | 67 | 56 | 44 | 33 | 22 | 11 | 0 |
|---|---|---|---|---|---|---|---|---|---|

Creazione di gruppi di 100 Nome: **Soluzioni**

**Determina quanti gruppi di 100 possono essere creati dai blocchi mostrati.**

**Es)** 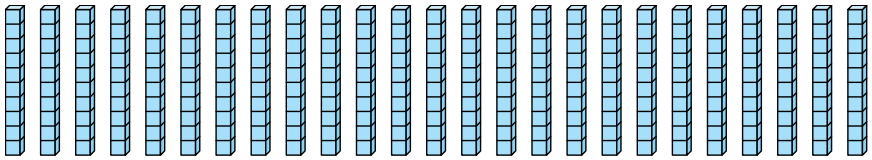

**1)** 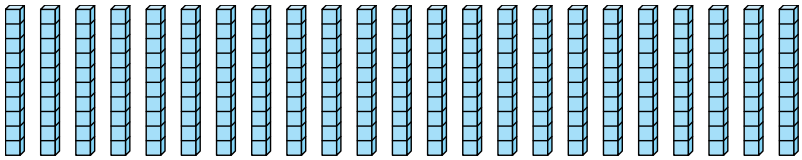

**2)** 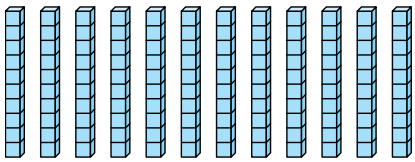

**3)** 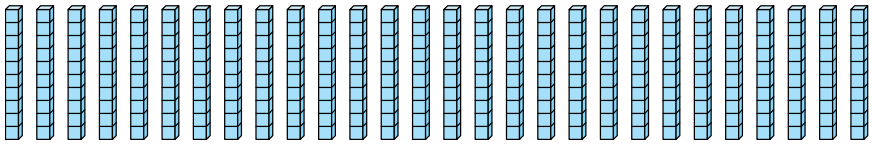

**4)** 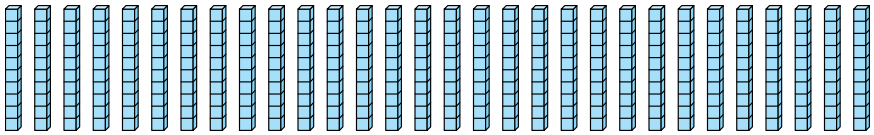

**5)** 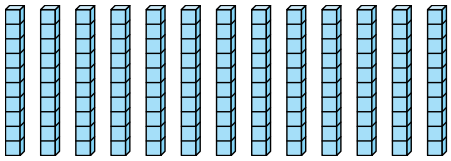

**6)** 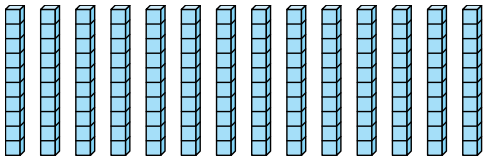

**7)** 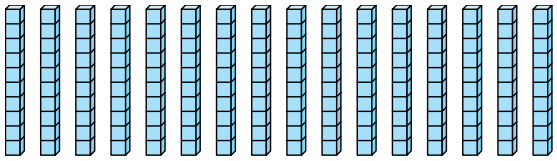

**8)** 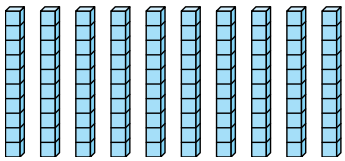

**9)** 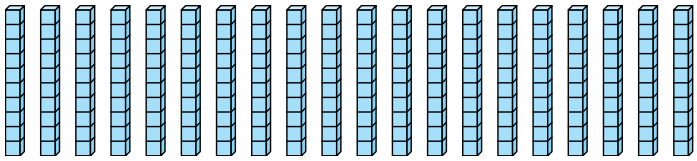

**Risposte**

| | |
|---|---|
| Es. | 2 |
| 1. | 2 |
| 2. | 1 |
| 3. | 2 |
| 4. | 3 |
| 5. | 1 |
| 6. | 1 |
| 7. | 1 |
| 8. | 1 |
| 9. | 2 |



| 1-9 | 89 | 78 | 67 | 56 | 44 | 33 | 22 | 11 | 0 |
|---|---|---|---|---|---|---|---|---|---|