Leggere l'orologio analogico

Nome:

Leggi l'ora mostrata da ciascun orologio.

1) 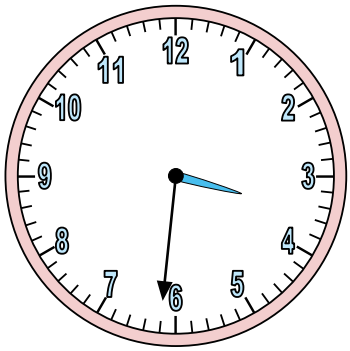

2) 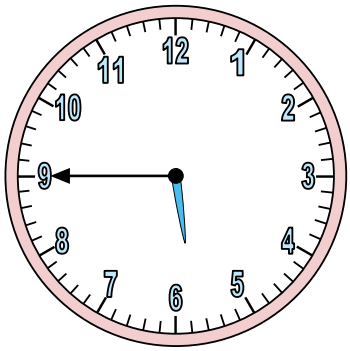

3) 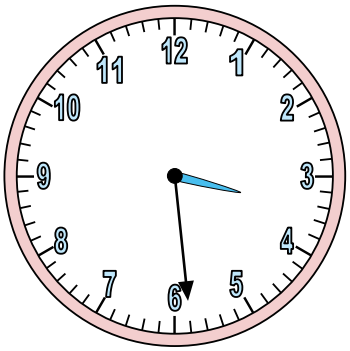

4) 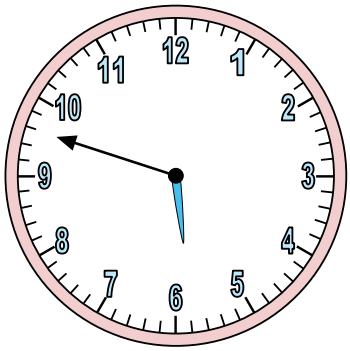

5) 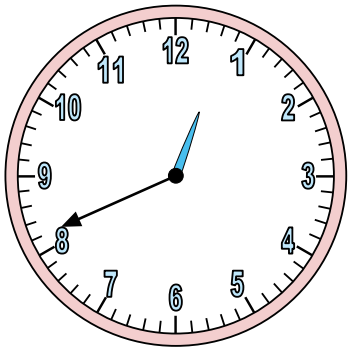

6) 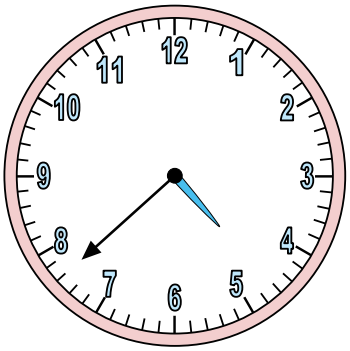

7) 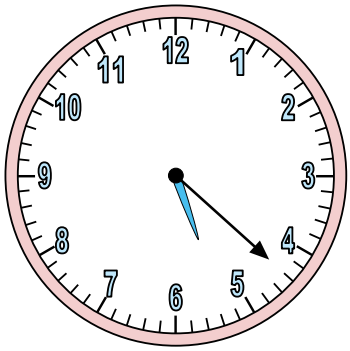

8) 

9) 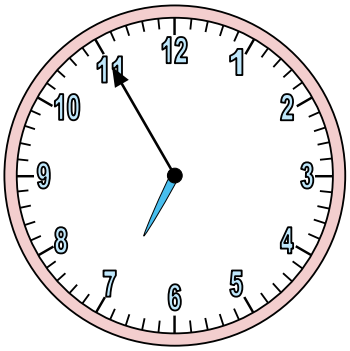

10) 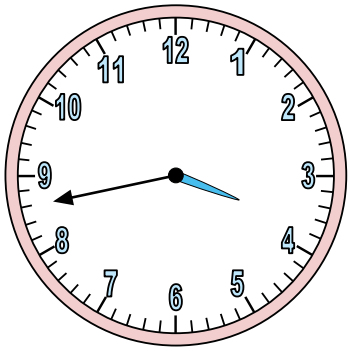

11) 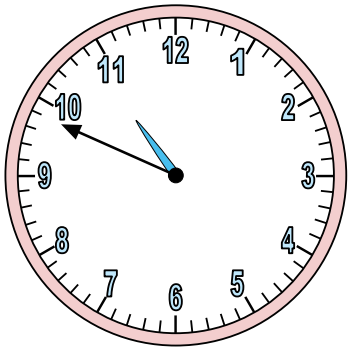

12) 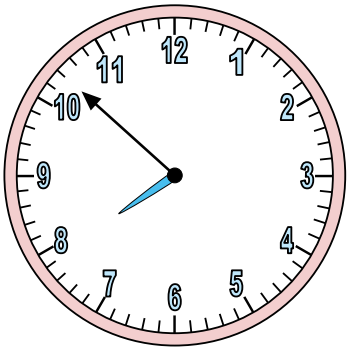

Risposte

1. _____
2. _____
3. _____
4. _____
5. _____
6. _____
7. _____
8. _____
9. _____
10. _____
11. _____
12. _____

1-10	92	83	75	67	58	50	42	33	25	17
11-12	8	0								

Leggere l'orologio analogico

Nome: **Soluzioni**

Leggi l'ora mostrata da ciascun orologio.

1) 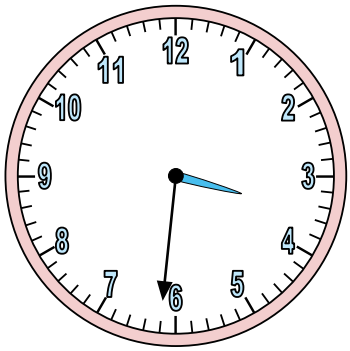

2) 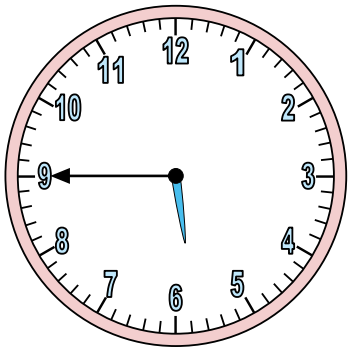

3) 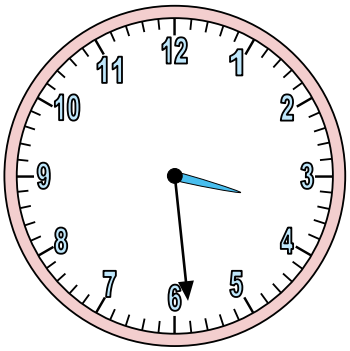

4) 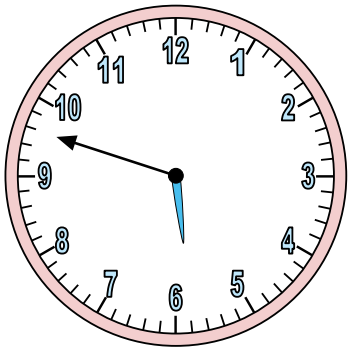

5) 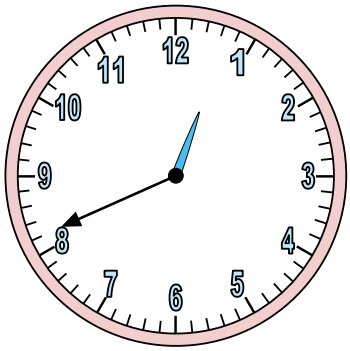

6) 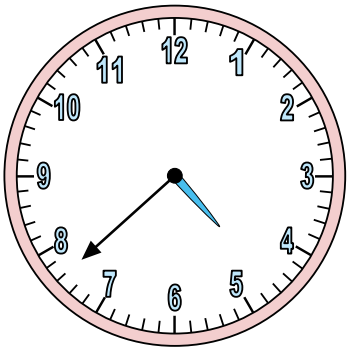

7) 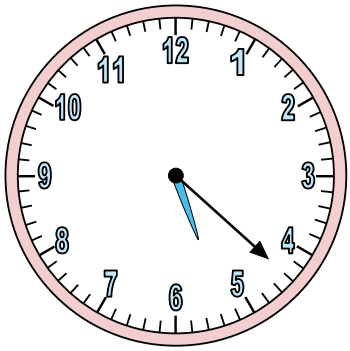

8) 

9) 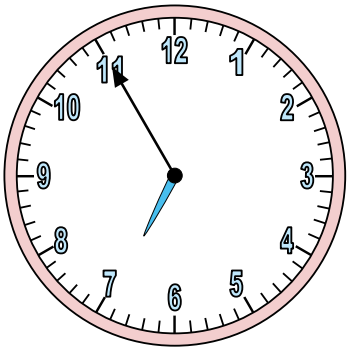

10) 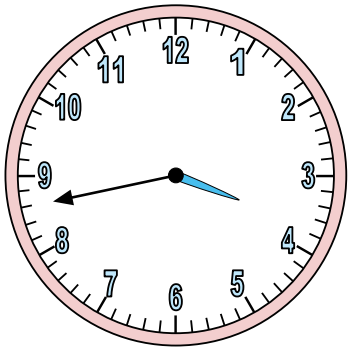

11) 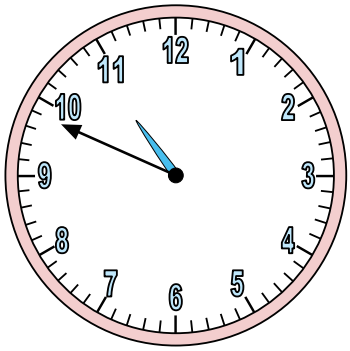

12) 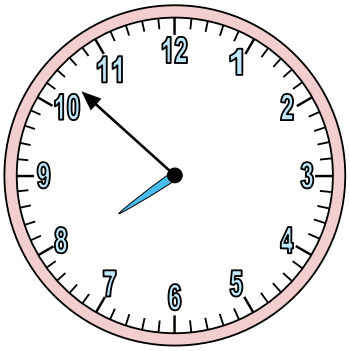

Risposte

1. **3:31**
2. **5:45**
3. **3:29**
4. **5:48**
5. **12:41**
6. **4:38**
7. **5:22**
8. **12:50**
9. **6:55**
10. **3:43**
11. **10:49**
12. **7:52**

1-10	92	83	75	67	58	50	42	33	25	17
11-12	8	0								