Orologi abbinati

Nome:

Abbina l'orologio analogico all'orologio digitale.

1) 

2) 

3)

4)

5) 

6) 

7) 

8)

9) 

10) 

11) 

12) 

13) 

14) 

15) 

16) 

A. 2:00

B. 4:45

C. 10:30

D. 5:30

E. 7:45

F. 12:00

G. 6:45

H. 11:30

I. 3:15

J. 11:45

K. 5:15

L. 2:15

M. 1:45

N. 1:30

O. 12:00

P. 5:00

Risposte

1. _____
2. _____
3. _____
4. _____
5. _____
6. _____
7. _____
8. _____
9. _____
10. _____
11. _____
12. _____
13. _____
14. _____
15. _____
16. _____

1-10	94	88	81	75	69	63	56	50	44	38
11-16	31	25	19	13	6	0				

Orologi abbinati

Nome: **Soluzioni**

Abbina l'orologio analogico all'orologio digitale.

1) 
2) 
3)
4)

5) 
6) 
7) 
8)

9) 
10) 
11) 
12) 

13) 
14) 
15) 
16) 

A. 2:00
B. 4:45
C. 10:30
D. 5:30
E. 7:45
F. 12:00
G. 6:45
H. 11:30
I. 3:15
J. 11:45
K. 5:15
L. 2:15
M. 1:45
N. 1:30
O. 12:00
P. 5:00

Risposte

1. D
2. H
3. G
4. J
5. I
6. P
7. N
8. L
9. E
10. M
11. O
12. K
13. A
14. F
15. B
16. C

1-10	94	88	81	75	69	63	56	50	44	38
11-16	31	25	19	13	6	0				