Disegna la lancetta delle ore e dei minuti sull'orologio in modo che rappresenti l'ora indicata.

1) 1:30

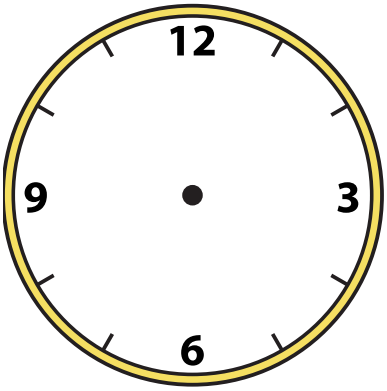

2) 8:00



3) 1:45

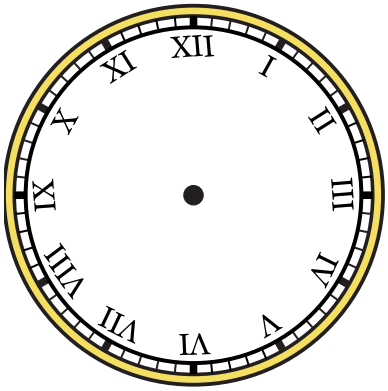

4) 12:30

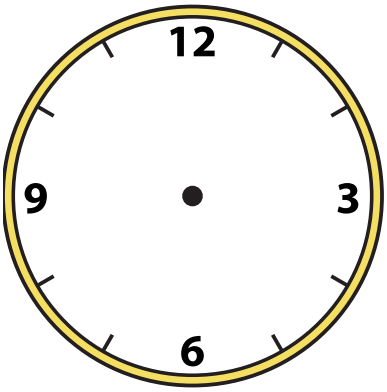

5) 4:45

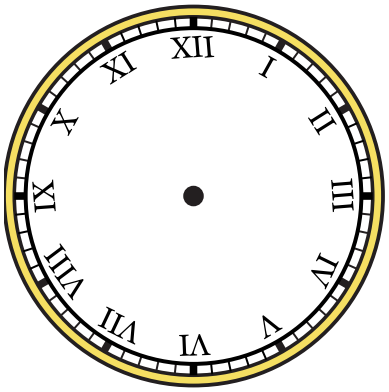

6) 10:30



7) 6:00

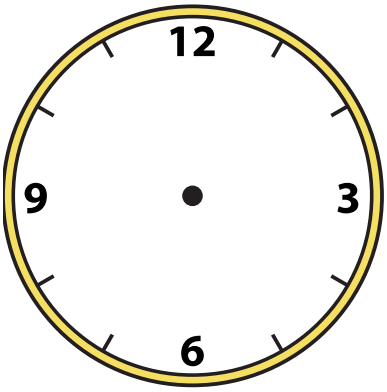

8) 2:15

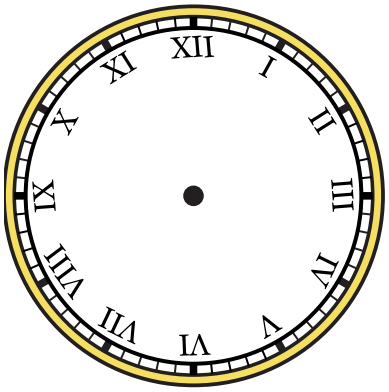

9) 4:00



1-9	89	78	67	56	44	33	22	11	0

Disegna la lancetta delle ore e dei minuti sull'orologio in modo che rappresenti l'ora indicata.

1) 1:30



2) 8:00

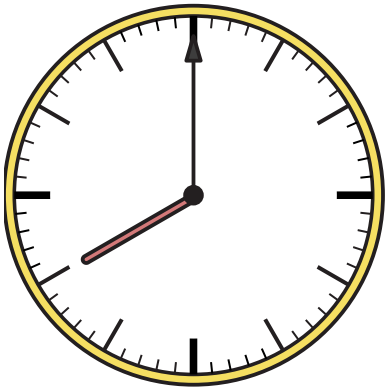

3) 1:45



4) 12:30



5) 4:45

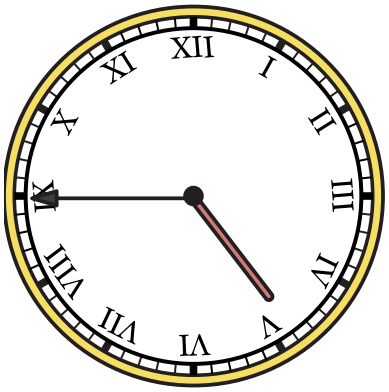

6) 10:30

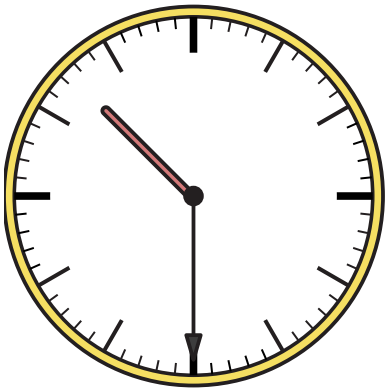

7) 6:00



8) 2:15



9) 4:00

1-9	89	78	67	56	44	33	22	11	0