Determina la simmetria

Nome:

Determina se la linea che attraversa ogni figura è un linea di simmetria.

Es)

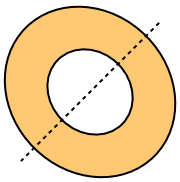

1)

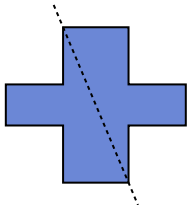

2)

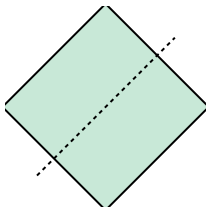

3)

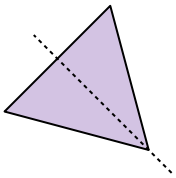

4)

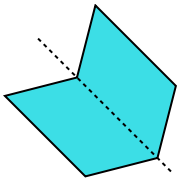

5)

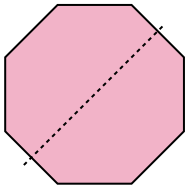

6)

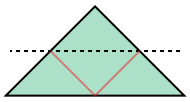

7)



8)

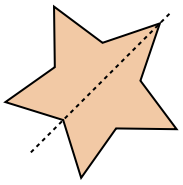

9)

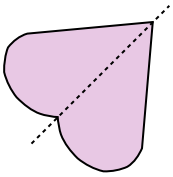

10)

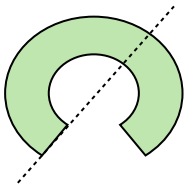

11)

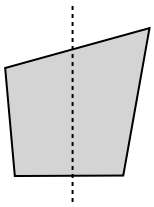

Risposte

Es. si

1. _____

2. _____

3. _____

4. _____

5. _____

6. _____

7. _____

8. _____

9. _____

10. _____

11. _____

1-10	91	82	73	64	55	45	36	27	18	9
11	0									

Determina la simmetria

Nome: **Soluzioni**

Determina se la linea che attraversa ogni figura è un linea di simmetria.

Es)

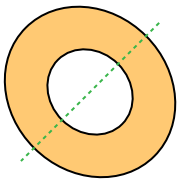

1)

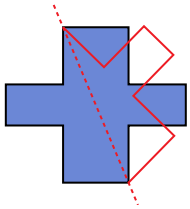

2)

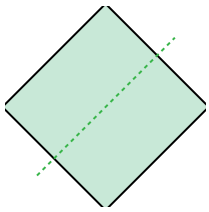

3)

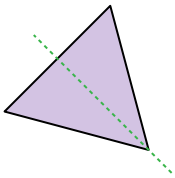

4)

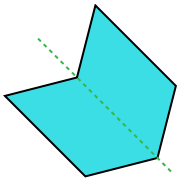

5)

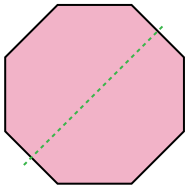

6)

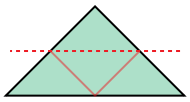

7)

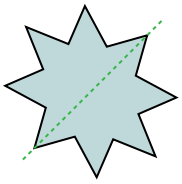

8)

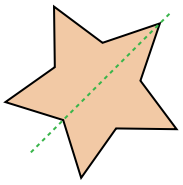

9)

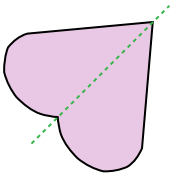

10)

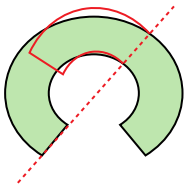

11)

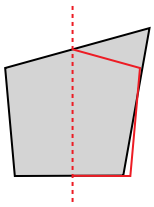

Risposte

Es.	si
1.	no
2.	si
3.	si
4.	si
5.	si
6.	no
7.	si
8.	si
9.	si
10.	no
11.	no

1-10	91	82	73	64	55	45	36	27	18	9
11	0									