Identifica le forme irregolari

Nome:

Identifica il tipo di forma rappresentata.

1)



2)

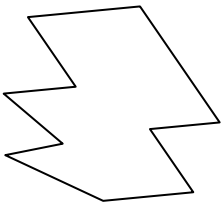

3)

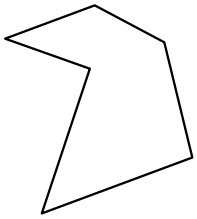

4)

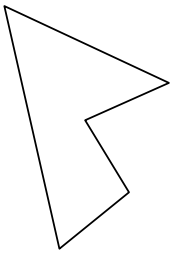

5)

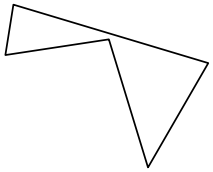

6)

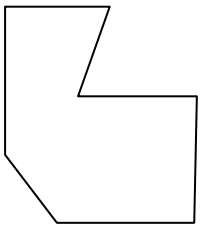

7)



8)

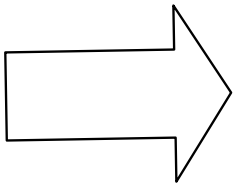

9)

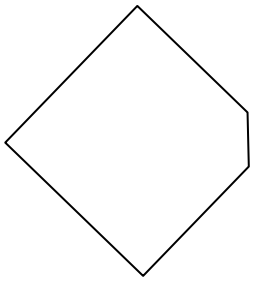

10)

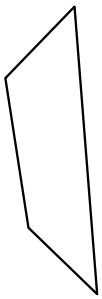

11)

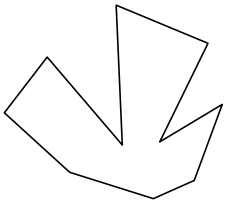

12)

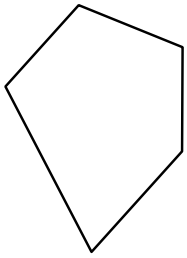

13)

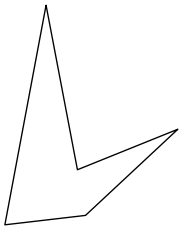

14)

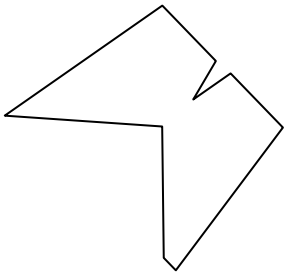

15)



16)

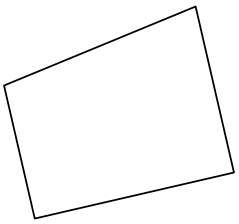

17)

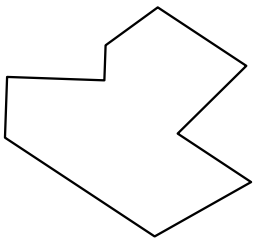

18)

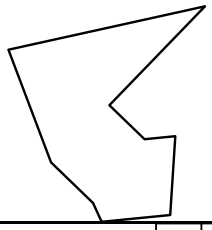

Risposte

1. _____
2. _____
3. _____
4. _____
5. _____
6. _____
7. _____
8. _____
9. _____
10. _____
11. _____
12. _____
13. _____
14. _____
15. _____
16. _____
17. _____
18. _____
19. _____
20. _____
21.

1-10	93	87	80	73	67	60	53	47	40	33
11-15	27	20	13	7	0					

Identifica le forme irregolari

Nome: **Soluzioni**

Identifica il tipo di forma rappresentata.

1)



2)

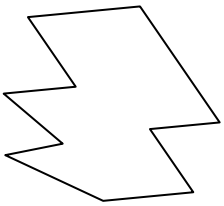

3)

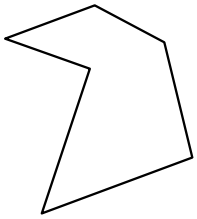

4)

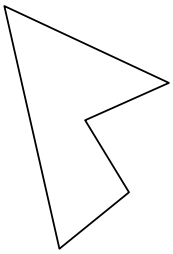

5)

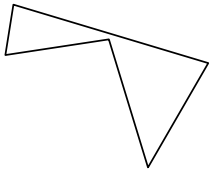

6)

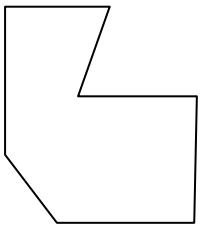

7)



8)

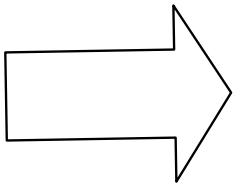

9)

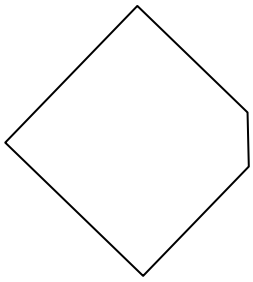

10)

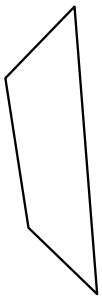

11)

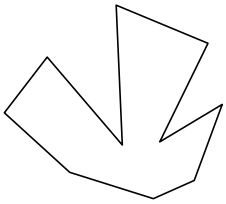

12)

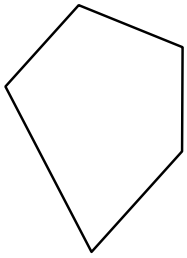

13)

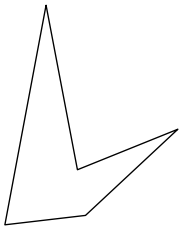

14)

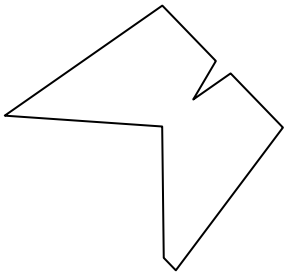

15)



16)

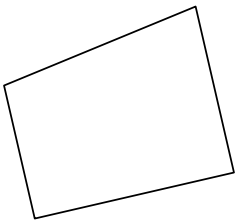

17)

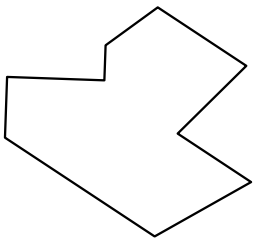

18)

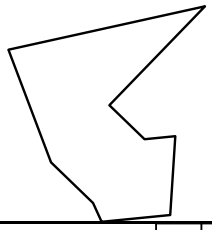

Risposte

1. Ettagono
2. Decagono
3. Esagono
4. Pentagono
5. Pentagono
6. Ettagono
7. Ennagono
8. Ettagono
9. Pentagono
10. Quadrilatero
11. Decagono
12. Pentagono
13. Pentagono
14. Ennagono
15. Ottagono
16. Quadrilatero
17. Ennagono
18. Ennagono
19. Ottagono
20. Quadrilatero
21. Ottagono

1-10	93	87	80	73	67	60	53	47	40	33
11-15	27	20	13	7	0					