Identifica le forme

Nome:

Determina se le figure rappresentate sono 'Triangolo', 'Quadrato','Rettangolo', 'Esagono' o 'Altro'.

1)

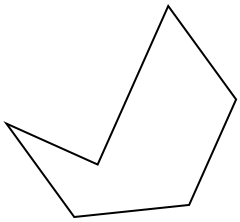

2)

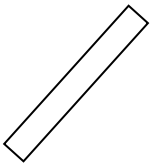

3)

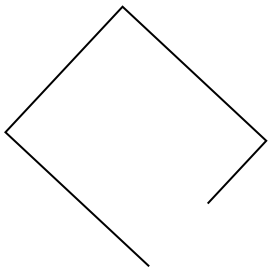

4)

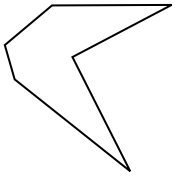

5)

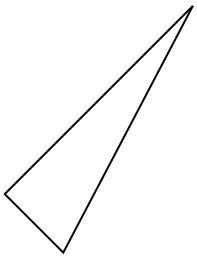

6)



7)

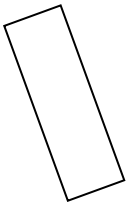

8)

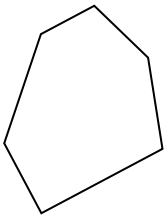

9)

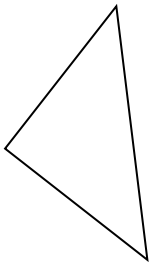

10)

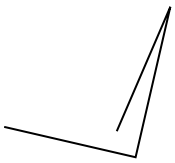

11)

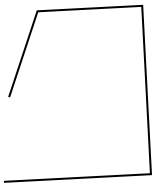

12)

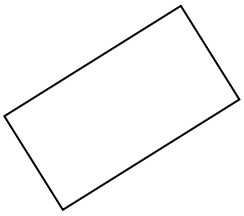

13)

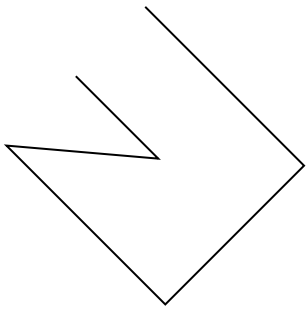

14)

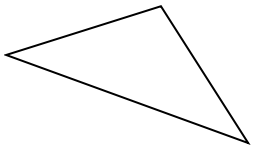

15)

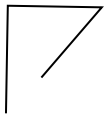

Risposte

1. _____
2. _____
3. _____
4. _____
5. _____
6. _____
7. _____
8. _____
9. _____
10. _____
11. _____
12. _____
13. _____
14. _____
15. _____

1-10	93	87	80	73	67	60	53	47	40	33
11-15	27	20	13	7	0					

Identifica le forme

Nome: **Soluzioni**

Determina se le figure rappresentate sono 'Triangolo', 'Quadrato','Rettangolo', 'Esagono' o 'Altro'.

1)

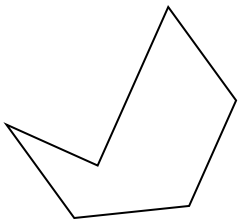

2)

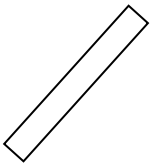

3)

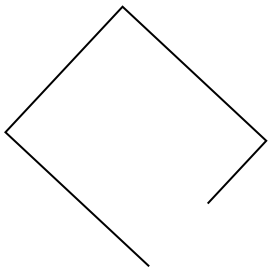

4)

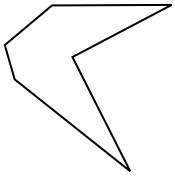

5)

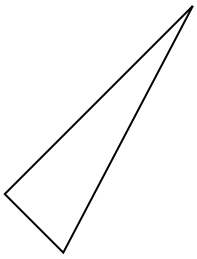

6)



7)

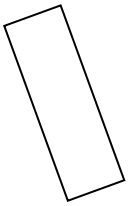

8)

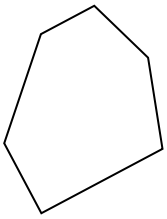

9)

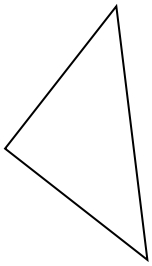

10)

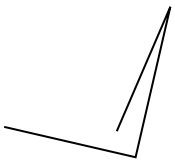

11)

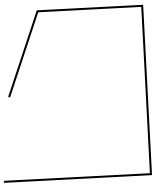

12)

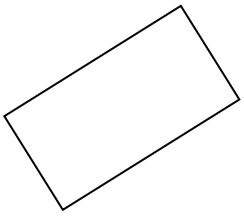

13)

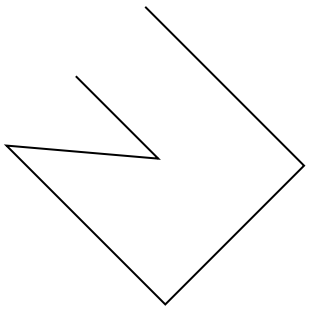

14)

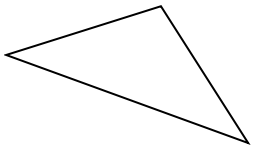

15)

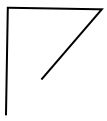

Risposte

1. Esagono
2. rectangle
3. Altro
4. Esagono
5. triangle
6. Altro
7. rectangle
8. Esagono
9. triangle
10. Altro
11. Altro
12. rectangle
13. Altro
14. triangle
15. Altro

1-10	93	87	80	73	67	60	53	47	40	33
11-15	27	20	13	7	0					