Usa il diagamma per identificare le facce, i vertici e le superfici delle forme

1)

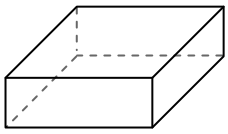

prisma rettangolare
facce: _____
vertici: _____
spigoli: _____

2)

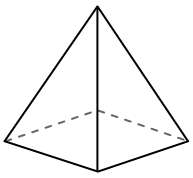

piramide rettangolare
facce: _____
vertici: _____
spigoli: _____

3)



sfera
facce: _____
vertici: _____
spigoli: _____

4)

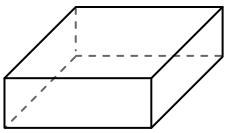

prisma rettangolare



sfera

Quale forma ha più facce?
A.prisma rettangolare
B.sfera
C.Entrambi hanno lo stesso numero di facce.

5)

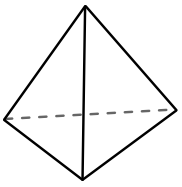

piramide triangolare

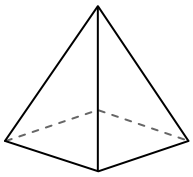

piramide rettangolare

Quale forma ha più vertici?
A.piramide triangolare
B.piramide rettangolare
C.Entrambi hanno lo stesso numero di vertici.

6)

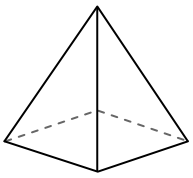

piramide rettangolare

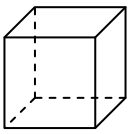

cube

Quale forma ha più spigoli?
A.piramide rettangolare
B.cube
C.Entrambi hanno lo stesso numero di spigoli.

Risposte

1. _____
2. _____
3. _____
4. _____
5. _____
6. _____

1-6	83	67	50	33	17	0

Usa il diagamma per identificare le facce, i vertici e le superfici delle forme

1)

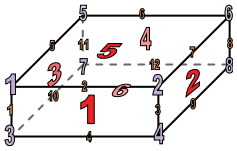

prisma rettangolare

facce: 6

vertici: 8

spigoli: 12

2)

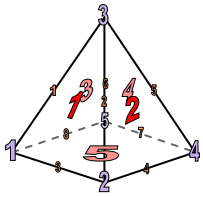

piramide rettangolare

facce: 5

vertici: 5

spigoli: 8

3)



sfera

facce: 1

vertici: 0

spigoli: 0

4)

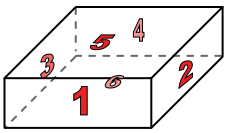

prisma rettangolare



sfera

Quale forma ha più facce?
A.prisma rettangolare
B.sfera
C.Entrambi hanno lo stesso numero di facce.

5)

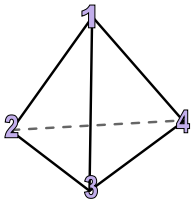

piramide triangolare

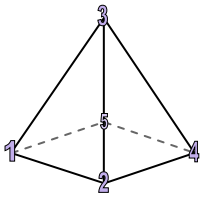

piramide rettangolare

Quale forma ha più vertici?
A.piramide triangolare
B.piramide rettangolare
C.Entrambi hanno lo stesso numero di vertici.

6)

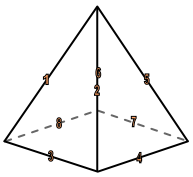

piramide rettangolare

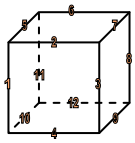

cube

Quale forma ha più spigoli?
A.piramide rettangolare
B.cube
C.Entrambi hanno lo stesso numero di spigoli.

Risposte

1. **6, 8, 12**
2. **5, 5, 8**
3. **1, 0, 0**
4. **A**
5. **B**
6. **B**

1-6	83	67	50	33	17	0