Funzioni (Addizioni e sottrazioni) Nome:

Determina quale regola viene usata nelle seguenti funzioni.

1) 36 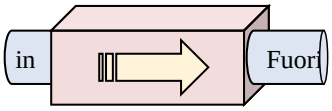

9

A. Aggiungi 30
B. Sottrai 32
C. Sottrai 31
D. Sottrai 27

2) 9 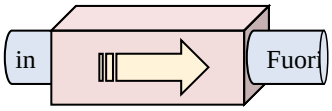

34

A. Aggiungi 23
B. Sottrai 29
C. Sottrai 21
D. Aggiungi 25

3) 12 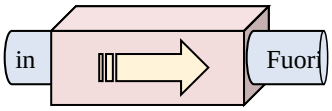

40

A. Sottrai 30
B. Aggiungi 33
C. Aggiungi 29
D. Aggiungi 28

4) 24 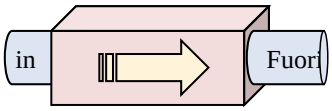

18

A. Aggiungi 4
B. Sottrai 2
C. Sottrai 6
D. Sottrai 5

5) 40 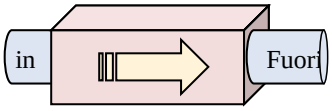

6

A. Aggiungi 29
B. Sottrai 39
C. Sottrai 34
D. Aggiungi 30

6) 33 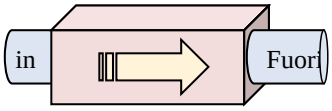

19

A. Aggiungi 16
B. Sottrai 17
C. Sottrai 14
D. Sottrai 9

7) 24 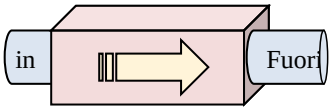

32

A. Aggiungi 11
B. Aggiungi 8
C. Sottrai 12
D. Aggiungi 12

8) 18 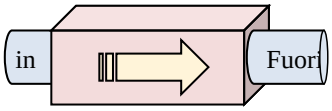

42

A. Aggiungi 24
B. Aggiungi 23
C. Sottrai 23
D. Aggiungi 21

9) 8 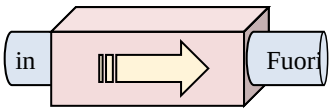

33

A. Aggiungi 25
B. Sottrai 24
C. Sottrai 26
D. Aggiungi 27

10) 39 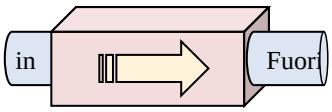

25

A. Aggiungi 9
B. Aggiungi 14
C. Sottrai 10
D. Sottrai 14

Risposte

1. _____
2. _____
3. _____
4. _____
5. _____
6. _____
7. _____
8. _____
9. _____
10. _____

1-10	90	80	70	60	50	40	30	20	10	0

Determina quale regola viene usata nelle seguenti funzioni.

1) 36 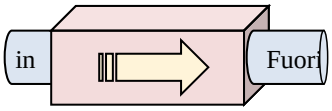

9

A. Aggiungi 30
B. Sottrai 32
C. Sottrai 31
D. Sottrai 27

2) 9 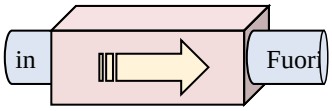

34

A. Aggiungi 23
B. Sottrai 29
C. Sottrai 21
D. Aggiungi 25

3) 12 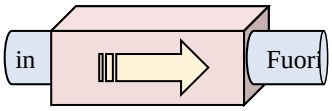

40

A. Sottrai 30
B. Aggiungi 33
C. Aggiungi 29
D. Aggiungi 28

4) 24 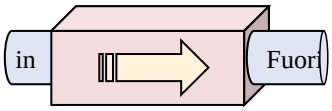

18

A. Aggiungi 4
B. Sottrai 2
C. Sottrai 6
D. Sottrai 5

5) 40 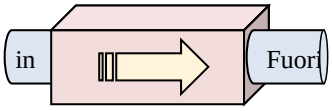

6

A. Aggiungi 29
B. Sottrai 39
C. Sottrai 34
D. Aggiungi 30

6) 33 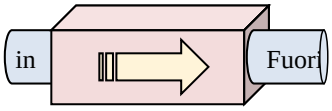

19

A. Aggiungi 16
B. Sottrai 17
C. Sottrai 14
D. Sottrai 9

7) 24 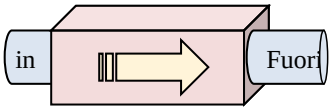

32

A. Aggiungi 11
B. Aggiungi 8
C. Sottrai 12
D. Aggiungi 12

8) 18 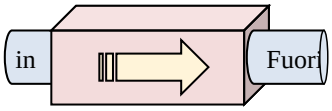

42

A. Aggiungi 24
B. Aggiungi 23
C. Sottrai 23
D. Aggiungi 21

9) 8 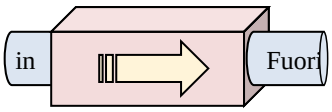

33

A. Aggiungi 25
B. Sottrai 24
C. Sottrai 26
D. Aggiungi 27

10) 39 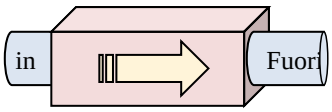

25

A. Aggiungi 9
B. Aggiungi 14
C. Sottrai 10
D. Sottrai 14

Risposte

1. D
2. D
3. D
4. C
5. C
6. C
7. B
8. A
9. A
10. D

1-10	90	80	70	60	50	40	30	20	10	0