Divisioni sulla linea numerata Nome:

Usa la linea numerata per risolvere ogni problema. Il primo è un esempio.

1) $2 : \frac{1}{3}$



2) $6 : \frac{1}{3}$

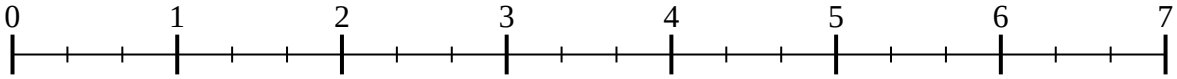

3) $5 : \frac{1}{4}$

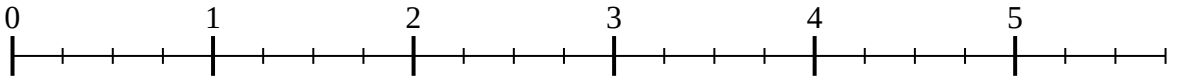

4) $7 : \frac{1}{5}$

5) $5 : \frac{1}{3}$

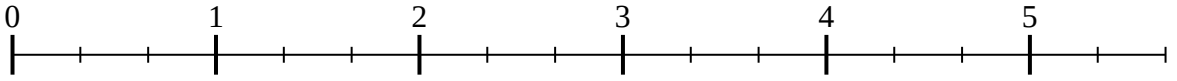

6) $6 : \frac{1}{4}$

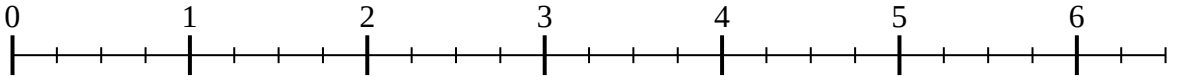

7) $7 : \frac{1}{6}$

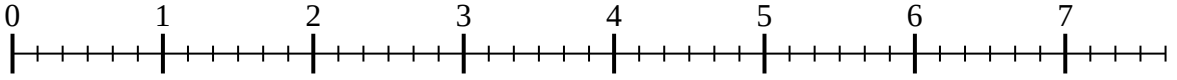

8) $3 : \frac{1}{4}$

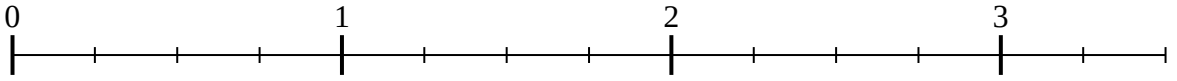

9) $6 : \frac{1}{6}$

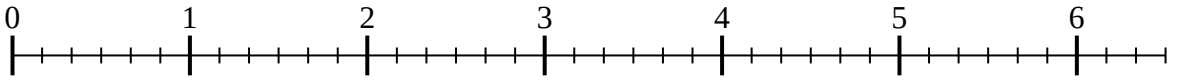

Risposte

1. _____
2. _____
3. _____
4. _____
5. _____
6. _____
7. _____
8. _____
9. _____

1-9	89	78	67	56	44	33	22	11	0

Divisioni sulla linea numerata Nome: **Soluzioni**

Usa la linea numerata per risolvere ogni problema. Il primo è un esempio.

1) $2:\frac{1}{3}$

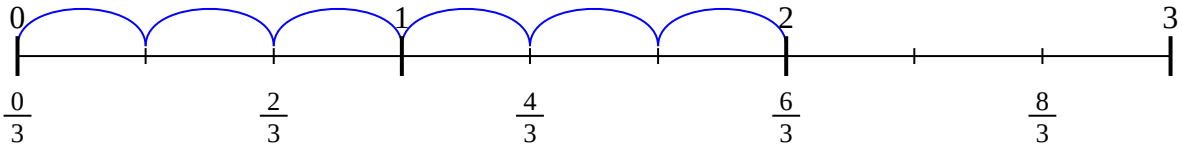

2) $6:\frac{1}{3}$

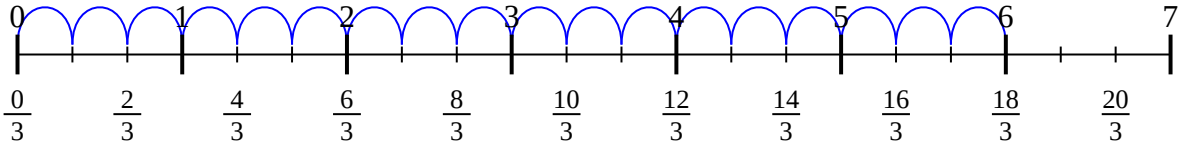

3) $5:\frac{1}{4}$

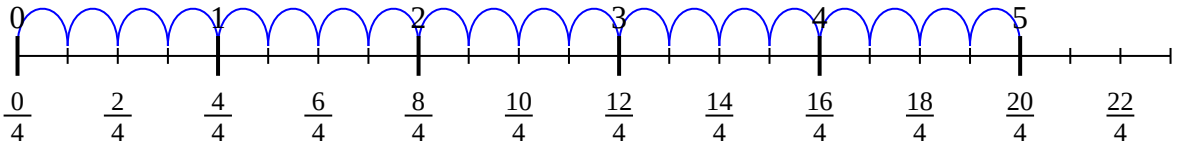

4) $7:\frac{1}{5}$

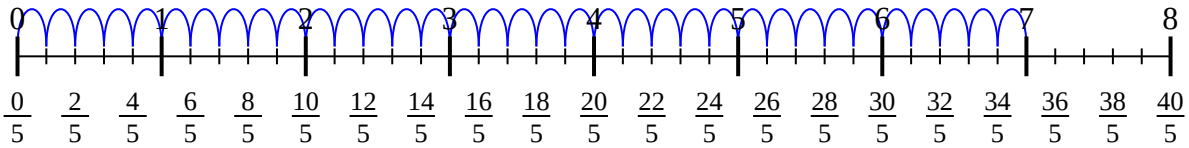

5) $5:\frac{1}{3}$

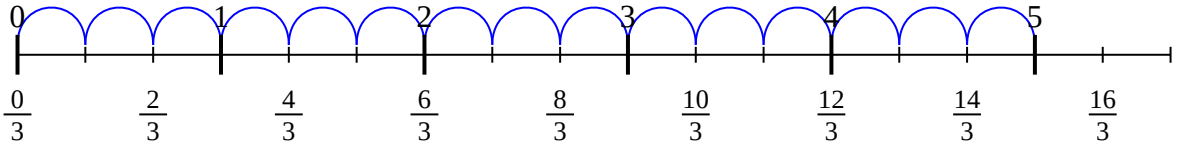

6) $6:\frac{1}{4}$

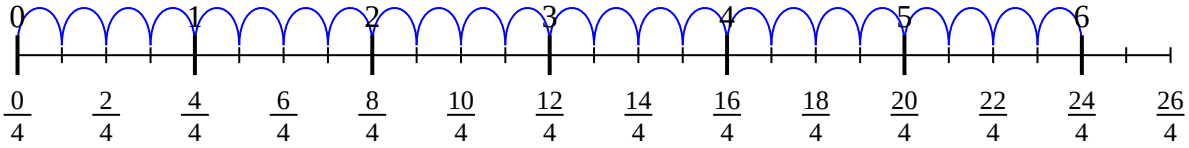

7) $7:\frac{1}{6}$

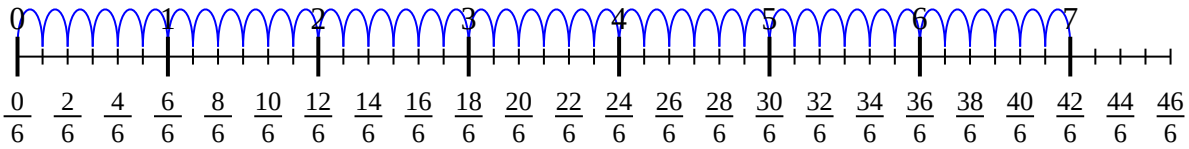

8) $3:\frac{1}{4}$

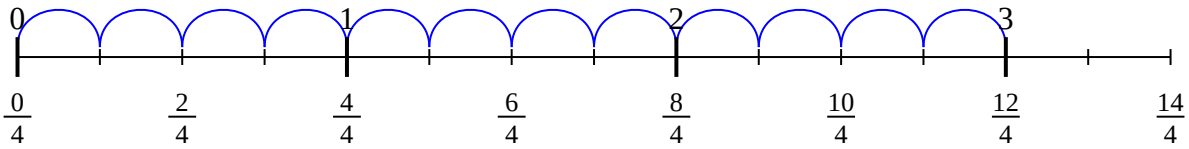

9) $6:\frac{1}{6}$

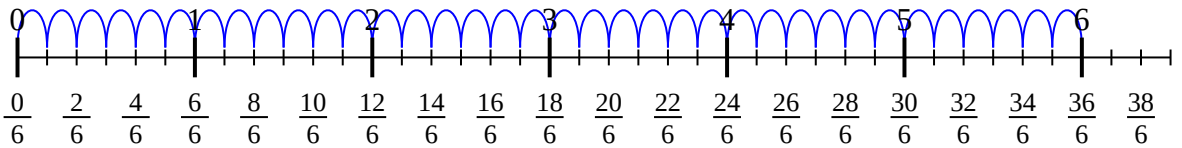

Risposte

1. $6/1$
2. $18/1$
3. $20/1$
4. $35/1$
5. $15/1$
6. $24/1$
7. $42/1$
8. $12/1$
9. $36/1$

1-9	89	78	67	56	44	33	22	11	0

Divisioni sulla linea numerata Nome:

Usa la linea numerata per risolvere ogni problema. Il primo è un esempio.

$^{6}/_{1}$	$^{36}/_{1}$	$^{42}/_{1}$	$^{12}/_{1}$
$^{20}/_{1}$	$^{35}/_{1}$	$^{18}/_{1}$	$^{15}/_{1}$
$^{24}/_{1}$			

1) $2:{}^{1}/_{3}$



2) $6:{}^{1}/_{3}$

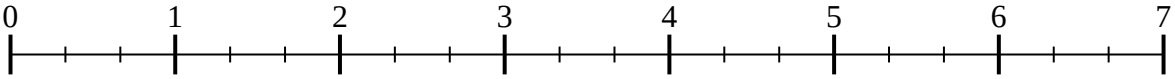

3) $5:{}^{1}/_{4}$

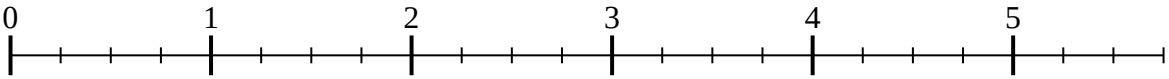

4) $7:{}^{1}/_{5}$

5) $5:{}^{1}/_{3}$

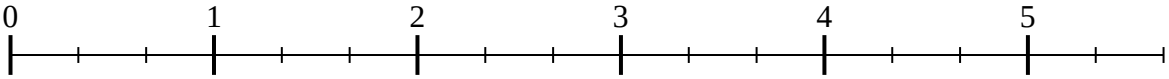

6) $6:{}^{1}/_{4}$

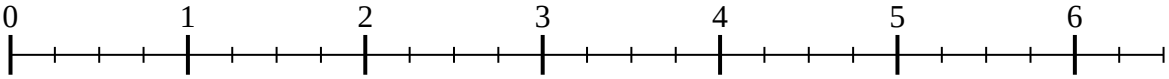

7) $7:{}^{1}/_{6}$

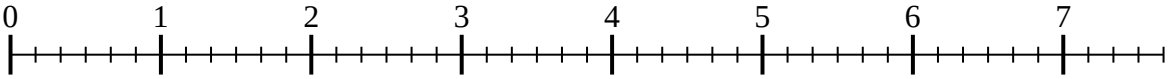

8) $3:{}^{1}/_{4}$

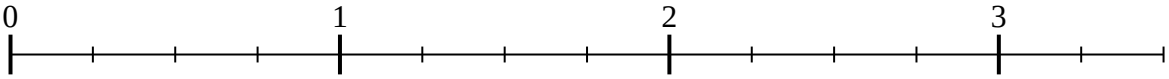

9) $6:{}^{1}/_{6}$

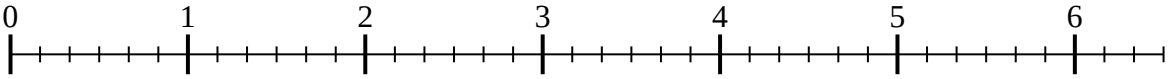

Risposte

1. _____
2. _____
3. _____
4. _____
5. _____
6. _____
7. _____
8. _____
9. _____

1-9	89	78	67	56	44	33	22	11	0