Moltiplicazione di frazioni e numeri interi Nome:

Usa i modelli visivi per risolvere.

1) $\frac{1}{2} \times 3 =$

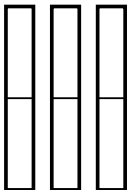

2) $\frac{3}{5} \times 3 =$

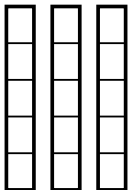

3) $\frac{5}{6} \times 7 =$

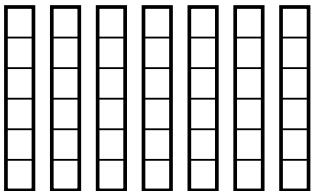

4) $\frac{2}{3} \times 7 =$

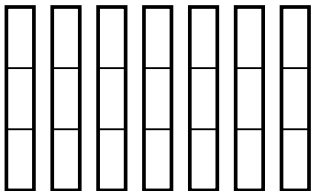

5) $\frac{2}{3} \times 8 =$

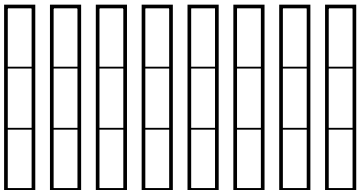

6) $\frac{7}{8} \times 4 =$

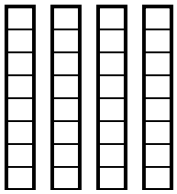

7) $\frac{1}{4} \times 8 =$

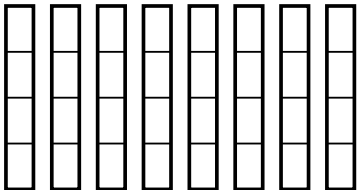

8) $\frac{3}{5} \times 7 =$

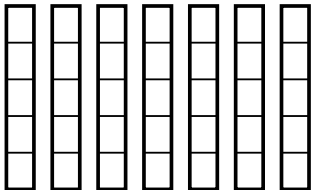

9) $\frac{2}{3} \times 5 =$

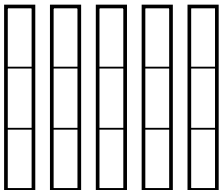

10) $\frac{2}{3} \times 4 =$

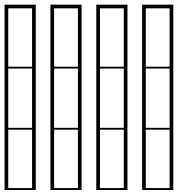

11) $\frac{2}{6} \times 7 =$

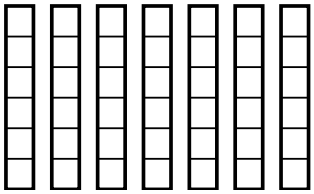

12) $\frac{6}{8} \times 4 =$

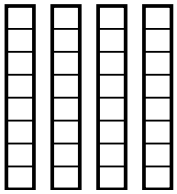

Risposte

1. _____
2. _____
3. _____
4. _____
5. _____
6. _____
7. _____
8. _____
9. _____
10. _____
11. _____
12. _____

1-10	92	83	75	67	58	50	42	33	25	17
11-12	8	0								

Moltiplicazione di frazioni e numeri interi Nome: **Soluzioni**

Usa i modelli visivi per risolvere.

1) $\frac{1}{2} \times 3 =$

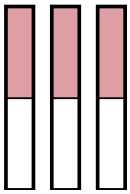

2) $\frac{3}{5} \times 3 =$

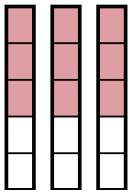

3) $\frac{5}{6} \times 7 =$

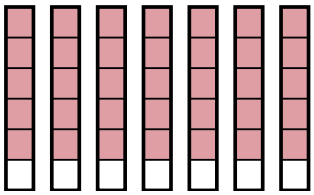

4) $\frac{2}{3} \times 7 =$

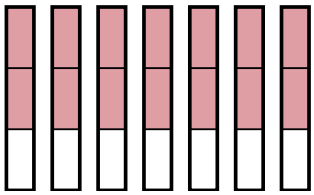

5) $\frac{2}{3} \times 8 =$

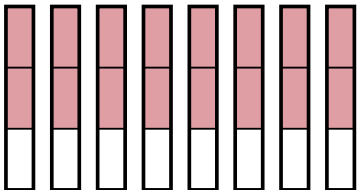

6) $\frac{7}{8} \times 4 =$

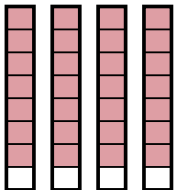

7) $\frac{1}{4} \times 8 =$

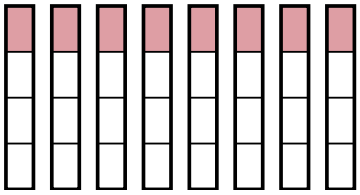

8) $\frac{3}{5} \times 7 =$

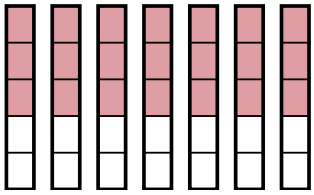

9) $\frac{2}{3} \times 5 =$

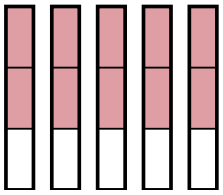

10) $\frac{2}{3} \times 4 =$

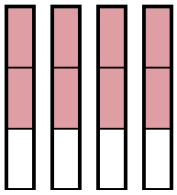

11) $\frac{2}{6} \times 7 =$

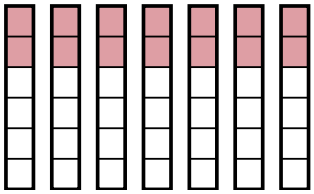

12) $\frac{6}{8} \times 4 =$

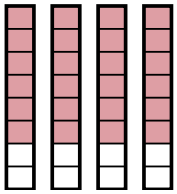

Risposte

1. $\frac{3}{2}$
2. $\frac{9}{5}$
3. $\frac{35}{6}$
4. $\frac{14}{3}$
5. $\frac{16}{3}$
6. $\frac{28}{8}$
7. $\frac{8}{4}$
8. $\frac{21}{5}$
9. $\frac{10}{3}$
10. $\frac{8}{3}$
11. $\frac{14}{6}$
12. $\frac{24}{8}$

1-10	92	83	75	67	58	50	42	33	25	17
11-12	8	0								

Moltiplicazione di frazioni e numeri interi Nome:

Usa i modelli visivi per risolvere.

1) $\frac{4}{6} \times 7 =$

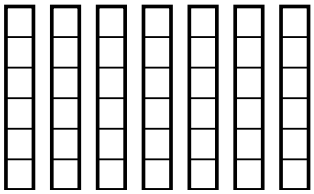

2) $\frac{1}{4} \times 3 =$

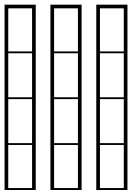

3) $\frac{4}{6} \times 6 =$

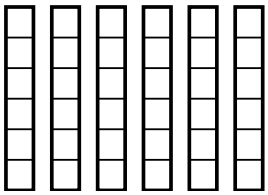

4) $\frac{1}{5} \times 8 =$

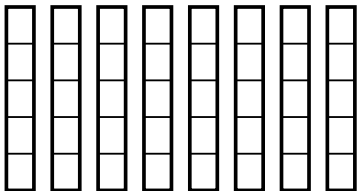

5) $\frac{4}{5} \times 8 =$

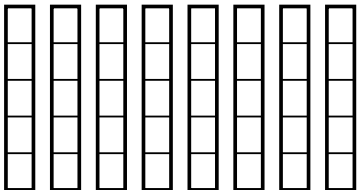

6) $\frac{1}{2} \times 4 =$

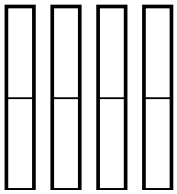

7) $\frac{1}{8} \times 7 =$

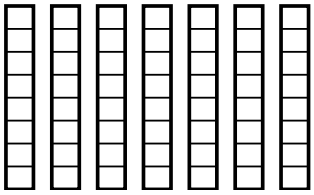

8) $\frac{1}{2} \times 3 =$

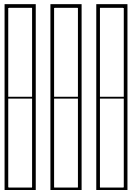

9) $\frac{1}{3} \times 2 =$

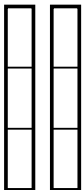

10) $\frac{2}{3} \times 4 =$

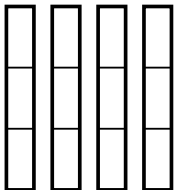

11) $\frac{3}{10} \times 7 =$

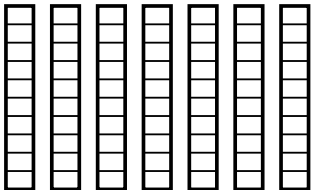

12) $\frac{2}{4} \times 7 =$

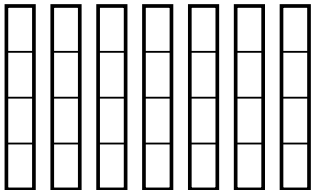

Risposte

1. _____
2. _____
3. _____
4. _____
5. _____
6. _____
7. _____
8. _____
9. _____
10. _____
11. _____
12. _____

1-10	92	83	75	67	58	50	42	33	25	17
11-12	8	0								

Moltiplicazione di frazioni e numeri interi Nome: **Soluzioni**

Usa i modelli visivi per risolvere.

1) $\frac{4}{6} \times 7 =$

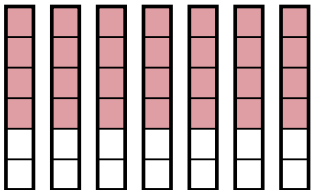

2) $\frac{1}{4} \times 3 =$

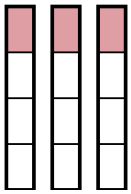

3) $\frac{4}{6} \times 6 =$

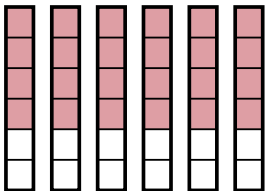

4) $\frac{1}{5} \times 8 =$

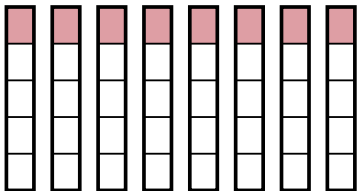

5) $\frac{4}{5} \times 8 =$

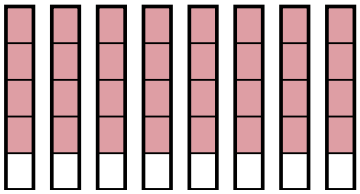

6) $\frac{1}{2} \times 4 =$

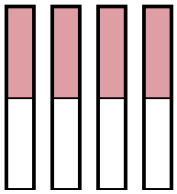

7) $\frac{1}{8} \times 7 =$

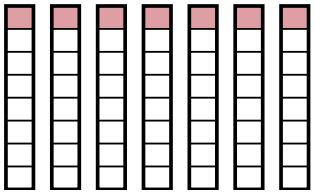

8) $\frac{1}{2} \times 3 =$

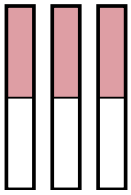

9) $\frac{1}{3} \times 2 =$

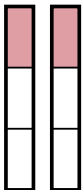

10) $\frac{2}{3} \times 4 =$

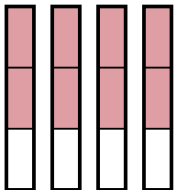

11) $\frac{3}{10} \times 7 =$

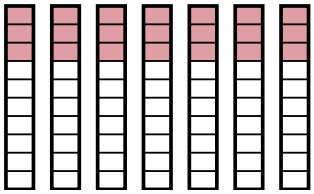

12) $\frac{2}{4} \times 7 =$

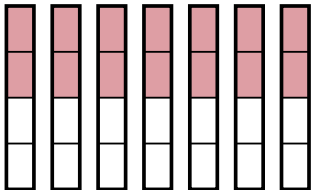

Risposte

1. $\frac{28}{6}$
2. $\frac{3}{4}$
3. $\frac{24}{6}$
4. $\frac{8}{5}$
5. $\frac{32}{5}$
6. $\frac{4}{2}$
7. $\frac{7}{8}$
8. $\frac{3}{2}$
9. $\frac{2}{3}$
10. $\frac{8}{3}$
11. $\frac{21}{10}$
12. $\frac{14}{4}$

1-10	92	83	75	67	58	50	42	33	25	17
11-12	8	0								

Moltiplicazione di frazioni e numeri interi Nome:

Usa i modelli visivi per risolvere.

1) $\frac{5}{6} \times 3 =$

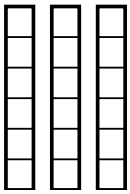

2) $\frac{5}{6} \times 4 =$

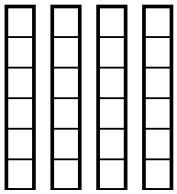

3) $\frac{1}{2} \times 2 =$

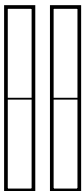

4) $\frac{4}{6} \times 4 =$

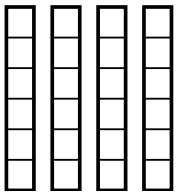

5) $\frac{7}{10} \times 9 =$

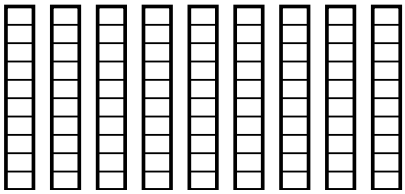

6) $\frac{2}{4} \times 6 =$

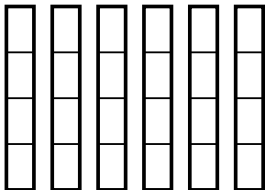

7) $\frac{2}{5} \times 3 =$

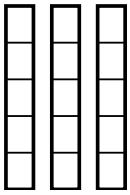

8) $\frac{3}{4} \times 6 =$

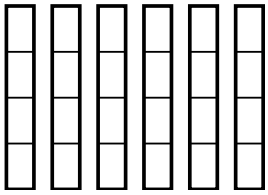

9) $\frac{1}{2} \times 4 =$

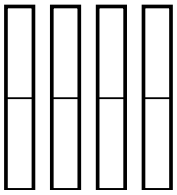

10) $\frac{2}{3} \times 2 =$

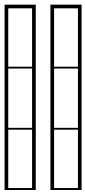

11) $\frac{8}{10} \times 7 =$

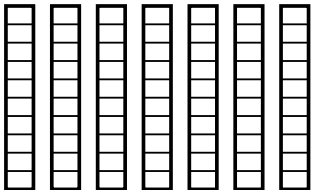

12) $\frac{3}{6} \times 4 =$

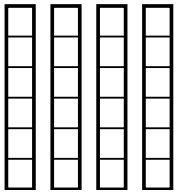

Risposte

1. _____
2. _____
3. _____
4. _____
5. _____
6. _____
7. _____
8. _____
9. _____
10. _____
11. _____
12. _____

1-10	92	83	75	67	58	50	42	33	25	17
11-12	8	0								

Moltiplicazione di frazioni e numeri interi Nome: **Soluzioni**

Usa i modelli visivi per risolvere.

1) $\frac{5}{6} \times 3 =$

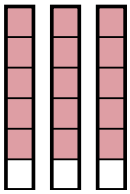

2) $\frac{5}{6} \times 4 =$

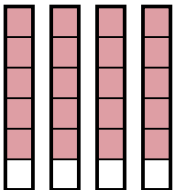

3) $\frac{1}{2} \times 2 =$

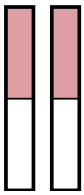

4) $\frac{4}{6} \times 4 =$

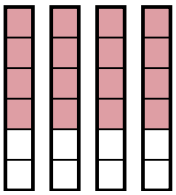

5) $\frac{7}{10} \times 9 =$

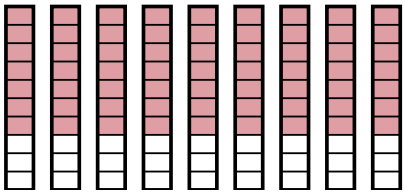

6) $\frac{2}{4} \times 6 =$

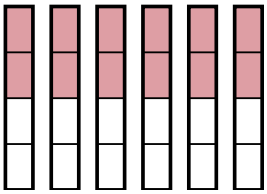

7) $\frac{2}{5} \times 3 =$

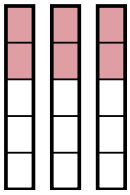

8) $\frac{3}{4} \times 6 =$

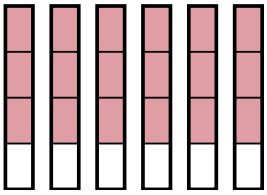

9) $\frac{1}{2} \times 4 =$

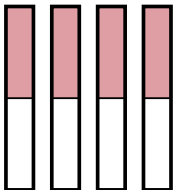

10) $\frac{2}{3} \times 2 =$

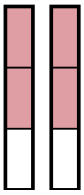

11) $\frac{8}{10} \times 7 =$

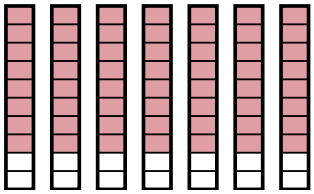

12) $\frac{3}{6} \times 4 =$

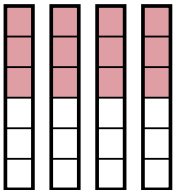

Risposte

1. $\frac{15}{6}$
2. $\frac{20}{6}$
3. $\frac{2}{2}$
4. $\frac{16}{6}$
5. $\frac{63}{10}$
6. $\frac{12}{4}$
7. $\frac{6}{5}$
8. $\frac{18}{4}$
9. $\frac{4}{2}$
10. $\frac{4}{3}$
11. $\frac{56}{10}$
12. $\frac{12}{6}$

1-10	92	83	75	67	58	50	42	33	25	17
11-12	8	0								

Moltiplicazione di frazioni e numeri interi Nome:

Usa i modelli visivi per risolvere.

1) $\frac{5}{6} \times 3 =$

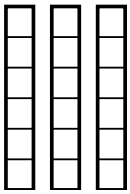

2) $\frac{1}{3} \times 6 =$

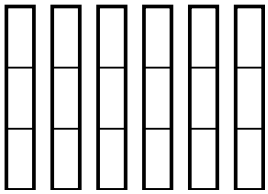

3) $\frac{2}{3} \times 8 =$

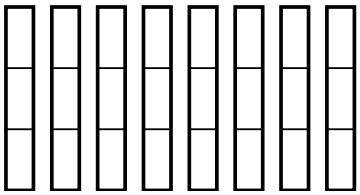

4) $\frac{1}{2} \times 4 =$

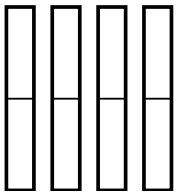

5) $\frac{4}{8} \times 8 =$

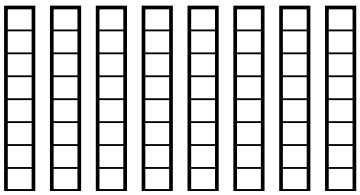

6) $\frac{5}{6} \times 2 =$

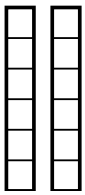

7) $\frac{1}{2} \times 2 =$

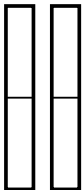

8) $\frac{2}{3} \times 9 =$

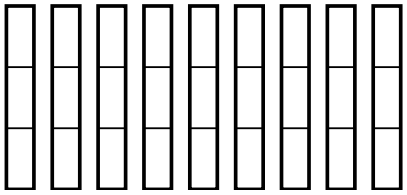

9) $\frac{1}{4} \times 9 =$

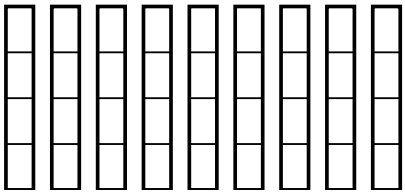

10) $\frac{4}{5} \times 6 =$

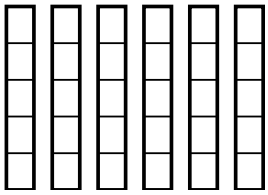

11) $\frac{1}{2} \times 3 =$

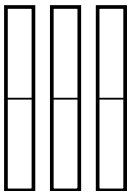

12) $\frac{3}{10} \times 8 =$

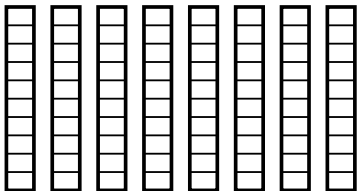

Risposte

1. _____
2. _____
3. _____
4. _____
5. _____
6. _____
7. _____
8. _____
9. _____
10. _____
11. _____
12. _____

1-10	92	83	75	67	58	50	42	33	25	17
11-12	8	0								

Moltiplicazione di frazioni e numeri interi Nome: **Soluzioni**

Usa i modelli visivi per risolvere.

1) $\frac{5}{6} \times 3 =$

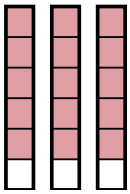

2) $\frac{1}{3} \times 6 =$



3) $\frac{2}{3} \times 8 =$

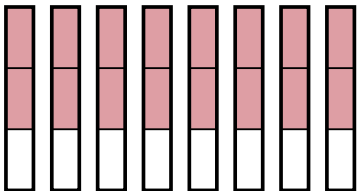

4) $\frac{1}{2} \times 4 =$

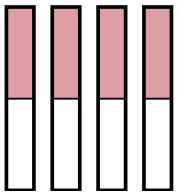

5) $\frac{4}{8} \times 8 =$

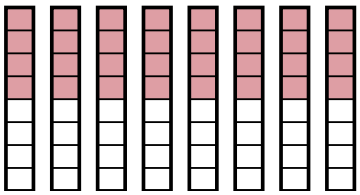

6) $\frac{5}{6} \times 2 =$

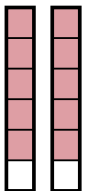

7) $\frac{1}{2} \times 2 =$

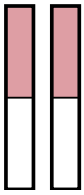

8) $\frac{2}{3} \times 9 =$

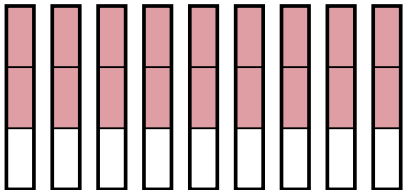

9) $\frac{1}{4} \times 9 =$

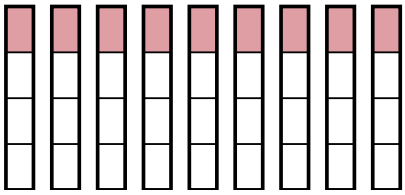

10) $\frac{4}{5} \times 6 =$

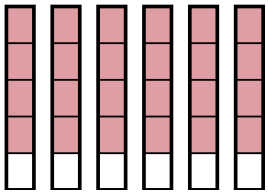

11) $\frac{1}{2} \times 3 =$

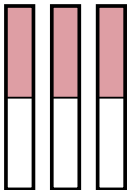

12) $\frac{3}{10} \times 8 =$

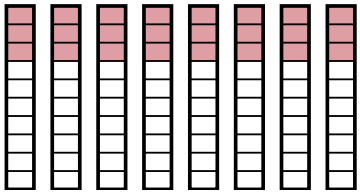

Risposte

1. $\frac{15}{6}$
2. $\frac{6}{3}$
3. $\frac{16}{3}$
4. $\frac{4}{2}$
5. $\frac{32}{8}$
6. $\frac{10}{6}$
7. $\frac{2}{2}$
8. $\frac{18}{3}$
9. $\frac{9}{4}$
10. $\frac{24}{5}$
11. $\frac{3}{2}$
12. $\frac{24}{10}$

1-10	92	83	75	67	58	50	42	33	25	17
11-12	8	0								

Moltiplicazione di frazioni e numeri interi Nome:

Usa i modelli visivi per risolvere.

1) $\frac{2}{6} \times 5 =$

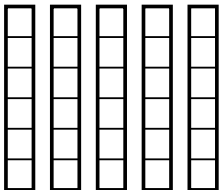

2) $\frac{3}{5} \times 7 =$

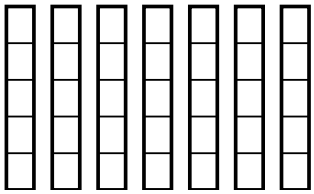

3) $\frac{1}{4} \times 6 =$

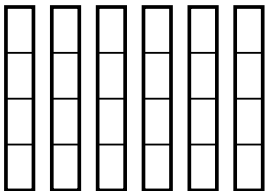

4) $\frac{3}{5} \times 3 =$

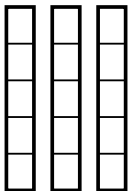

5) $\frac{2}{5} \times 2 =$

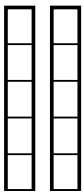

6) $\frac{3}{10} \times 5 =$

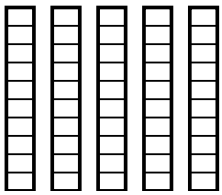

7) $\frac{2}{8} \times 9 =$

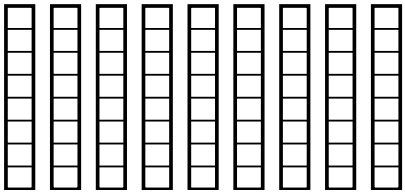

8) $\frac{3}{4} \times 9 =$

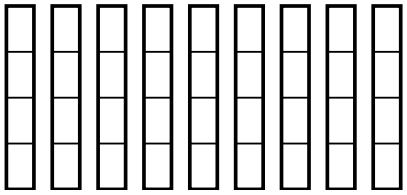

9) $\frac{2}{3} \times 2 =$

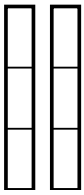

10) $\frac{1}{4} \times 2 =$

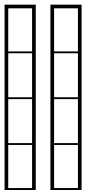

11) $\frac{1}{4} \times 8 =$

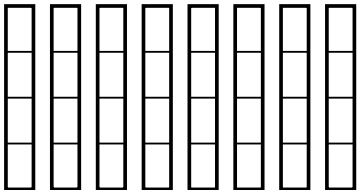

12) $\frac{6}{8} \times 9 =$

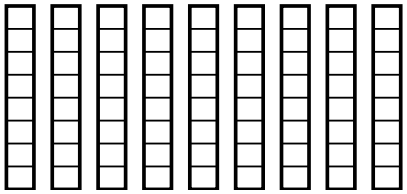

Risposte

1. _____
2. _____
3. _____
4. _____
5. _____
6. _____
7. _____
8. _____
9. _____
10. _____
11. _____
12. _____

1-10	92	83	75	67	58	50	42	33	25	17
11-12	8	0								

Moltiplicazione di frazioni e numeri interi Nome: **Soluzioni**

Usa i modelli visivi per risolvere.

1) $\frac{2}{6} \times 5 =$

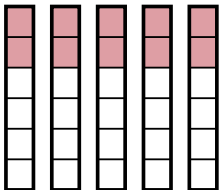

2) $\frac{3}{5} \times 7 =$

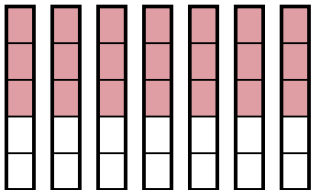

3) $\frac{1}{4} \times 6 =$

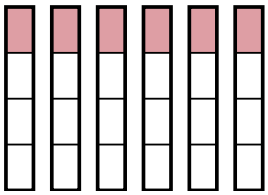

4) $\frac{3}{5} \times 3 =$

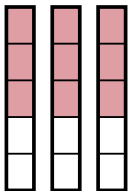

5) $\frac{2}{5} \times 2 =$

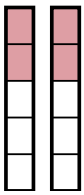

6) $\frac{3}{10} \times 5 =$

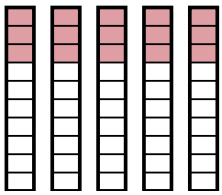

7) $\frac{2}{8} \times 9 =$

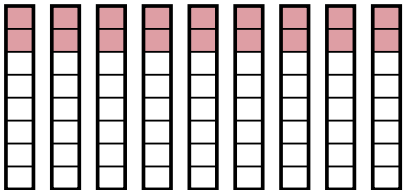

8) $\frac{3}{4} \times 9 =$

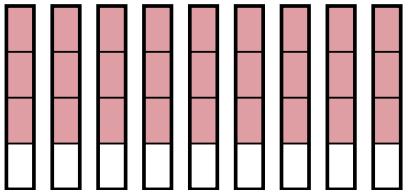

9) $\frac{2}{3} \times 2 =$

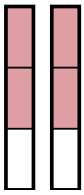

10) $\frac{1}{4} \times 2 =$

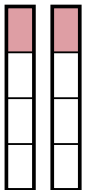

11) $\frac{1}{4} \times 8 =$

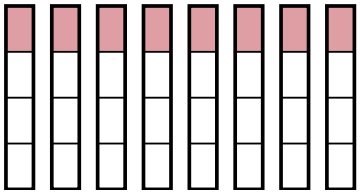

12) $\frac{6}{8} \times 9 =$

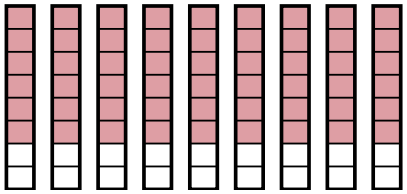

Risposte

1. $\frac{10}{6}$
2. $\frac{21}{5}$
3. $\frac{6}{4}$
4. $\frac{9}{5}$
5. $\frac{4}{5}$
6. $\frac{15}{10}$
7. $\frac{18}{8}$
8. $\frac{27}{4}$
9. $\frac{4}{3}$
10. $\frac{2}{4}$
11. $\frac{8}{4}$
12. $\frac{54}{8}$

1-10	92	83	75	67	58	50	42	33	25	17
11-12	8	0								

Moltiplicazione di frazioni e numeri interi Nome:

Usa i modelli visivi per risolvere.

1) $\frac{7}{10} \times 2 =$

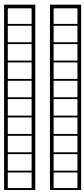

2) $\frac{2}{3} \times 9 =$

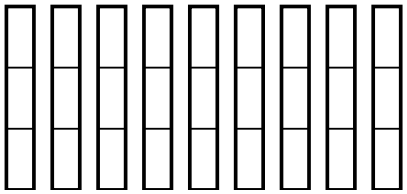

3) $\frac{2}{4} \times 3 =$

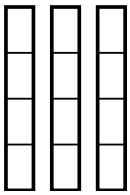

4) $\frac{7}{10} \times 7 =$

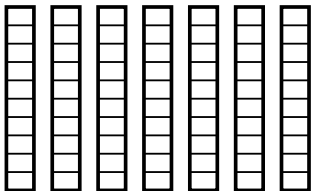

5) $\frac{1}{2} \times 2 =$

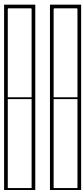

6) $\frac{2}{6} \times 8 =$

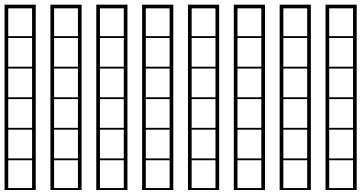

7) $\frac{3}{6} \times 9 =$

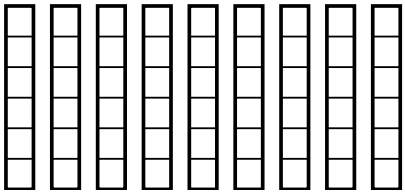

8) $\frac{1}{2} \times 4 =$

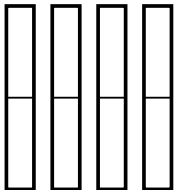

9) $\frac{1}{5} \times 7 =$

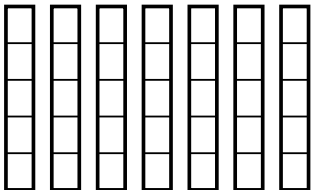

10) $\frac{3}{6} \times 5 =$

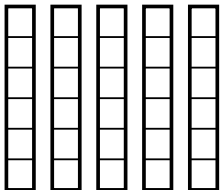

11) $\frac{2}{3} \times 8 =$

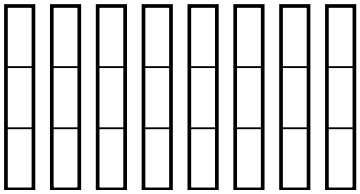

12) $\frac{6}{8} \times 7 =$

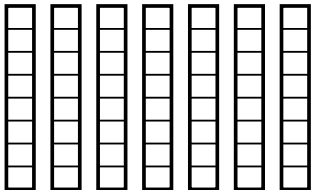

Risposte

1. _____
2. _____
3. _____
4. _____
5. _____
6. _____
7. _____
8. _____
9. _____
10. _____
11. _____
12. _____

1-10	92	83	75	67	58	50	42	33	25	17
11-12	8	0								

Moltiplicazione di frazioni e numeri interi Nome: **Soluzioni**

Usa i modelli visivi per risolvere.

1) $\frac{7}{10} \times 2 =$

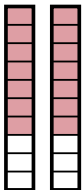

2) $\frac{2}{3} \times 9 =$

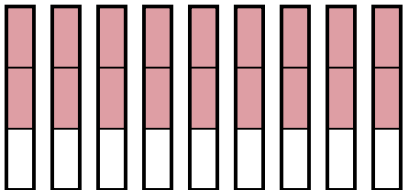

3) $\frac{2}{4} \times 3 =$

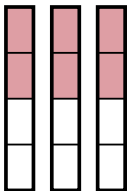

4) $\frac{7}{10} \times 7 =$

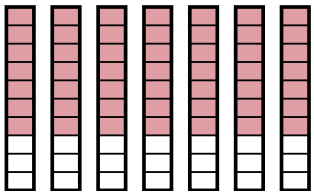

5) $\frac{1}{2} \times 2 =$

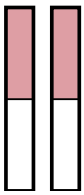

6) $\frac{2}{6} \times 8 =$

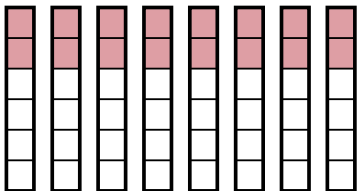

7) $\frac{3}{6} \times 9 =$

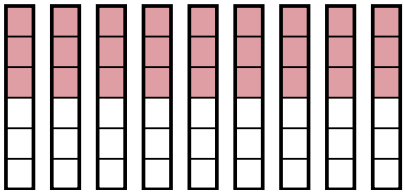

8) $\frac{1}{2} \times 4 =$

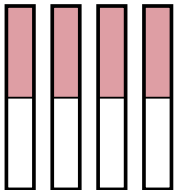

9) $\frac{1}{5} \times 7 =$

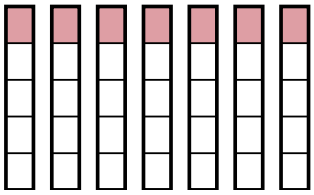

10) $\frac{3}{6} \times 5 =$

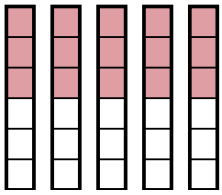

11) $\frac{2}{3} \times 8 =$

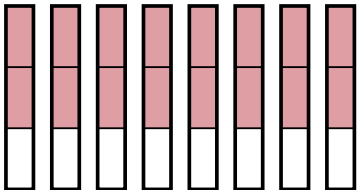

12) $\frac{6}{8} \times 7 =$

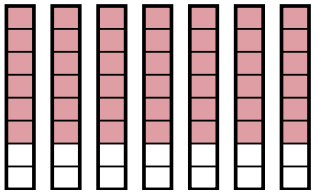

Risposte

1. $\frac{14}{10}$
2. $\frac{18}{3}$
3. $\frac{6}{4}$
4. $\frac{49}{10}$
5. $\frac{2}{2}$
6. $\frac{16}{6}$
7. $\frac{27}{6}$
8. $\frac{4}{2}$
9. $\frac{7}{5}$
10. $\frac{15}{6}$
11. $\frac{16}{3}$
12. $\frac{42}{8}$

1-10	92	83	75	67	58	50	42	33	25	17
11-12	8	0								

Moltiplicazione di frazioni e numeri interi Nome:

Usa i modelli visivi per risolvere.

1) $\frac{7}{8} \times 8 =$

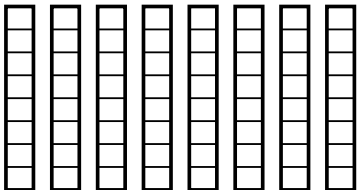

2) $\frac{1}{4} \times 6 =$

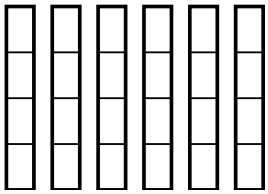

3) $\frac{1}{2} \times 5 =$

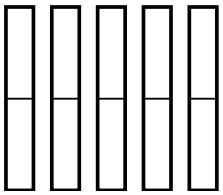

4) $\frac{3}{10} \times 5 =$

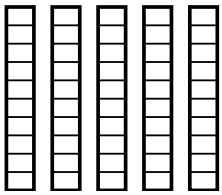

5) $\frac{1}{2} \times 3 =$

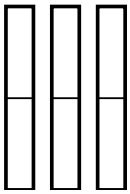

6) $\frac{3}{4} \times 4 =$

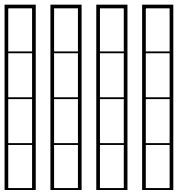

7) $\frac{1}{5} \times 2 =$

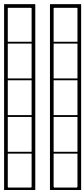

8) $\frac{2}{8} \times 6 =$

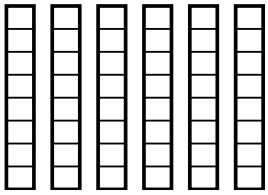

9) $\frac{2}{3} \times 7 =$

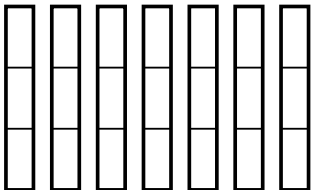

10) $\frac{1}{3} \times 8 =$

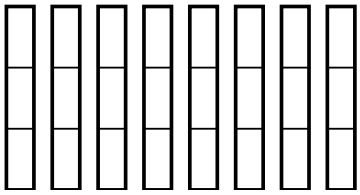

11) $\frac{2}{5} \times 2 =$

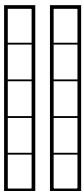

12) $\frac{5}{6} \times 5 =$

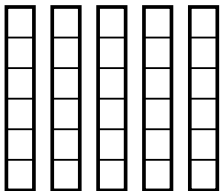

Risposte

1. _____
2. _____
3. _____
4. _____
5. _____
6. _____
7. _____
8. _____
9. _____
10. _____
11. _____
12. _____

1-10	92	83	75	67	58	50	42	33	25	17
11-12	8	0								

Moltiplicazione di frazioni e numeri interi Nome: **Soluzioni**

Usa i modelli visivi per risolvere.

1) $\frac{7}{8} \times 8 =$

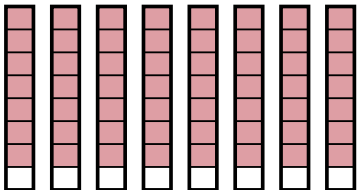

2) $\frac{1}{4} \times 6 =$

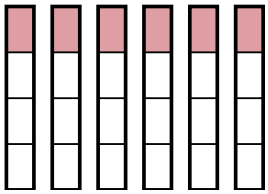

3) $\frac{1}{2} \times 5 =$

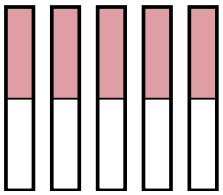

4) $\frac{3}{10} \times 5 =$

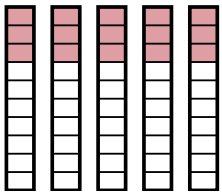

5) $\frac{1}{2} \times 3 =$

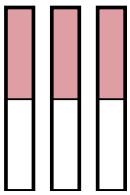

6) $\frac{3}{4} \times 4 =$

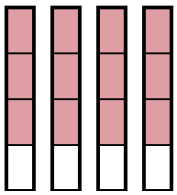

7) $\frac{1}{5} \times 2 =$

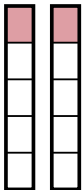

8) $\frac{2}{8} \times 6 =$

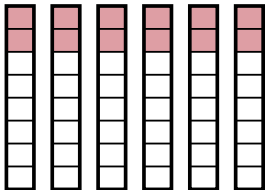

9) $\frac{2}{3} \times 7 =$

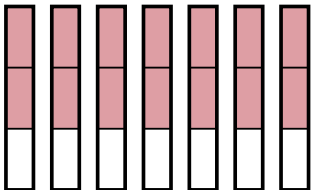

10) $\frac{1}{3} \times 8 =$



11) $\frac{2}{5} \times 2 =$

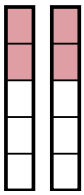

12) $\frac{5}{6} \times 5 =$

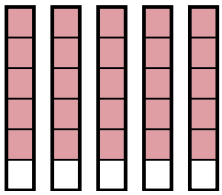

Risposte

1. $\frac{56}{8}$
2. $\frac{6}{4}$
3. $\frac{5}{2}$
4. $\frac{15}{10}$
5. $\frac{3}{2}$
6. $\frac{12}{4}$
7. $\frac{2}{5}$
8. $\frac{12}{8}$
9. $\frac{14}{3}$
10. $\frac{8}{3}$
11. $\frac{4}{5}$
12. $\frac{25}{6}$

1-10	92	83	75	67	58	50	42	33	25	17
11-12	8	0								

Moltiplicazione di frazioni e numeri interi Nome:

Usa i modelli visivi per risolvere.

1) $\frac{1}{8} \times 5 =$

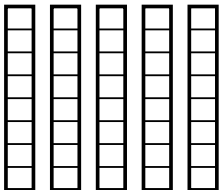

2) $\frac{1}{2} \times 4 =$

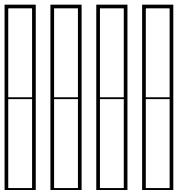

3) $\frac{1}{10} \times 2 =$

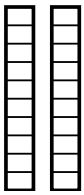

4) $\frac{3}{4} \times 4 =$

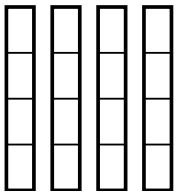

5) $\frac{1}{6} \times 9 =$

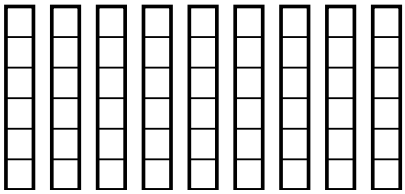

6) $\frac{1}{4} \times 9 =$

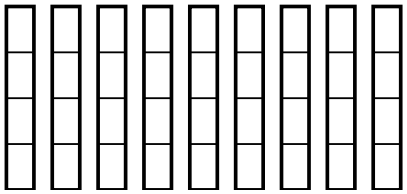

7) $\frac{1}{2} \times 6 =$

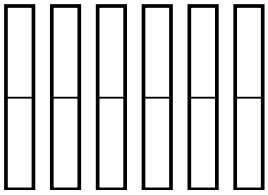

8) $\frac{1}{2} \times 2 =$

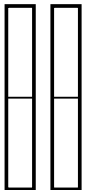

9) $\frac{2}{3} \times 9 =$

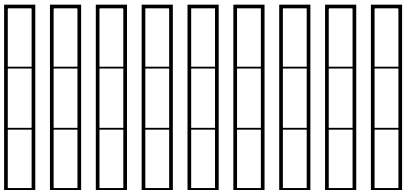

10) $\frac{3}{4} \times 5 =$

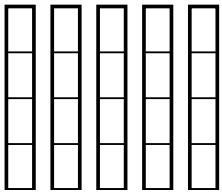

11) $\frac{1}{6} \times 6 =$

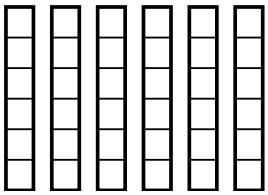

12) $\frac{2}{8} \times 9 =$

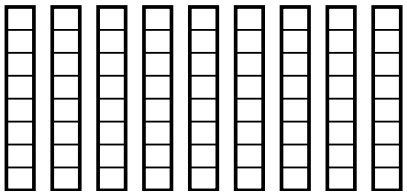

Risposte

1. _____
2. _____
3. _____
4. _____
5. _____
6. _____
7. _____
8. _____
9. _____
10. _____
11. _____
12. _____

1-10	92	83	75	67	58	50	42	33	25	17
11-12	8	0								

Moltiplicazione di frazioni e numeri interi Nome: **Soluzioni**

Usa i modelli visivi per risolvere.

1) $\frac{1}{8} \times 5 =$

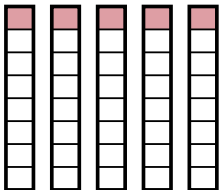

2) $\frac{1}{2} \times 4 =$

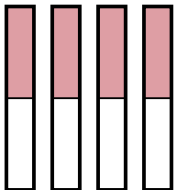

3) $\frac{1}{10} \times 2 =$

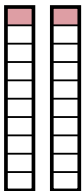

4) $\frac{3}{4} \times 4 =$

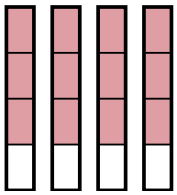

5) $\frac{1}{6} \times 9 =$

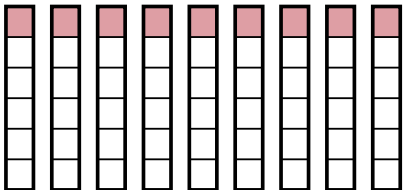

6) $\frac{1}{4} \times 9 =$

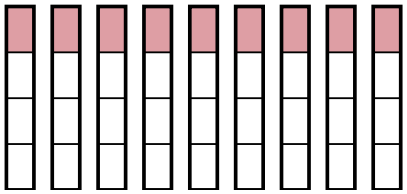

7) $\frac{1}{2} \times 6 =$

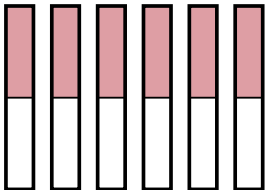

8) $\frac{1}{2} \times 2 =$

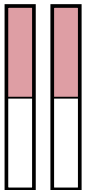

9) $\frac{2}{3} \times 9 =$

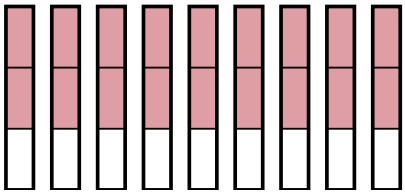

10) $\frac{3}{4} \times 5 =$

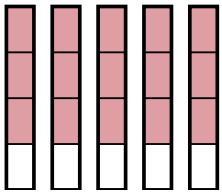

11) $\frac{1}{6} \times 6 =$

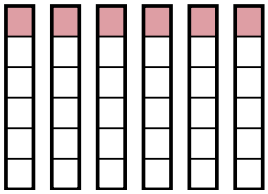

12) $\frac{2}{8} \times 9 =$

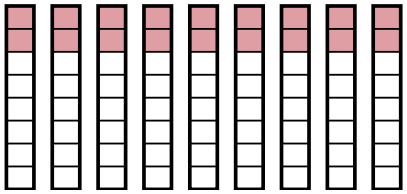

Risposte

1. $\frac{5}{8}$
2. $\frac{4}{2}$
3. $\frac{2}{10}$
4. $\frac{12}{4}$
5. $\frac{9}{6}$
6. $\frac{9}{4}$
7. $\frac{6}{2}$
8. $\frac{2}{2}$
9. $\frac{18}{3}$
10. $\frac{15}{4}$
11. $\frac{6}{6}$
12. $\frac{18}{8}$

1-10	92	83	75	67	58	50	42	33	25	17
11-12	8	0								

Moltiplicazione di frazioni e numeri interi Nome:

Usa i modelli visivi per risolvere.

1) $\frac{1}{3} \times 7 =$

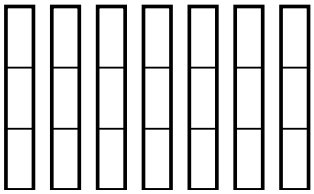

2) $\frac{5}{6} \times 6 =$

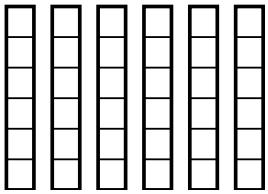

3) $\frac{9}{10} \times 4 =$

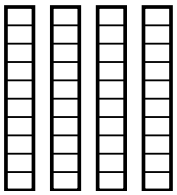

4) $\frac{7}{10} \times 9 =$

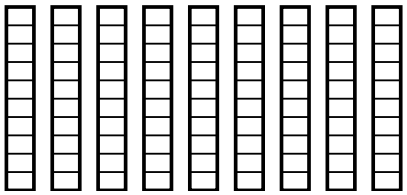

5) $\frac{2}{4} \times 6 =$

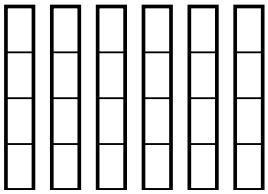

6) $\frac{3}{5} \times 3 =$

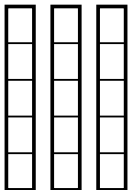

7) $\frac{2}{4} \times 5 =$

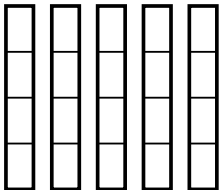

8) $\frac{3}{6} \times 7 =$

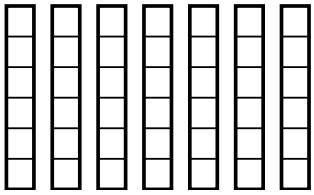

9) $\frac{1}{3} \times 5 =$

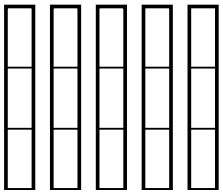

10) $\frac{1}{4} \times 2 =$

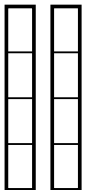

11) $\frac{3}{4} \times 5 =$

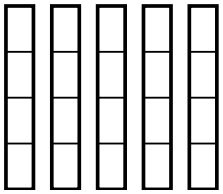

12) $\frac{1}{8} \times 8 =$

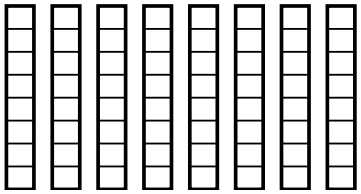

Risposte

1. _____
2. _____
3. _____
4. _____
5. _____
6. _____
7. _____
8. _____
9. _____
10. _____
11. _____
12. _____

1-10	92	83	75	67	58	50	42	33	25	17
11-12	8	0								

Moltiplicazione di frazioni e numeri interi Nome: **Soluzioni**

Usa i modelli visivi per risolvere.

1) $\frac{1}{3} \times 7 =$

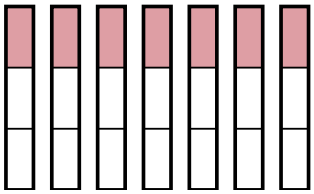

2) $\frac{5}{6} \times 6 =$

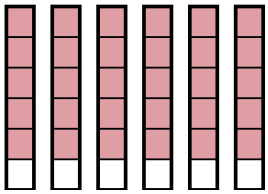

3) $\frac{9}{10} \times 4 =$

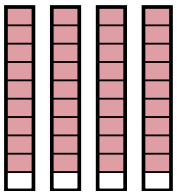

4) $\frac{7}{10} \times 9 =$

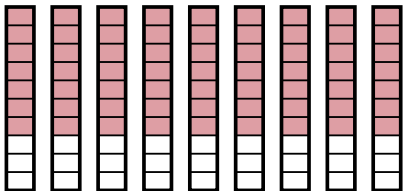

5) $\frac{2}{4} \times 6 =$

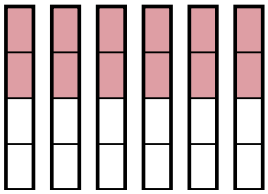

6) $\frac{3}{5} \times 3 =$

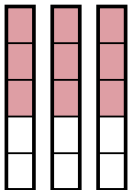

7) $\frac{2}{4} \times 5 =$

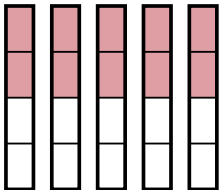

8) $\frac{3}{6} \times 7 =$

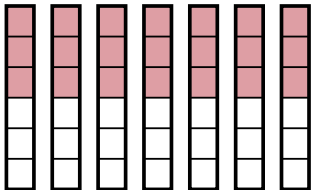

9) $\frac{1}{3} \times 5 =$

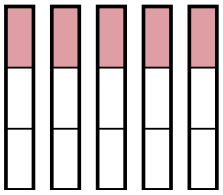

10) $\frac{1}{4} \times 2 =$

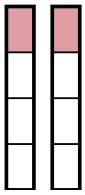

11) $\frac{3}{4} \times 5 =$

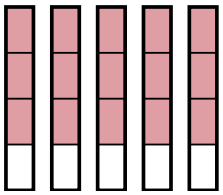

12) $\frac{1}{8} \times 8 =$

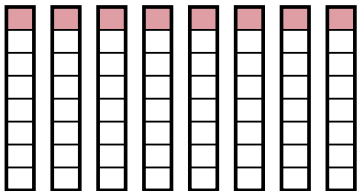

Risposte

1. $\frac{7}{3}$
2. $\frac{30}{6}$
3. $\frac{36}{10}$
4. $\frac{63}{10}$
5. $\frac{12}{4}$
6. $\frac{9}{5}$
7. $\frac{10}{4}$
8. $\frac{21}{6}$
9. $\frac{5}{3}$
10. $\frac{2}{4}$
11. $\frac{15}{4}$
12. $\frac{8}{8}$

1-10	92	83	75	67	58	50	42	33	25	17
11-12	8	0								

Moltiplicazione di frazioni e numeri interi Nome:

Usa i modelli visivi per risolvere.

1) $\frac{1}{2} \times 6 =$

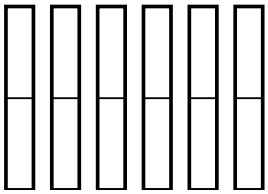

2) $\frac{2}{4} \times 7 =$

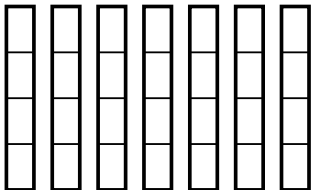

3) $\frac{2}{4} \times 4 =$

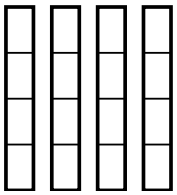

4) $\frac{1}{5} \times 8 =$

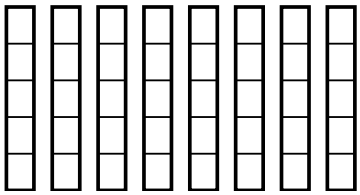

5) $\frac{5}{10} \times 4 =$

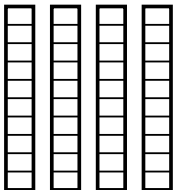

6) $\frac{1}{4} \times 6 =$

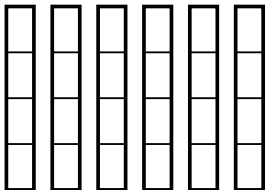

7) $\frac{1}{4} \times 5 =$

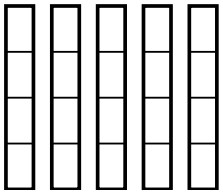

8) $\frac{2}{3} \times 9 =$

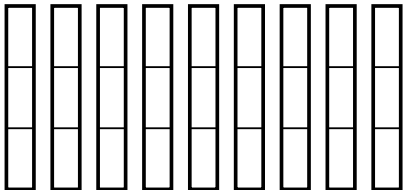

9) $\frac{1}{8} \times 8 =$

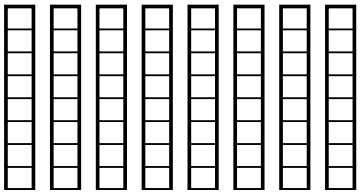

10) $\frac{4}{10} \times 6 =$

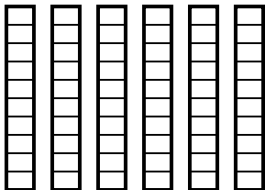

11) $\frac{4}{5} \times 2 =$

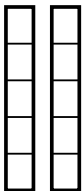

12) $\frac{1}{4} \times 3 =$

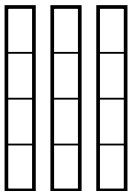

Risposte

1. _____
2. _____
3. _____
4. _____
5. _____
6. _____
7. _____
8. _____
9. _____
10. _____
11. _____
12. _____

1-10	92	83	75	67	58	50	42	33	25	17
11-12	8	0								

Moltiplicazione di frazioni e numeri interi Nome: **Soluzioni**

Usa i modelli visivi per risolvere.

1) $\frac{1}{2} \times 6 =$

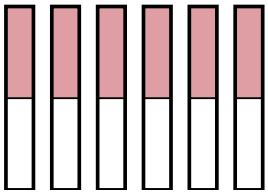

2) $\frac{2}{4} \times 7 =$

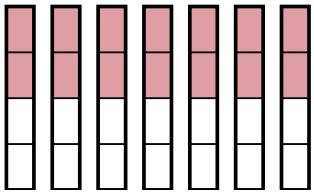

3) $\frac{2}{4} \times 4 =$

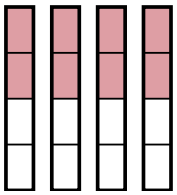

4) $\frac{1}{5} \times 8 =$

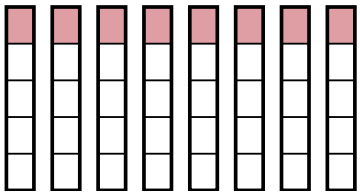

5) $\frac{5}{10} \times 4 =$

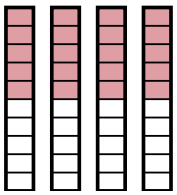

6) $\frac{1}{4} \times 6 =$

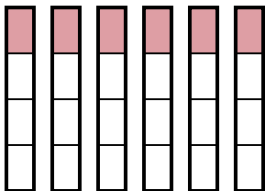

7) $\frac{1}{4} \times 5 =$

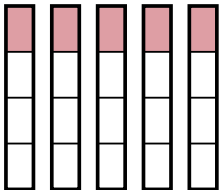

8) $\frac{2}{3} \times 9 =$

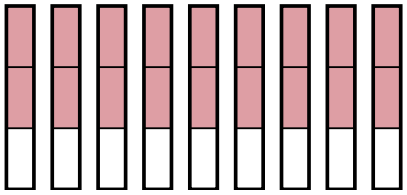

9) $\frac{1}{8} \times 8 =$

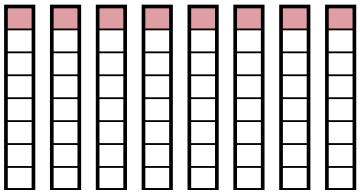

10) $\frac{4}{10} \times 6 =$

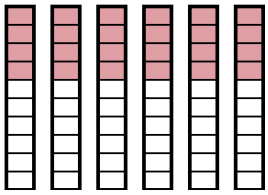

11) $\frac{4}{5} \times 2 =$

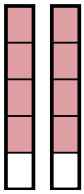

12) $\frac{1}{4} \times 3 =$

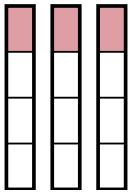

Risposte

1. $\frac{6}{2}$
2. $\frac{14}{4}$
3. $\frac{8}{4}$
4. $\frac{8}{5}$
5. $\frac{20}{10}$
6. $\frac{6}{4}$
7. $\frac{5}{4}$
8. $\frac{18}{3}$
9. $\frac{8}{8}$
10. $\frac{24}{10}$
11. $\frac{8}{5}$
12. $\frac{3}{4}$

1-10	92	83	75	67	58	50	42	33	25	17
11-12	8	0								