**Usa il metodo grafico per risolvere ogni operazione.**

$^{2}/_{4} \times 3 =$

Para resolver problemas de multiplicación con fracciones, una estrategia es pensar en ellos como problemas de suma. Por ejemplo, el problema anterior es el mismo que: $^{2}/_{4} + {}^{2}/_{4} + {}^{2}/_{4}$

$^{2}/_{4} \times 3 =$

Si sombreamos 2/4 en las fracciones de abajo 3 veces, podemos ver una representación visual del problema.

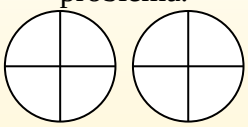

$^{2}/_{4} \times 3 = 1\,{}^{2}/_{4}$

Después de sombrearlo, podemos ver por qué 2/4 tres veces es igual a 1 entero y $^{2}/_{4}$.

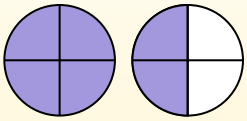

**1)** $\frac{1}{3} \times 6 =$

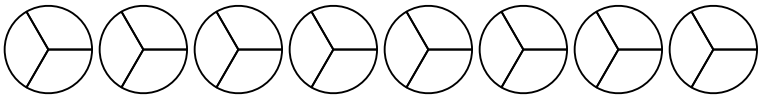

**2)** $\frac{2}{3} \times 6 =$

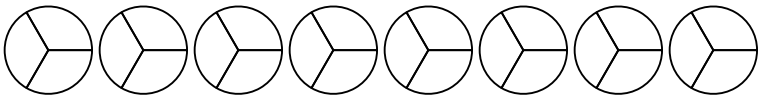

**3)** $\frac{3}{4} \times 2 =$

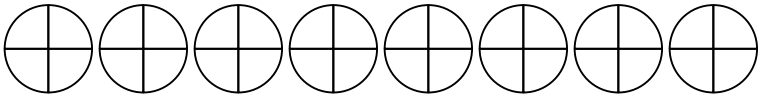

**4)** $\frac{4}{6} \times 2 =$

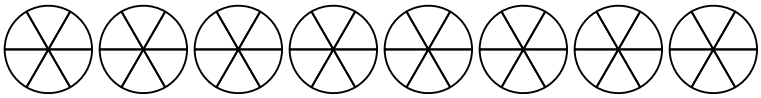

**5)** $\frac{8}{12} \times 4 =$

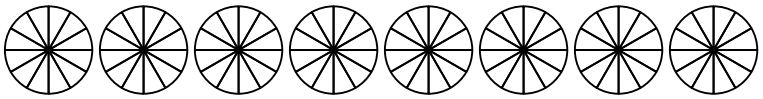

**6)** $\frac{8}{10} \times 6 =$

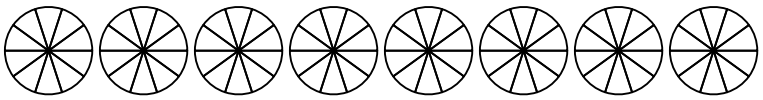

**7)** $\frac{4}{6} \times 6 =$

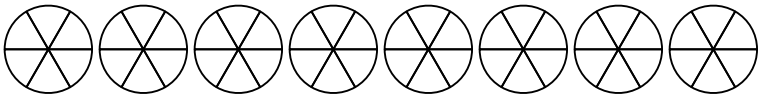

**8)** $\frac{2}{12} \times 7 =$

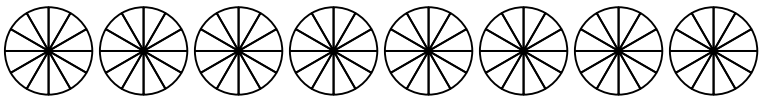

**9)** $\frac{2}{5} \times 6 =$

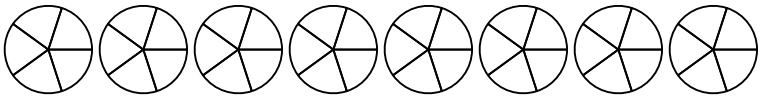

**10)** $\frac{3}{5} \times 5 =$

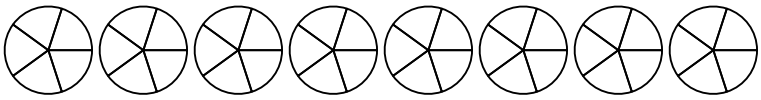

**11)** $\frac{1}{5} \times 3 =$

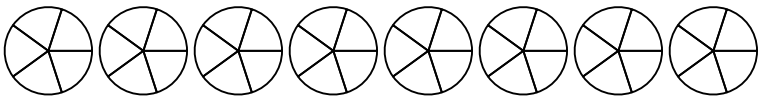

**12)** $\frac{1}{4} \times 7 =$

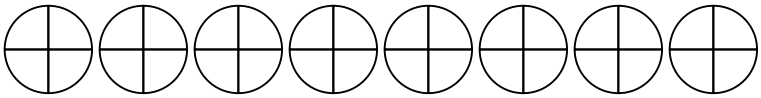

**Risposte**

1. _____
2. _____
3. _____
4. _____
5. _____
6. _____
7. _____
8. _____
9. _____
10. _____
11. _____
12. _____



| | | | | | | | | | | |
|---|---|---|---|---|---|---|---|---|---|---|
| 1-10 | 92 | 83 | 75 | 67 | 58 | 50 | 42 | 33 | 25 | 17 |
| 11-12 | 8 | 0 | | | | | | | | |

Moltiplicazioni tra frazioni e numeri interi Nome: **Soluzioni**

**Usa il metodo grafico per risolvere ogni operazione.**

$^2/_4 \times 3 =$

Para resolver problemas de multiplicación con fracciones, una estrategia es pensar en ellos como problemas de suma. Por ejemplo, el problema anterior es el mismo que: $^2/_4 + {}^2/_4 + {}^2/_4$

$^2/_4 \times 3 =$

Si sombreamos 2/4 en las fracciones de abajo 3 veces, podemos ver una representación visual del problema.

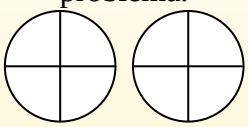

$^2/_4 \times 3 = 1\,{}^2/_4$

Después de sombrearlo, podemos ver por qué 2/4 tres veces es igual a 1 entero y $^2/_4$.

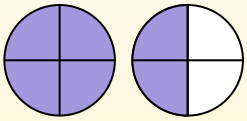

**1)** $\frac{1}{3} \times 6 =$

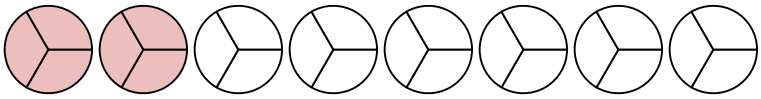

**2)** $\frac{2}{3} \times 6 =$

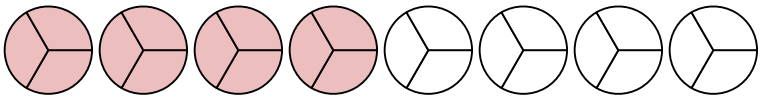

**3)** $\frac{3}{4} \times 2 =$

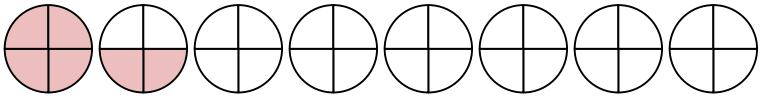

**4)** $\frac{4}{6} \times 2 =$

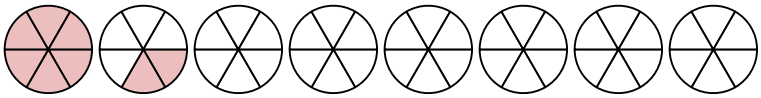

**5)** $\frac{8}{12} \times 4 =$

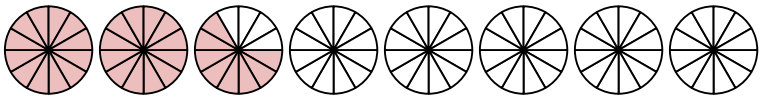

**6)** $\frac{8}{10} \times 6 =$

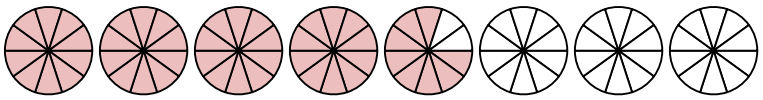

**7)** $\frac{4}{6} \times 6 =$

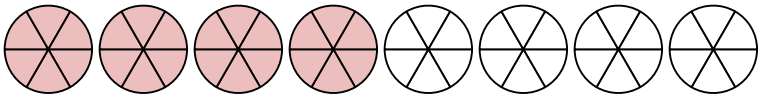

**8)** $\frac{2}{12} \times 7 =$

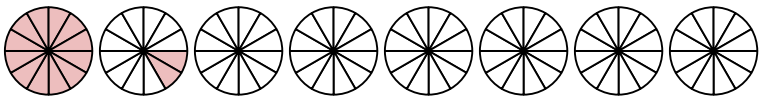

**9)** $\frac{2}{5} \times 6 =$

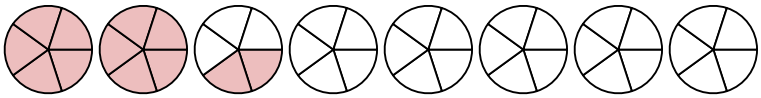

**10)** $\frac{3}{5} \times 5 =$

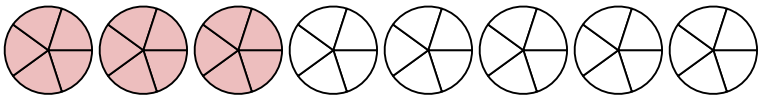

**11)** $\frac{1}{5} \times 3 =$

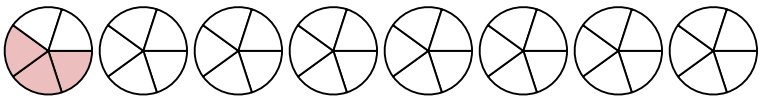

**12)** $\frac{1}{4} \times 7 =$

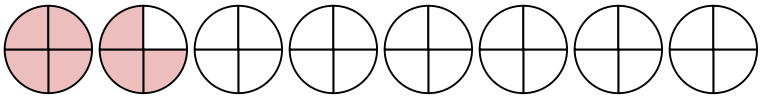

**Risposte**

1. $2\,{}^0/_3$
2. $4\,{}^0/_3$
3. $1\,{}^2/_4$
4. $1\,{}^2/_6$
5. $2\,{}^8/_{12}$
6. $4\,{}^8/_{10}$
7. $4\,{}^0/_6$
8. $1\,{}^2/_{12}$
9. $2\,{}^2/_5$
10. $3\,{}^0/_5$
11. $^3/_5$
12. $1\,{}^3/_4$



| | | | | | | | | | | |
|---|---|---|---|---|---|---|---|---|---|---|
| 1-10 | 92 | 83 | 75 | 67 | 58 | 50 | 42 | 33 | 25 | 17 |
| 11-12 | 8 | 0 | | | | | | | | |