Risolvi ogni problema.

1) Indica la posizione di $^{4}/_{3}$

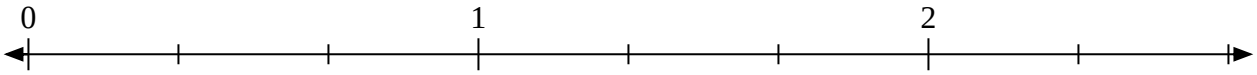

2) Indica la posizione di $^{15}/_{6}$

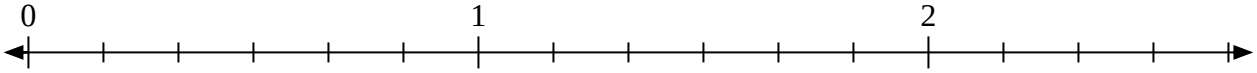

3) Indica la posizione di $^{11}/_{8}$

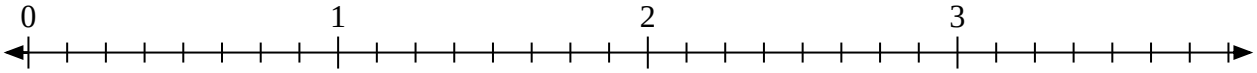

4) Indica la posizione di $^{10}/_{4}$



5) Indica la posizione di $^{21}/_{8}$

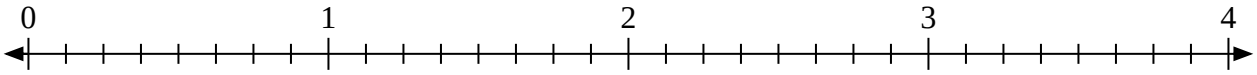

6) Indica la posizione di $^{4}/_{2}$

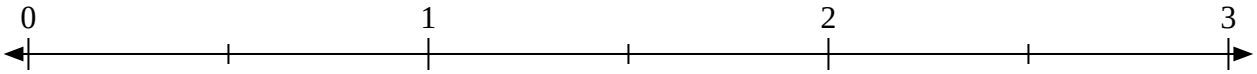

7) Indica la posizione di $^{3}/_{2}$



8) Indica la posizione di $^{14}/_{9}$

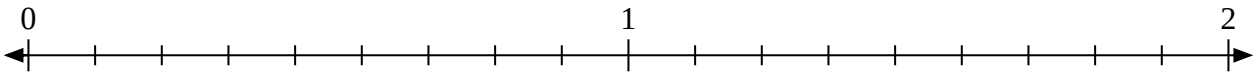

9) Indica la posizione di $^{20}/_{9}$

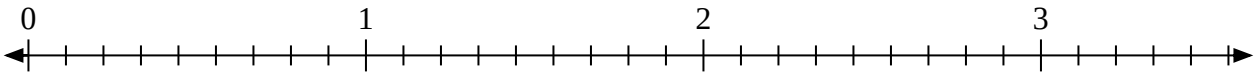

10) Indica la posizione di $^{9}/_{6}$

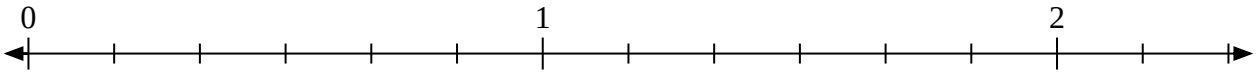

1-10	90	80	70	60	50	40	30	20	10	0

Risolvi ogni problema.

1) Indica la posizione di $^{4}/_{3}$

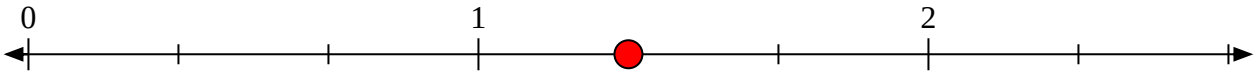

2) Indica la posizione di $^{15}/_{6}$

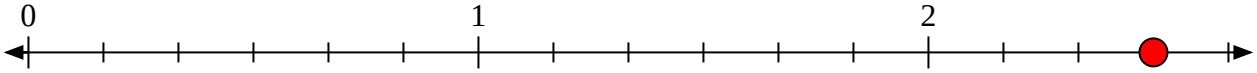

3) Indica la posizione di $^{11}/_{8}$

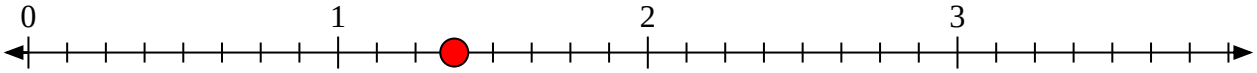

4) Indica la posizione di $^{10}/_{4}$



5) Indica la posizione di $^{21}/_{8}$

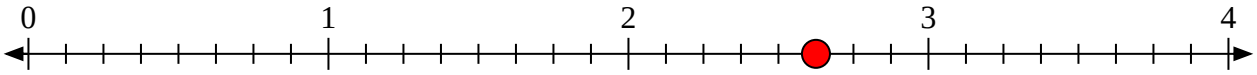

6) Indica la posizione di $^{4}/_{2}$

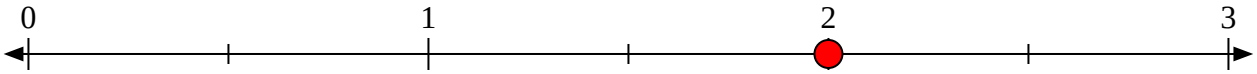

7) Indica la posizione di $^{3}/_{2}$



8) Indica la posizione di $^{14}/_{9}$

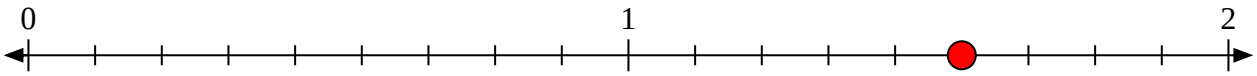

9) Indica la posizione di $^{20}/_{9}$

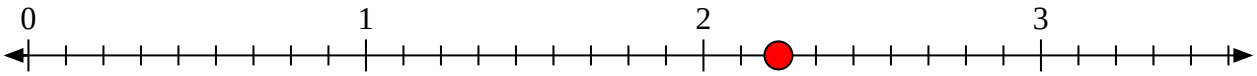

10) Indica la posizione di $^{9}/_{6}$

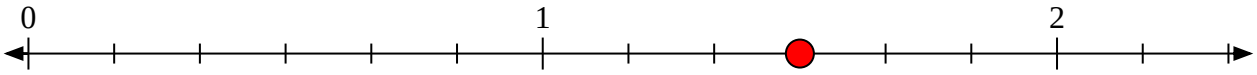

1-10	90	80	70	60	50	40	30	20	10	0