Esprimere le frazioni come parole

Nome:

Scrivi l'importo ombreggiato sotto forma di parole.

Es)



1)

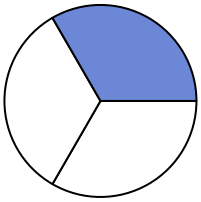

2)

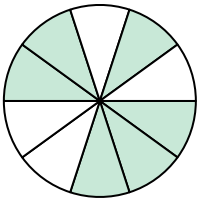

3)

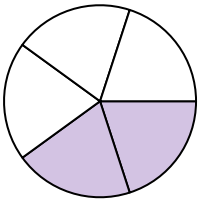

4)

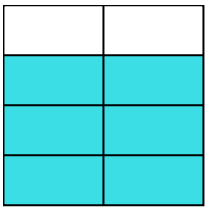

5)

6)

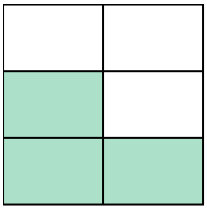

7)

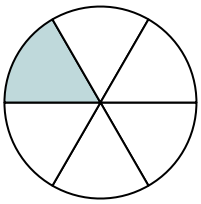

8)

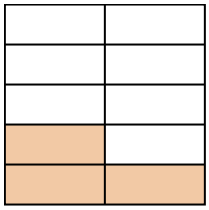

9)

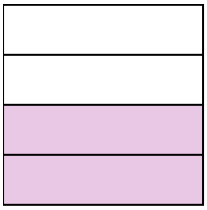

10)

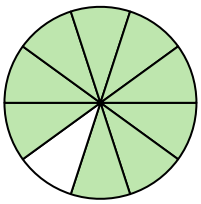

11)

12)

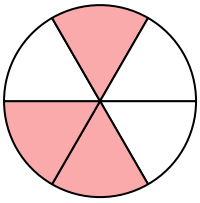

13)



14)

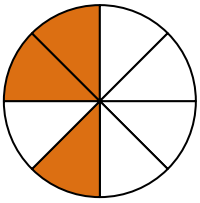

Risposte

Es. cinque ottavi

1. _____
2. _____
3. _____
4. _____
5. _____
6. _____
7. _____
8. _____
9. _____
10. _____
11. _____
12. _____
13. _____
14. _____

1-10	93	86	79	71	64	57	50	43	36	29
11-14	21	14	7	0						

Esprimere le frazioni come parole

Nome: **Soluzioni**

Scrivi l'importo ombreggiato sotto forma di parole.

Es)



1)

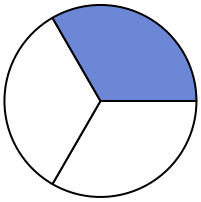

2)

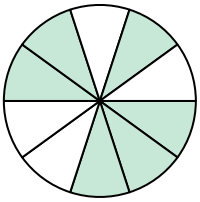

3)

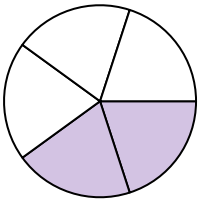

4)

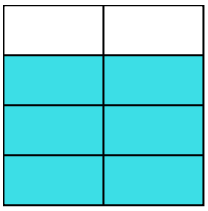

5)

6)

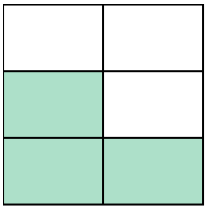

7)

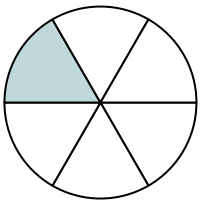

8)

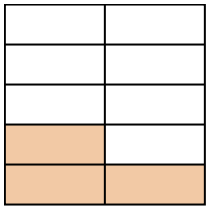

9)

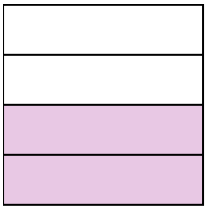

10)

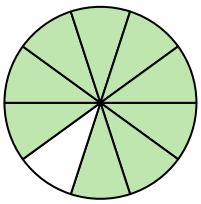

11)

12)

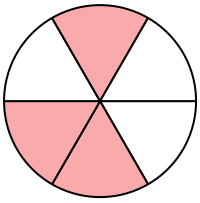

13)



14)

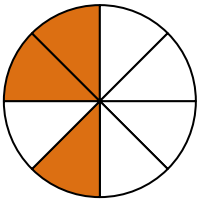

Risposte

Es. cinque ottavi

1. un terzo
2. sei decimi
3. due quinti
4. sei settimi
5. tre settimi
6. tre quinti
7. un sesto
8. tre noni
9. due quarti
10. nove decimi
11. tre quarti
12. tre sesti
13. metà
14. tre ottavi

1-10	93	86	79	71	64	57	50	43	36	29
11-14	21	14	7	0						