Esprimere le frazioni come parole

Nome:

Scrivi l'importo ombreggiato sotto forma di parole.

Es)



1)



2)

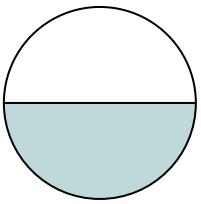

3)



4)

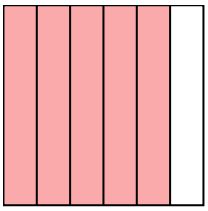

5)

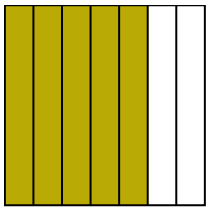

6)

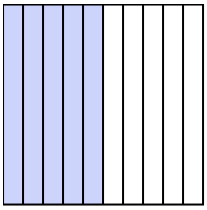

7)

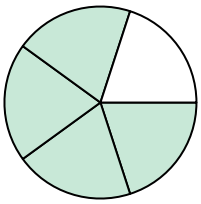

8)

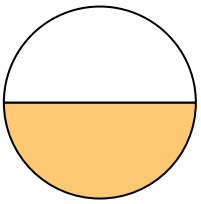

9)

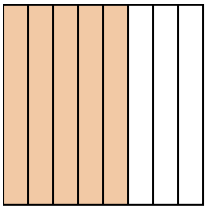

10)

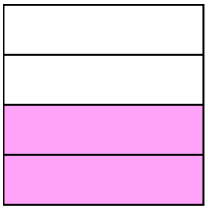

11)



12)

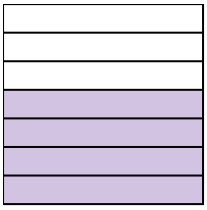

13)

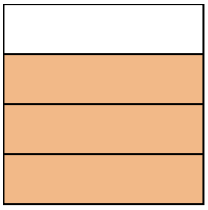

14)

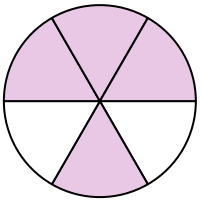

Risposte

Es. un terzo

1. _____
2. _____
3. _____
4. _____
5. _____
6. _____
7. _____
8. _____
9. _____
10. _____
11. _____
12. _____
13. _____
14. _____

1-10	93	86	79	71	64	57	50	43	36	29
11-14	21	14	7	0						

Esprimere le frazioni come parole

Nome: **Soluzioni**

Scrivi l'importo ombreggiato sotto forma di parole.

Es)



1)



2)

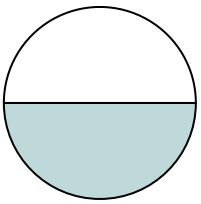

3)



4)

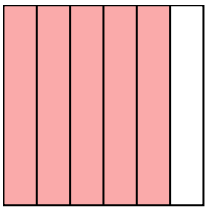

5)

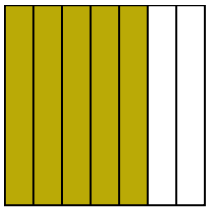

6)

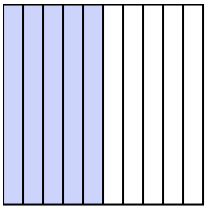

7)

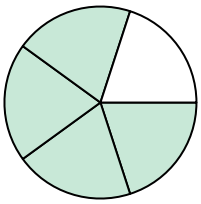

8)

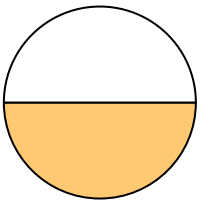

9)

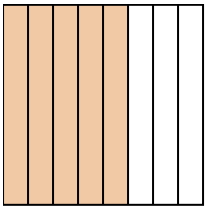

10)

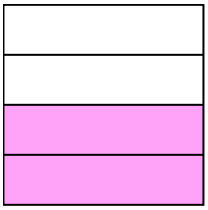

11)



12)

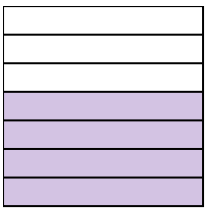

13)



14)

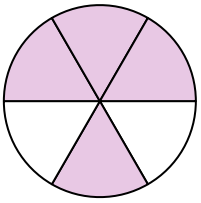

Risposte

Es. un terzo

1. due terzi
2. metà
3. un quinto
4. cinque sesti
5. cinque settimi
6. cinque decimi
7. quattro quinti
8. metà
9. cinque ottavi
10. due quarti
11. un ottavo
12. quattro settimi
13. tre quarti
14. quattro sesti

1-10	93	86	79	71	64	57	50	43	36	29
11-14	21	14	7	0						