Determinazione del valore decimale con i blocchi Nome:

Usa il blocco a sinistra per trovare il valore dell'insieme di blocchi a destra.

1) 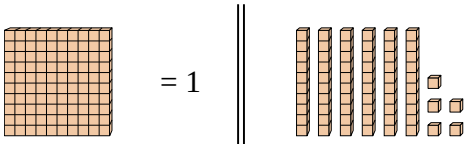

2) 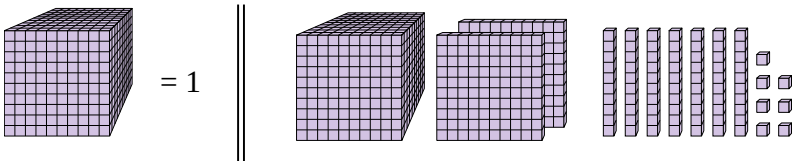

3) 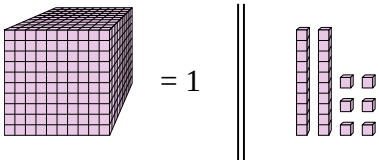

4) 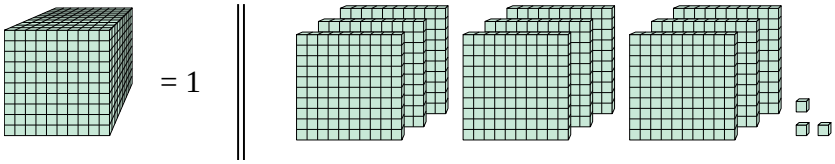

5) 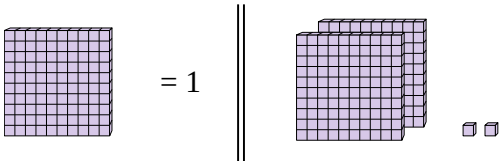

6) 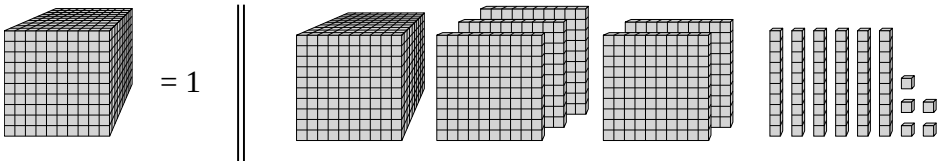

7) 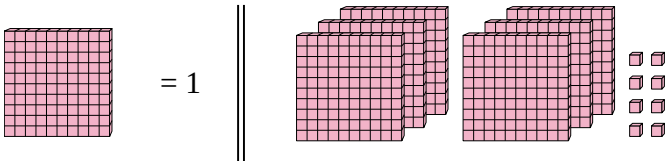

8) 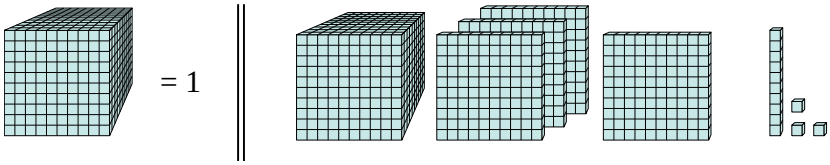

9) 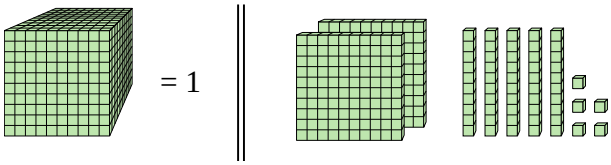

10) 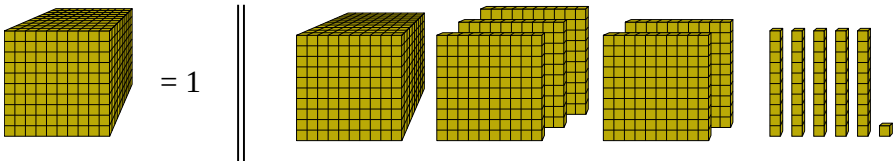

Risposte

1. _____
2. _____
3. _____
4. _____
5. _____
6. _____
7. _____
8. _____
9. _____
10. _____

1-10	90	80	70	60	50	40	30	20	10	0

Determinazione del valore decimale con i blocchi Nome: **Soluzioni**

Usa il blocco a sinistra per trovare il valore dell'insieme di blocchi a destra.

1) 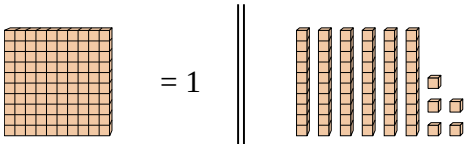

2) 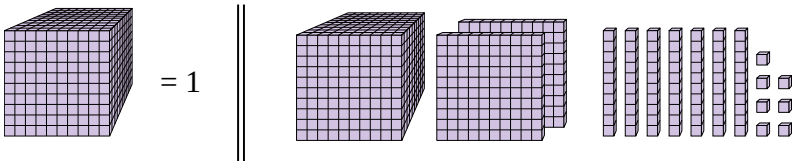

3) 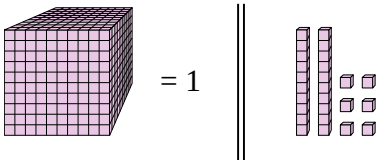

4) 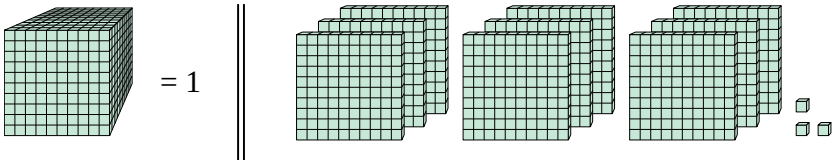

5) 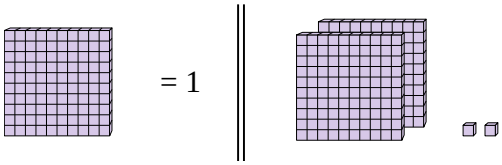

6) 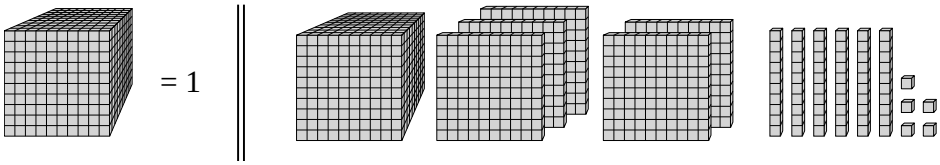

7) 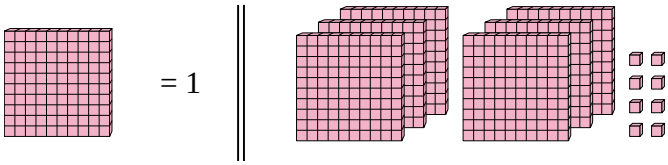

8) 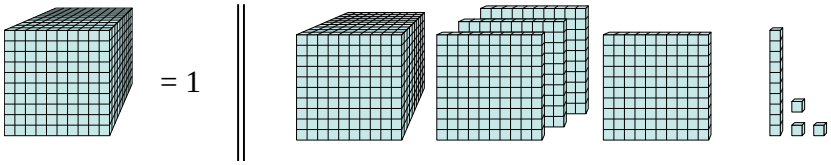

9) 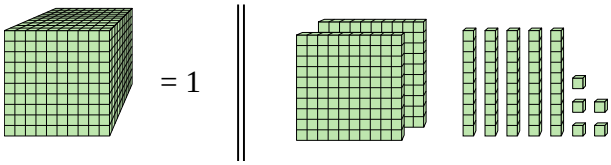

10) 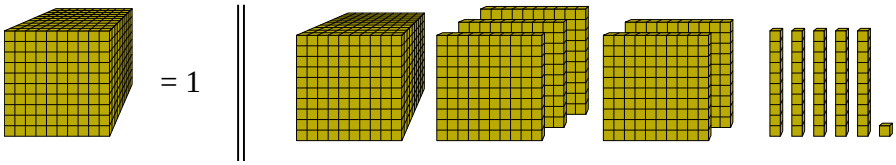

Risposte

1. **0,65**
2. **1,277**
3. **0,026**
4. **0,903**
5. **2,02**
6. **1,565**
7. **6,08**
8. **1,413**
9. **0,255**
10. **1,551**

1-10	90	80	70	60	50	40	30	20	10	0