Determinazione del valore decimale con i blocchi Nome:

Usa il blocco a sinistra per trovare il valore dell'insieme di blocchi a destra.

1) 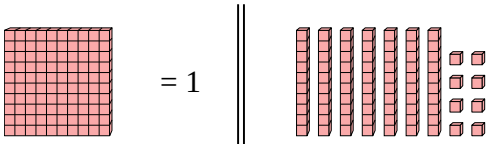 = 1

2) 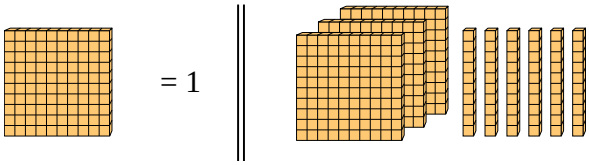 = 1

3) 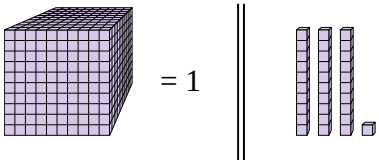 = 1

4) 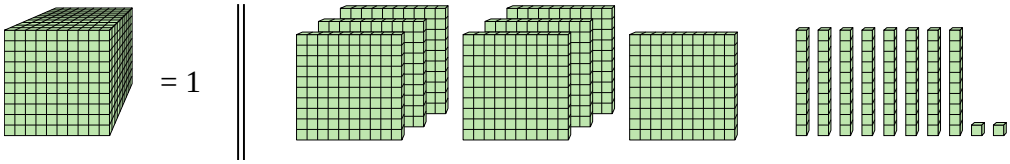 = 1

5) 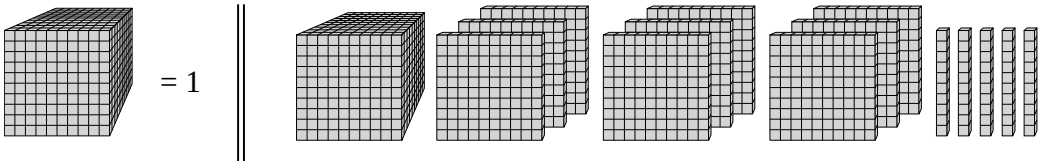 = 1

6) 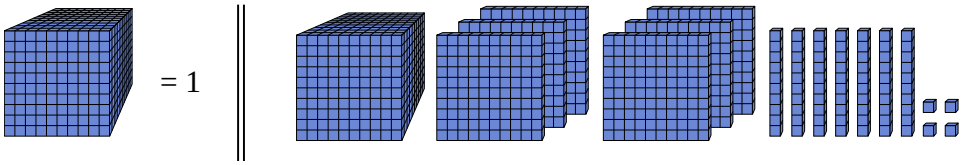 = 1

7) 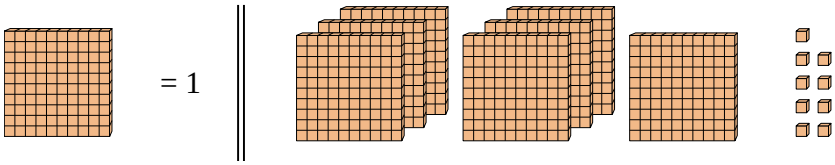 = 1

8) 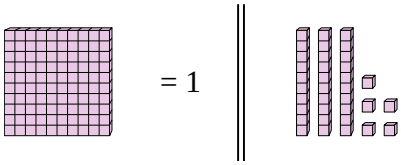 = 1

9) 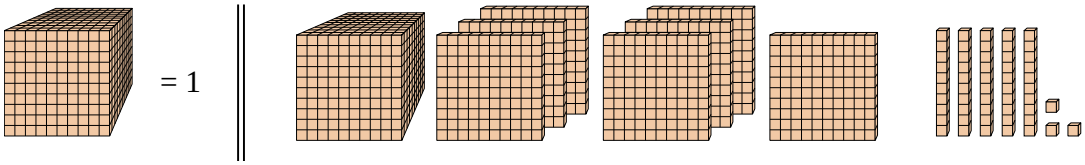 = 1

10) 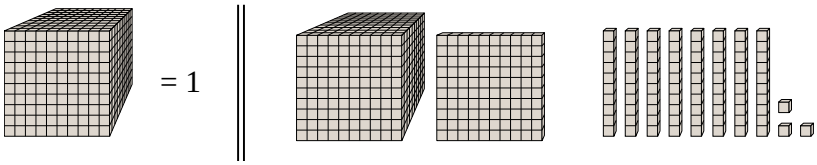 = 1

Risposte

1. _____
2. _____
3. _____
4. _____
5. _____
6. _____
7. _____
8. _____
9. _____
10. _____

1-10	90	80	70	60	50	40	30	20	10	0

Determinazione del valore decimale con i blocchi Nome: **Soluzioni**

Usa il blocco a sinistra per trovare il valore dell'insieme di blocchi a destra.

1) 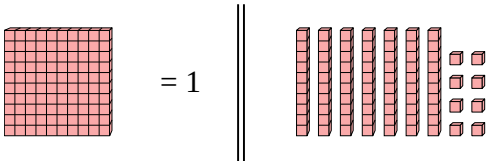

2) 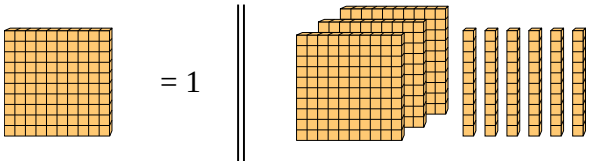

3) 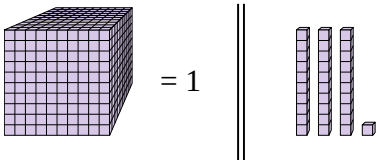

4) 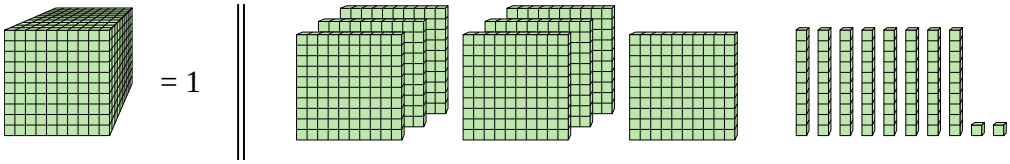

5) 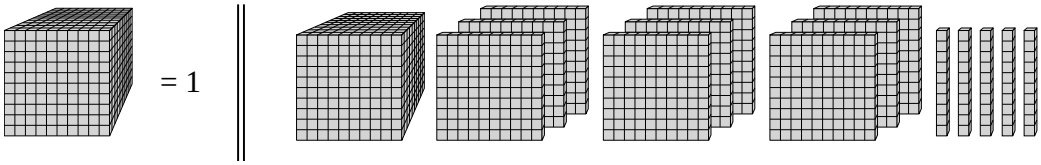

6) 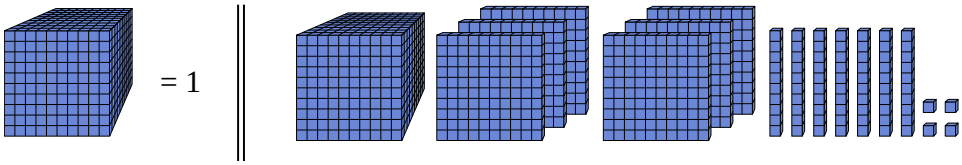

7) 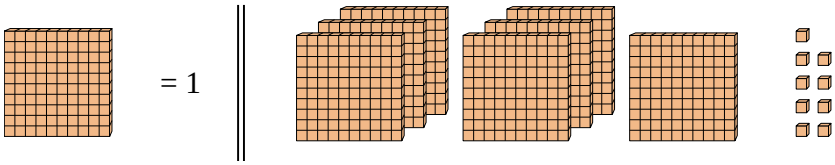

8) 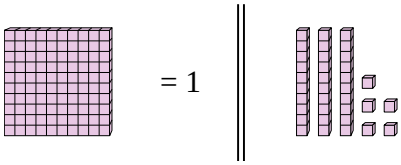

9) 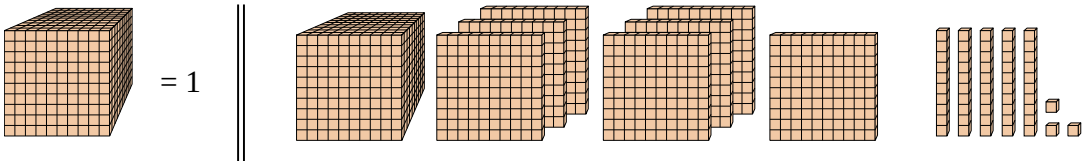

10) 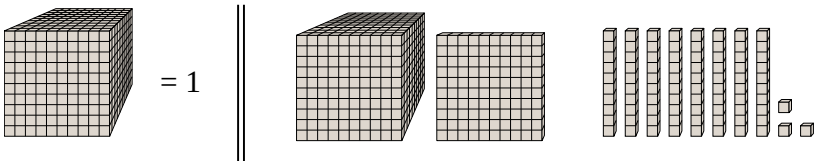

Risposte

1. **0,78**
2. **3,6**
3. **0,031**
4. **0,782**
5. **1,95**
6. **1,674**
7. **7,09**
8. **0,35**
9. **1,753**
10. **1,183**

1-10	90	80	70	60	50	40	30	20	10	0