Risolvi ogni problema.

1) Il rettangolo sottostante ha dimensioni 1×8. Crea un rettangolo con la stessa area, ma con un perimetro diverso.

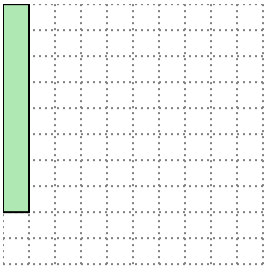



2) Il rettangolo sottostante ha dimensioni 3×4. Crea un rettangolo con la stessa area, ma con un perimetro diverso.

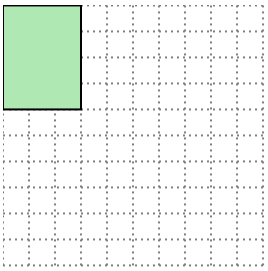



3) Il rettangolo sottostante ha dimensioni 4×5. Crea un rettangolo con la stessa area, ma con un perimetro diverso.

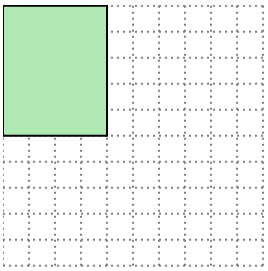



4) Il rettangolo sottostante ha dimensioni 2×5. Crea un rettangolo con la stessa area, ma con un perimetro diverso.

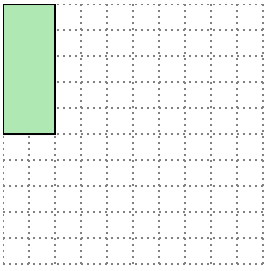



5) Il rettangolo sottostante ha dimensioni 1×4. Crea un rettangolo con la stessa area, ma con un perimetro diverso.

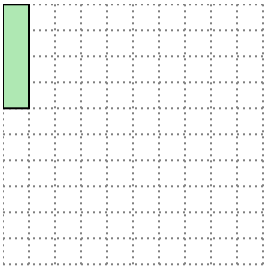



Risposte

1. _____
2. _____
3. _____
4. _____
5. _____

1-5	80	60	40	20	0

Risolvi ogni problema.

1) Il rettangolo sottostante ha dimensioni 1×8. Crea un rettangolo con la stessa area, ma con un perimetro diverso.

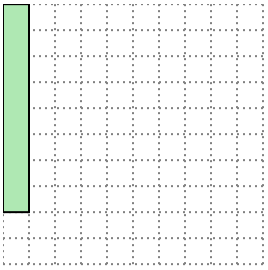



2×4

2) Il rettangolo sottostante ha dimensioni 3×4. Crea un rettangolo con la stessa area, ma con un perimetro diverso.

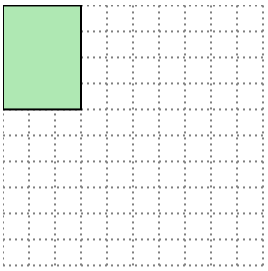



2×6

3) Il rettangolo sottostante ha dimensioni 4×5. Crea un rettangolo con la stessa area, ma con un perimetro diverso.

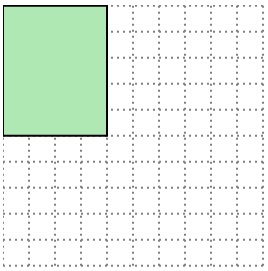



2×10

4) Il rettangolo sottostante ha dimensioni 2×5. Crea un rettangolo con la stessa area, ma con un perimetro diverso.

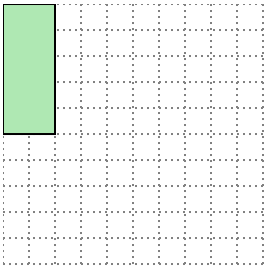



1×10

5) Il rettangolo sottostante ha dimensioni 1×4. Crea un rettangolo con la stessa area, ma con un perimetro diverso.

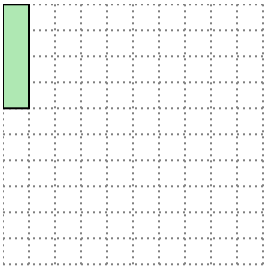



2×2

Risposte

1. 2×4
2. 2×6
3. 2×10
4. 1×10
5. 2×2

1-5	80	60	40	20	0