Risolvi ogni problema.

1) Il rettangolo sottostante ha dimensioni 3×3. Crea un rettangolo con la stessa area, ma con un perimetro diverso.

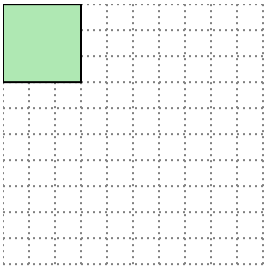



2) Il rettangolo sottostante ha dimensioni 2×9. Crea un rettangolo con la stessa area, ma con un perimetro diverso.

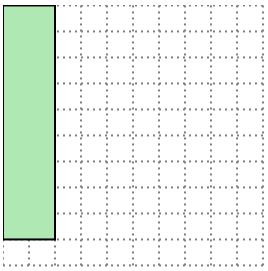



3) Il rettangolo sottostante ha dimensioni 4×5. Crea un rettangolo con la stessa area, ma con un perimetro diverso.

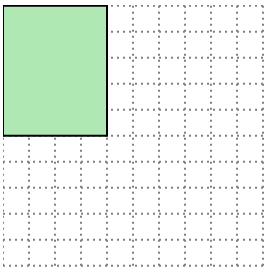



4) Il rettangolo sottostante ha dimensioni 2×3. Crea un rettangolo con la stessa area, ma con un perimetro diverso.

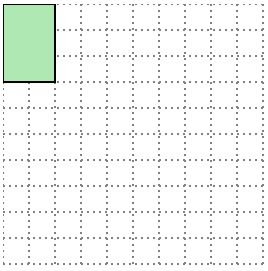



5) Il rettangolo sottostante ha dimensioni 2×4. Crea un rettangolo con la stessa area, ma con un perimetro diverso.

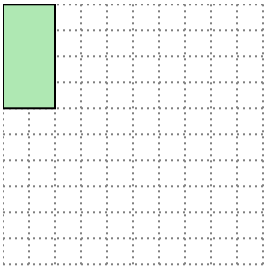



Risposte

1. _____
2. _____
3. _____
4. _____
5. _____

1-5	80	60	40	20	0

Risolvi ogni problema.

1) Il rettangolo sottostante ha dimensioni 3×3. Crea un rettangolo con la stessa area, ma con un perimetro diverso.

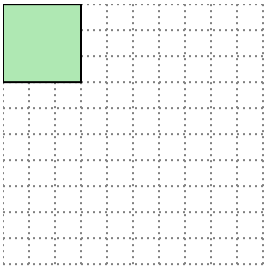



1×9

2) Il rettangolo sottostante ha dimensioni 2×9. Crea un rettangolo con la stessa area, ma con un perimetro diverso.

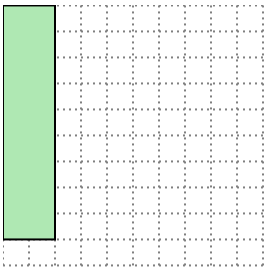



3×6

3) Il rettangolo sottostante ha dimensioni 4×5. Crea un rettangolo con la stessa area, ma con un perimetro diverso.

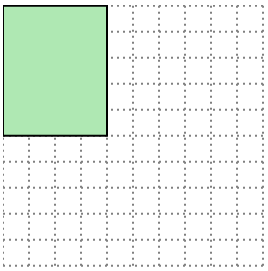



2×10

4) Il rettangolo sottostante ha dimensioni 2×3. Crea un rettangolo con la stessa area, ma con un perimetro diverso.

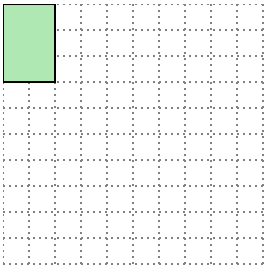



1×6

5) Il rettangolo sottostante ha dimensioni 2×4. Crea un rettangolo con la stessa area, ma con un perimetro diverso.

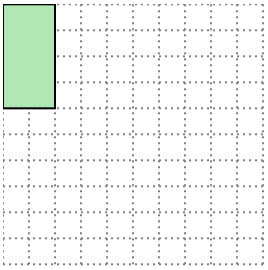



1×8

Risposte

1. **1×9**
2. **3×6**
3. **2×10**
4. **1×6**
5. **1×8**

1-5	80	60	40	20	0