Creazione di rettangoli di area e perimetro Nome:

Utilizzare i diagrammi seguenti per creare un rettangolo con l'area/perimetro mostrato. Ogni SVGREPLACE = 1 unità(u). Rispondi con la lunghezza e l'altezza. Le risposte varieranno.

1) Area di 30 unità quadrate.



2) Area di 54 unità quadrate.



3) Perimetro di 24 unità.



4) Area di 3 unità quadrate.



5) Area di 21 unità quadrate.



6) Perimetro di 18 unità.



7) Area di 45 unità quadrate.



8) Perimetro di 8 unità.



9) Area di 10 unità quadrate.



10) Perimetro di 6 unità.



11) Perimetro di 16 unità.



12) Area di 9 unità quadrate.



Risposte

1. ____ ____ $=30u^2$
2. ____ ____ $=54u^2$
3. ____ ____ $=24u$
4. ____ ____ $=3u^2$
5. ____ ____ $=21u^2$
6. ____ ____ $=18u$
7. ____ ____ $=45u^2$
8. ____ ____ $=8u$
9. ____ ____ $=10u^2$
10. ____ ____ $=6u$
11. ____ ____ $=16u$
12. ____ ____ $=9u^2$

1-10	92	83	75	67	58	50	42	33	25	17
11-12	8	0								

Creazione di rettangoli di area e perimetro Nome: **Soluzioni**

Utilizzare i diagrammi seguenti per creare un rettangolo con l'area/perimetro mostrato. Ogni SVGREPLACE = 1 unità(u). Rispondi con la lunghezza e l'altezza. Le risposte varieranno.

1) Area di 30 unità quadrate.



2) Area di 54 unità quadrate.



3) Perimetro di 24 unità.



4) Area di 3 unità quadrate.



5) Area di 21 unità quadrate.



6) Perimetro di 18 unità.



7) Area di 45 unità quadrate.



8) Perimetro di 8 unità.



9) Area di 10 unità quadrate.



10) Perimetro di 6 unità.



11) Perimetro di 16 unità.



12) Area di 9 unità quadrate.



Risposte

1. ___ ___ $=30u^2$
2. ___ ___ $=54u^2$
3. ___ ___ $=24u$
4. ___ ___ $=3u^2$
5. ___ ___ $=21u^2$
6. ___ ___ $=18u$
7. ___ ___ $=45u^2$
8. ___ ___ $=8u$
9. ___ ___ $=10u^2$
10. ___ ___ $=6u$
11. ___ ___ $=16u$
12. ___ ___ $=9u^2$

1-10	92	83	75	67	58	50	42	33	25	17
11-12	8	0								