Creazione di rettangoli di area e perimetro Nome:

Utilizzare i diagrammi seguenti per creare un rettangolo con l'area/perimetro mostrato. Ogni SVGREPLACE = 1 unità(u). Rispondi con la lunghezza e l'altezza. Le risposte varieranno.

1) Area di 16 unità quadrate.



2) Perimetro di 40 unità.



3) Perimetro di 6 unità.



4) Perimetro di 20 unità.



5) Perimetro di 26 unità.



6) Area di 32 unità quadrate.



7) Area di 7 unità quadrate.



8) Area di 42 unità quadrate.



9) Perimetro di 22 unità.



10) Perimetro di 38 unità.



11) Perimetro di 8 unità.



12) Area di 21 unità quadrate.



Risposte

1. ___ ___ =16u²
2. ___ ___ =40u
3. ___ ___ =6u
4. ___ ___ =20u
5. ___ ___ =26u
6. ___ ___ =32u²
7. ___ ___ =7u²
8. ___ ___ =42u²
9. ___ ___ =22u
10. ___ ___ =38u
11. ___ ___ =8u
12. ___ ___ =21u²

1-10	92	83	75	67	58	50	42	33	25	17
11-12	8	0								

Creazione di rettangoli di area e perimetro Nome: **Soluzioni**

Utilizzare i diagrammi seguenti per creare un rettangolo con l'area/perimetro mostrato. Ogni SVGREPLACE = 1 unità(u). Rispondi con la lunghezza e l'altezza. Le risposte varieranno.

1) Area di 16 unità quadrate.



2) Perimetro di 40 unità.



3) Perimetro di 6 unità.



4) Perimetro di 20 unità.



5) Perimetro di 26 unità.



6) Area di 32 unità quadrate.



7) Area di 7 unità quadrate.



8) Area di 42 unità quadrate.



9) Perimetro di 22 unità.



10) Perimetro di 38 unità.



11) Perimetro di 8 unità.



12) Area di 21 unità quadrate.



Risposte

1. ___ ___ $=16u^2$
2. ___ ___ $=40u$
3. ___ ___ $=6u$
4. ___ ___ $=20u$
5. ___ ___ $=26u$
6. ___ ___ $=32u^2$
7. ___ ___ $=7u^2$
8. ___ ___ $=42u^2$
9. ___ ___ $=22u$
10. ___ ___ $=38u$
11. ___ ___ $=8u$
12. ___ ___ $=21u^2$

1-10	92	83	75	67	58	50	42	33	25	17
11-12	8	0								