Creazione di rettangoli di area e perimetro Nome:

Utilizzare i diagrammi seguenti per creare un rettangolo con l'area/perimetro mostrato. Ogni SVGREPLACE = 1 unità(u). Rispondi con la lunghezza e l'altezza. Le risposte varieranno.

1) Area di 36 unità quadrate.



2) Perimetro di 38 unità.



3) Area di 7 unità quadrate.



4) Area di 16 unità quadrate.



5) Perimetro di 28 unità.



6) Perimetro di 40 unità.



7) Perimetro di 22 unità.



8) Area di 21 unità quadrate.



9) Area di 12 unità quadrate.



10) Area di 3 unità quadrate.



11) Area di 9 unità quadrate.



12) Perimetro di 18 unità.



Risposte

1. ___ ___ $=36u^2$
2. ___ ___ $=38u$
3. ___ ___ $=7u^2$
4. ___ ___ $=16u^2$
5. ___ ___ $=28u$
6. ___ ___ $=40u$
7. ___ ___ $=22u$
8. ___ ___ $=21u^2$
9. ___ ___ $=12u^2$
10. ___ ___ $=3u^2$
11. ___ ___ $=9u^2$
12. ___ ___ $=18u$

1-10	92	83	75	67	58	50	42	33	25	17
11-12	8	0								

Creazione di rettangoli di area e perimetro Nome: **Soluzioni**

Utilizzare i diagrammi seguenti per creare un rettangolo con l'area/perimetro mostrato. Ogni SVGREPLACE = 1 unità(u). Rispondi con la lunghezza e l'altezza. Le risposte varieranno.

1) Area di 36 unità quadrate.



2) Perimetro di 38 unità.



3) Area di 7 unità quadrate.



4) Area di 16 unità quadrate.



5) Perimetro di 28 unità.



6) Perimetro di 40 unità.



7) Perimetro di 22 unità.



8) Area di 21 unità quadrate.



9) Area di 12 unità quadrate.



10) Area di 3 unità quadrate.



11) Area di 9 unità quadrate.



12) Perimetro di 18 unità.



Risposte

1. ___ ___ $=36u^2$
2. ___ ___ $=38u$
3. ___ ___ $=7u^2$
4. ___ ___ $=16u^2$
5. ___ ___ $=28u$
6. ___ ___ $=40u$
7. ___ ___ $=22u$
8. ___ ___ $=21u^2$
9. ___ ___ $=12u^2$
10. ___ ___ $=3u^2$
11. ___ ___ $=9u^2$
12. ___ ___ $=18u$

1-10	92	83	75	67	58	50	42	33	25	17
11-12	8	0								