Calcola l'area con i quadrati colorati

Nome:

Trova l'area di ciascuna sezione colorata. Ogni quadratino equivale ad 1 unità (u^2).

1) 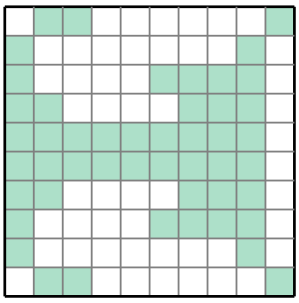

2) 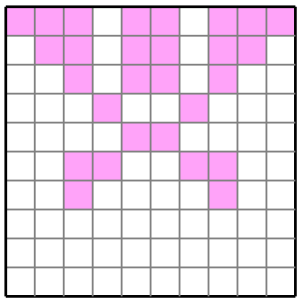

3) 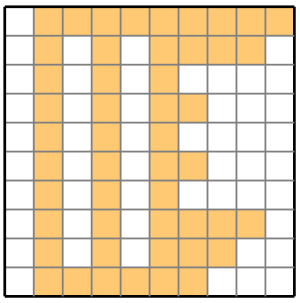

4) 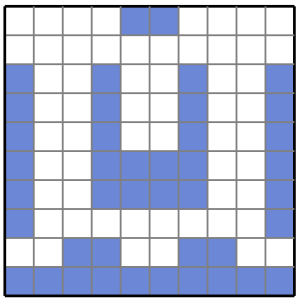

5) 

6) 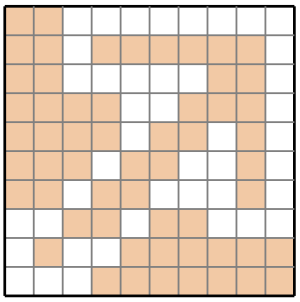

7) 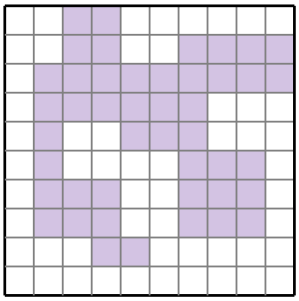

8) 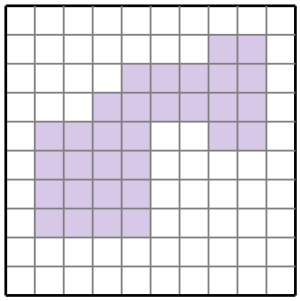

9) 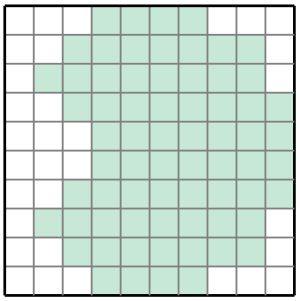

10) 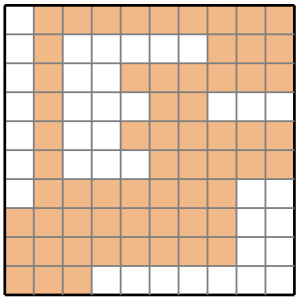

11) 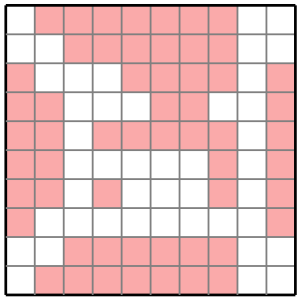

12) 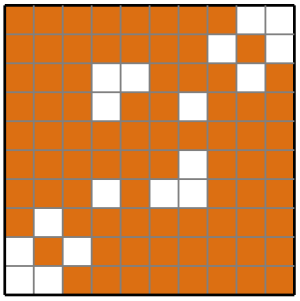

Risposte

1. _____
2. _____
3. _____
4. _____
5. _____
6. _____
7. _____
8. _____
9. _____
10. _____
11. _____
12. _____

1-10	92	83	75	67	58	50	42	33	25	17
11-12	8	0								

Calcola l'area con i quadrati colorati

Nome: **Soluzioni**

Trova l'area di ciascuna sezione colorata. Ogni quadratino equivale ad 1 unità (u^2).

1)

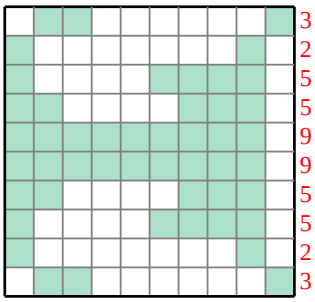

2)

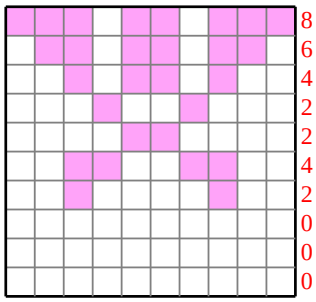

3)

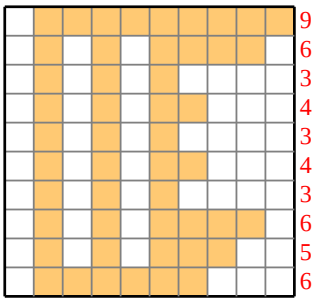

4)

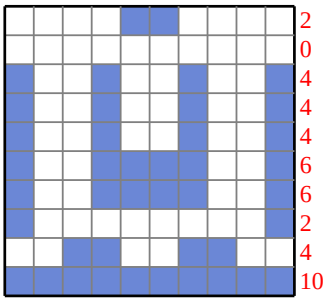

5)

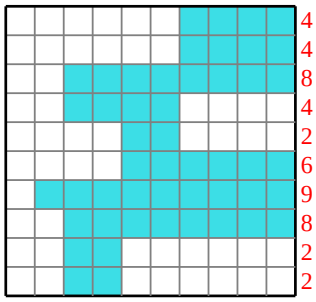

6)

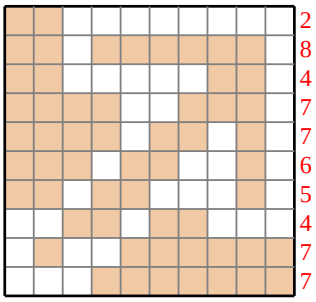

7)

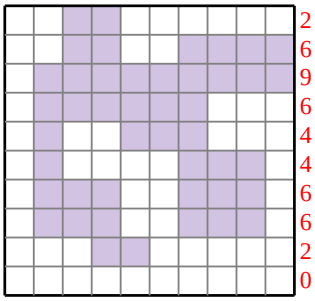

8)

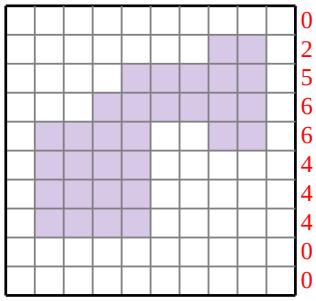

9)

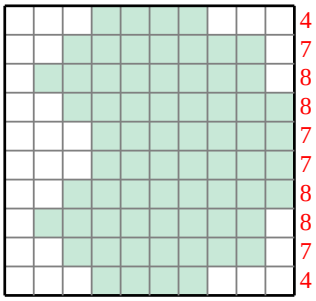

10)

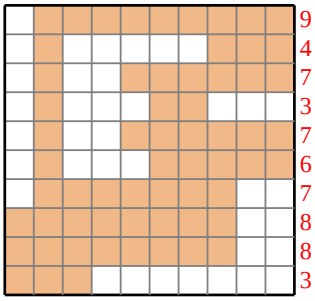

11)

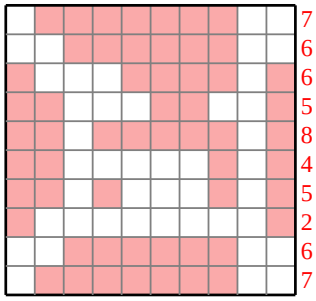

12)

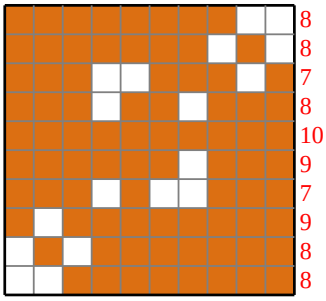

Risposte

1. **48 u^2**
2. **28 u^2**
3. **49 u^2**
4. **42 u^2**
5. **49 u^2**
6. **57 u^2**
7. **45 u^2**
8. **31 u^2**
9. **68 u^2**
10. **62 u^2**
11. **56 u^2**
12. **82 u^2**

1-10	92	83	75	67	58	50	42	33	25	17
11-12	8	0								