Calcola area e perimetro. Non sono in scala.

1)

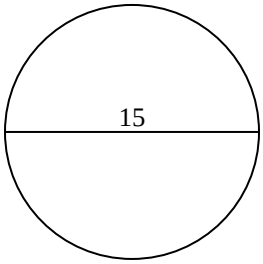

2)

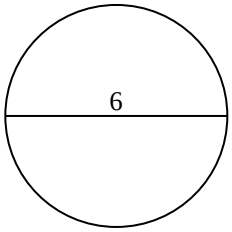

3)

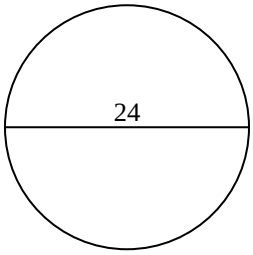

4)

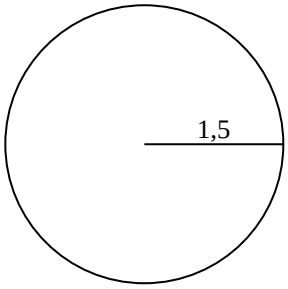

5)

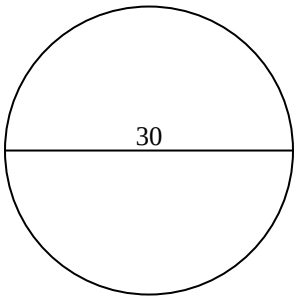

6)

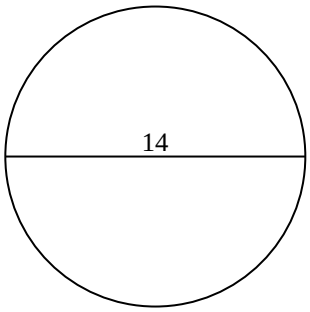

7)

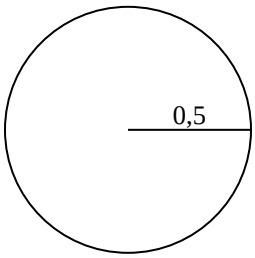

8)

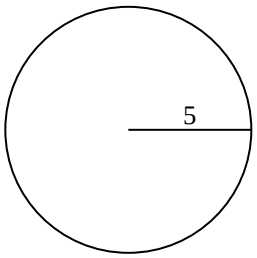

9)

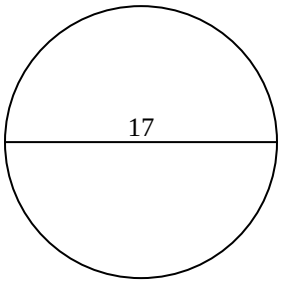

10)

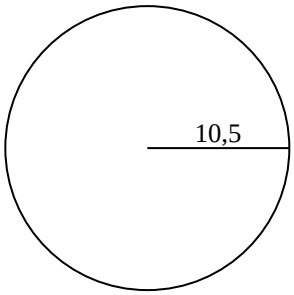

Risposte

1. _____ _____
2. _____ _____
3. _____ _____
4. _____ _____
5. _____ _____
6. _____ _____
7. _____ _____
8. _____ _____
9. _____ _____
10. _____ _____

1-10	90	80	70	60	50	40	30	20	10	0

Calcola area e perimetro

Nome: **Soluzioni**

Calcola area e perimetro. Non sono in scala.

1)

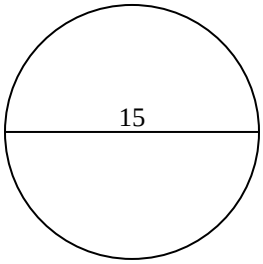

2)

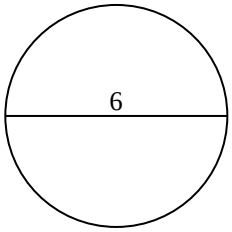

3)

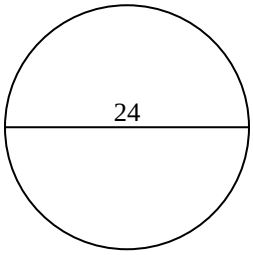

4)

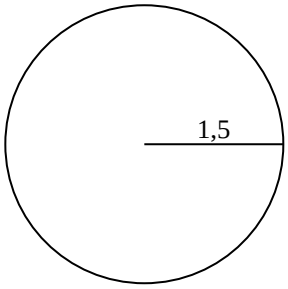

5)

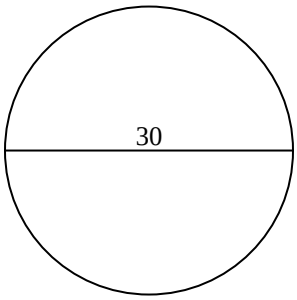

6)

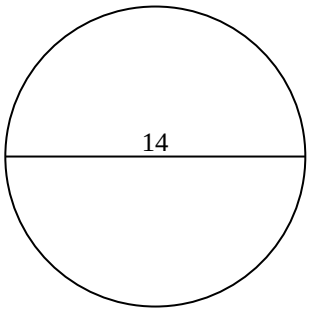

7)

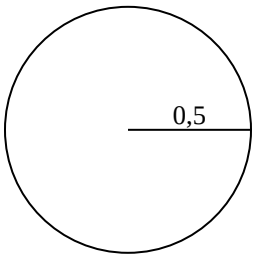

8)

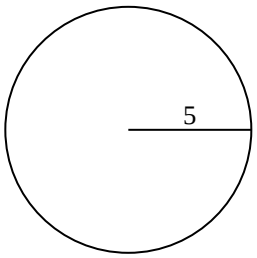

9)

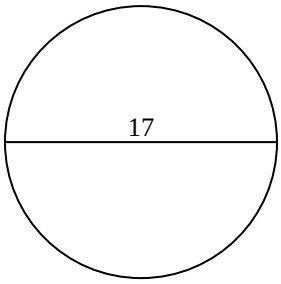

10)

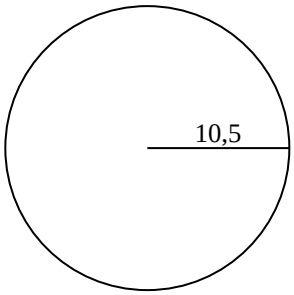

Risposte

1.	176,7	47,1
2.	28,3	18,8
3.	452,4	75,4
4.	7,1	9,4
5.	706,9	94,2
6.	153,9	44
7.	0,8	3,1
8.	78,5	31,4
9.	227	53,4
10.	346,4	66

1-10	90	80	70	60	50	40	30	20	10	0

Calcola area e perimetro

Nome:

Calcola area e perimetro. Non sono in scala.

78,5	75,4	7,1	18,8	53,4
31,4	28,3	153,9	3,1	9,4
176,7	0,8	452,4	706,9	47,1
227	44	94,2		

1)

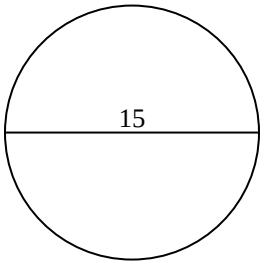

2)

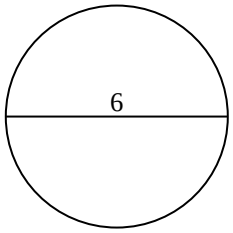

3)

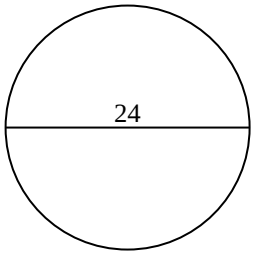

4)

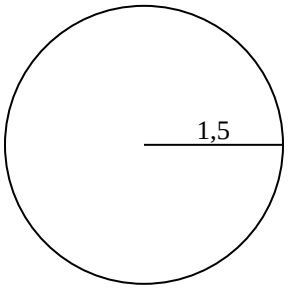

5)

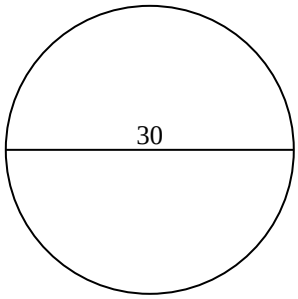

6)

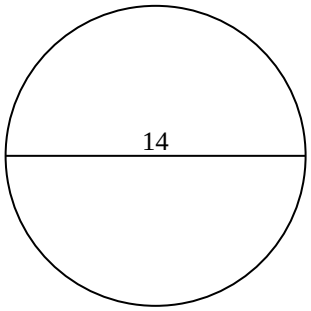

7)

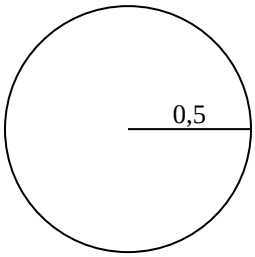

8)

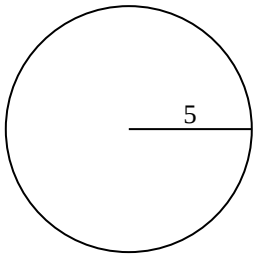

9)

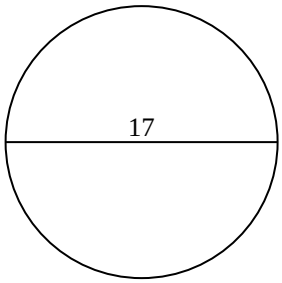

Risposte

1. _____ _____
2. _____ _____
3. _____ _____
4. _____ _____
5. _____ _____
6. _____ _____
7. _____ _____
8. _____ _____
9. _____ _____

1-9	89	78	67	56	44	33	22	11	0