Identificazione del volume di una scatola

Nome:

Determina il volume di ciascuna scatola. Ogni blocco è 1 unità cubica (u 3).

1)

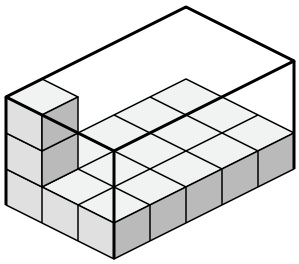

2)

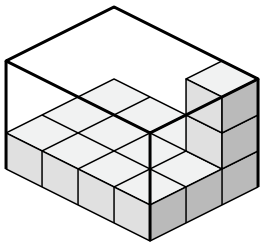

3)

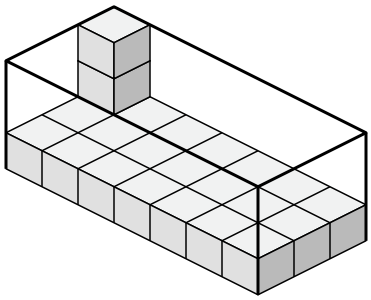

4)

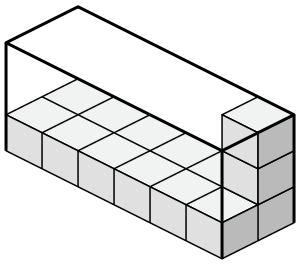

5)

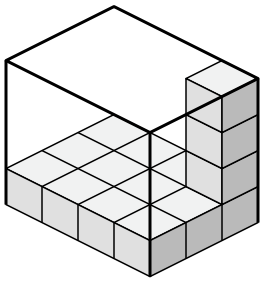

6)

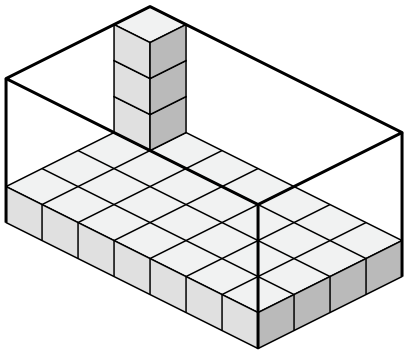

7)

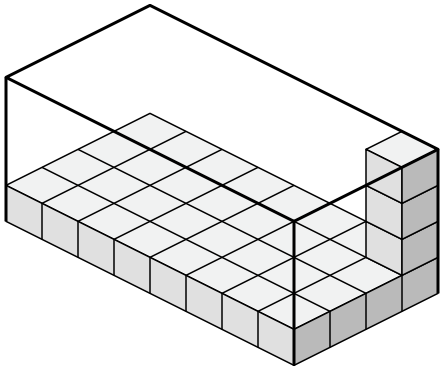

8)

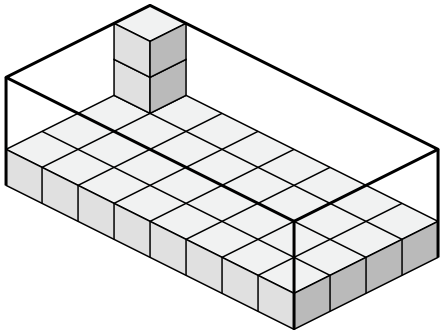

Risposte

1. _____
2. _____
3. _____
4. _____
5. _____
6. _____
7. _____
8. _____

1-8	88	75	63	50	38	25	13	0

Identificazione del volume di una scatola Nome: **Soluzioni**

Determina il volume di ciascuna scatola. Ogni blocco è 1 unità cubica (u 3).

1)

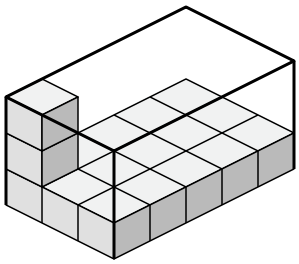

2)

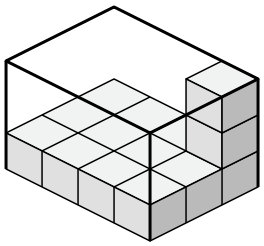

3)

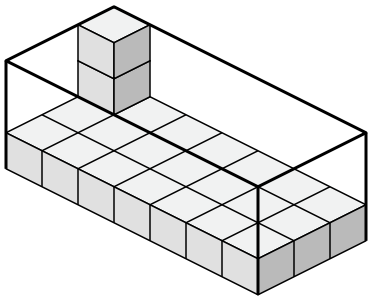

4)

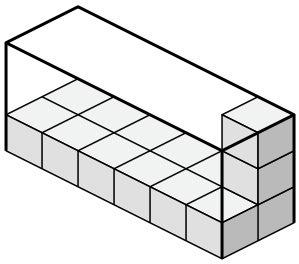

5)

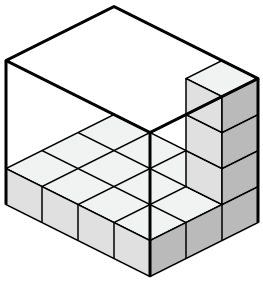

6)

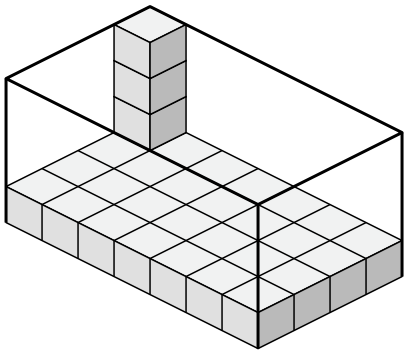

7)

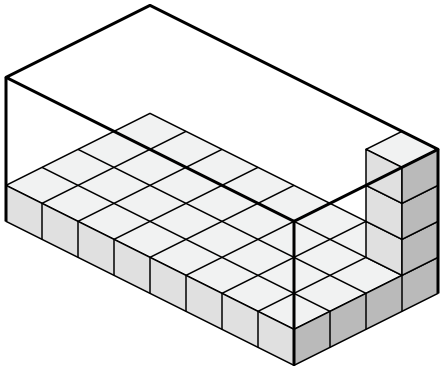

8)

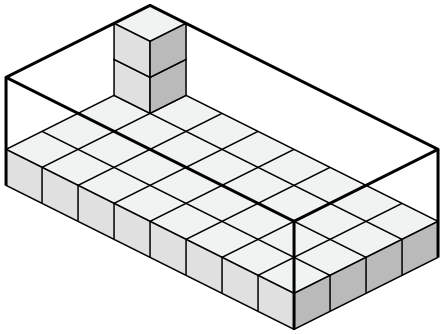

Risposte

1. **45 u^3**
2. **36 u^3**
3. **63 u^3**
4. **36 u^3**
5. **48 u^3**
6. **112 u^3**
7. **128 u^3**
8. **96 u^3**

1-8	88	75	63	50	38	25	13	0

Identificazione del volume di una scatola Nome:

Determina il volume di ciascuna scatola. Ogni blocco è 1 unità cubica (u 3).

1)

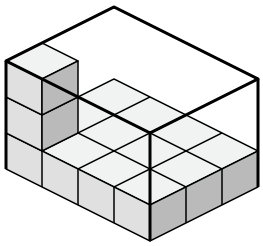

2)

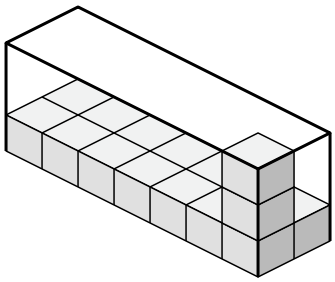

3)

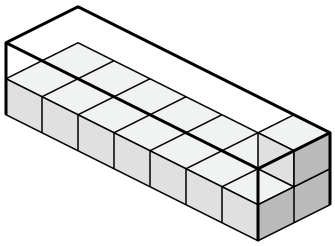

4)

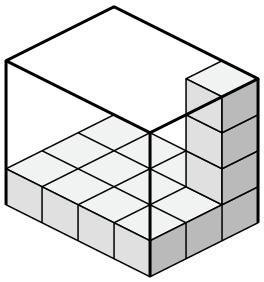

5)

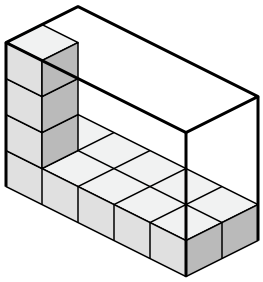

6)

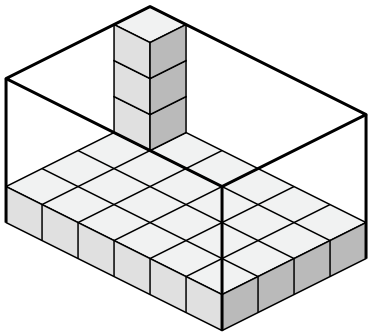

7)

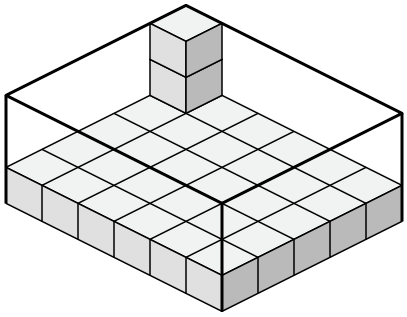

8)

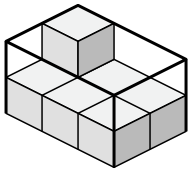

Risposte

1. _____
2. _____
3. _____
4. _____
5. _____
6. _____
7. _____
8. _____

1-8	88	75	63	50	38	25	13	0

Identificazione del volume di una scatola Nome: **Soluzioni**

Determina il volume di ciascuna scatola. Ogni blocco è 1 unità cubica (u 3).

1)

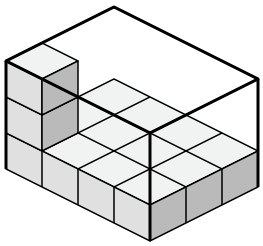

2)

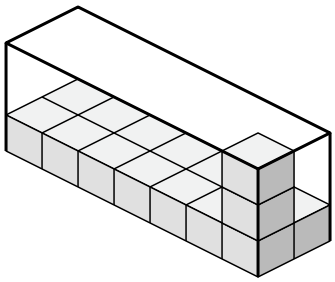

3)

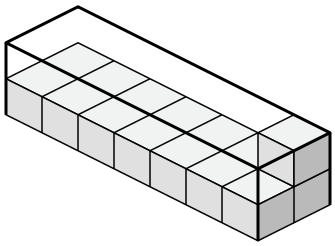

4)

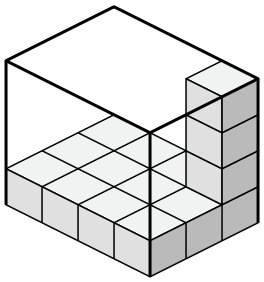

5)

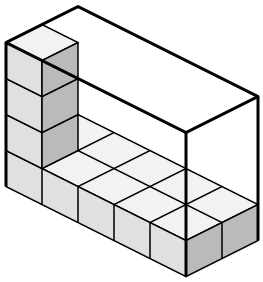

6)

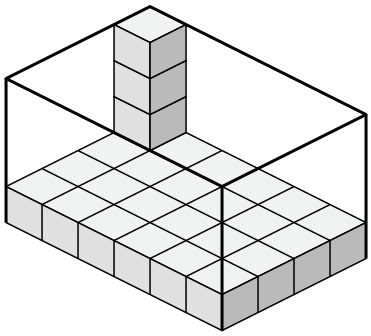

7)

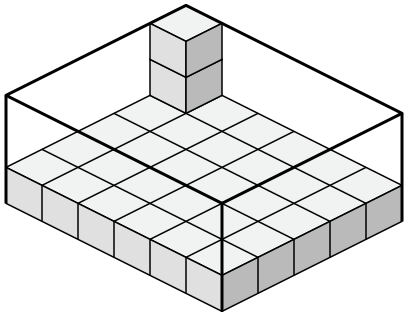

8)

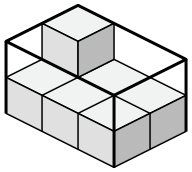

Risposte

1. **36 u^3**
2. **42 u^3**
3. **28 u^3**
4. **48 u^3**
5. **40 u^3**
6. **96 u^3**
7. **90 u^3**
8. **12 u^3**

1-8	88	75	63	50	38	25	13	0

Identificazione del volume di una scatola Nome:

Determina il volume di ciascuna scatola. Ogni blocco è 1 unità cubica (u 3).

1)

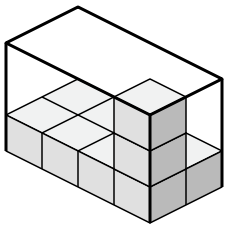

2)

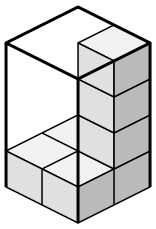

3)

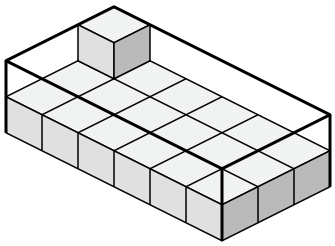

4)

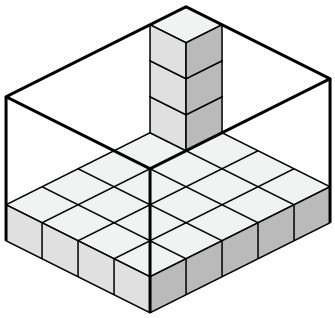

5)

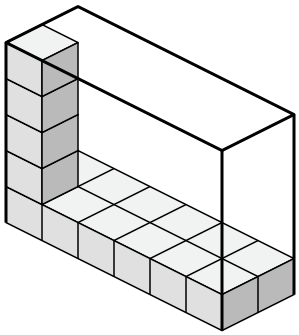

6)

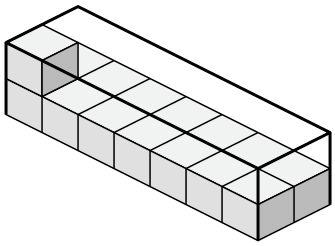

7)

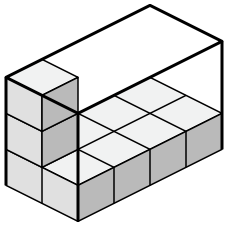

8)

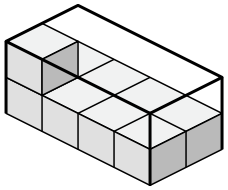

Risposte

1. _____
2. _____
3. _____
4. _____
5. _____
6. _____
7. _____
8. _____

1-8	88	75	63	50	38	25	13	0

Identificazione del volume di una scatola Nome: **Soluzioni**

Determina il volume di ciascuna scatola. Ogni blocco è 1 unità cubica (u 3).

1)

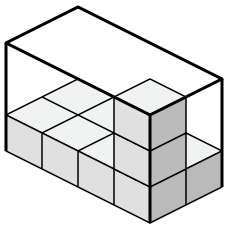

2)

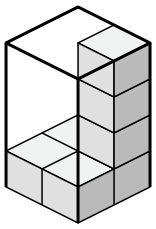

3)

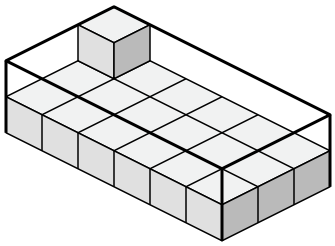

4)

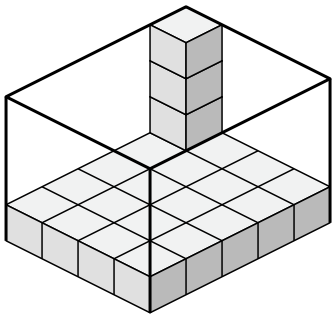

5)

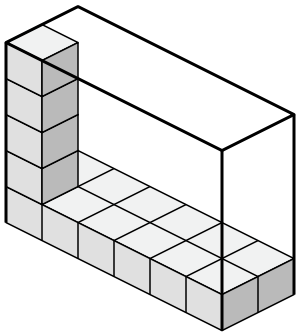

6)

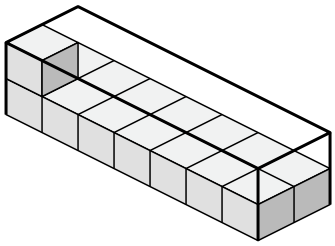

7)

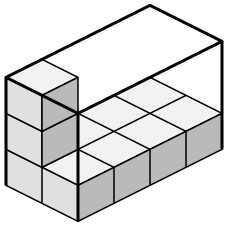

8)

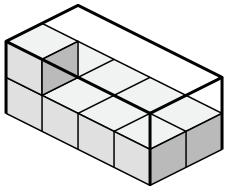

Risposte

1. **24 u^3**
2. **16 u^3**
3. **36 u^3**
4. **80 u^3**
5. **60 u^3**
6. **28 u^3**
7. **24 u^3**
8. **16 u^3**

1-8	88	75	63	50	38	25	13	0

Identificazione del volume di una scatola Nome:

Determina il volume di ciascuna scatola. Ogni blocco è 1 unità cubica (u 3).

1)

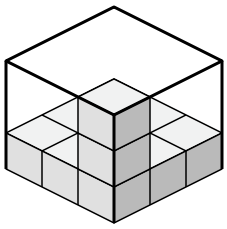

2)

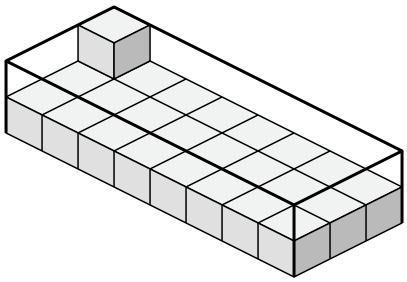

3)

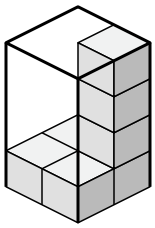

4)

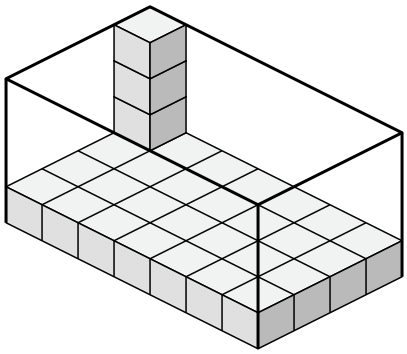

5)

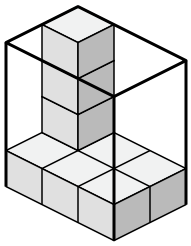

6)

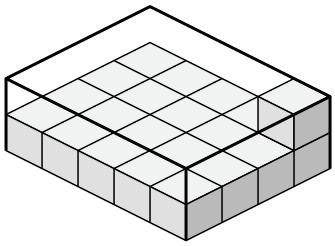

7)

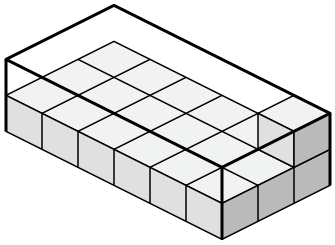

8)

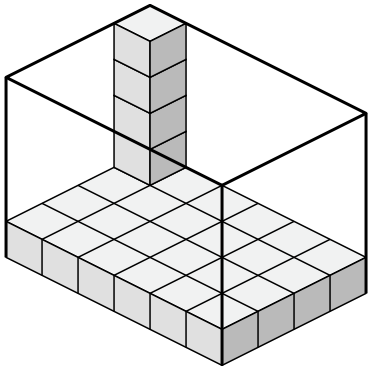

Risposte

1. _____
2. _____
3. _____
4. _____
5. _____
6. _____
7. _____
8. _____

1-8	88	75	63	50	38	25	13	0

Identificazione del volume di una scatola Nome: **Soluzioni**

Determina il volume di ciascuna scatola. Ogni blocco è 1 unità cubica (u 3).

1)

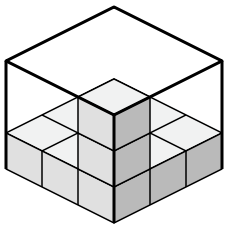

2)

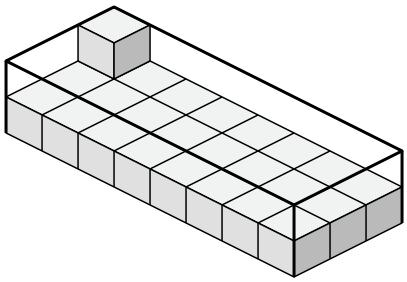

3)

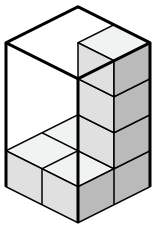

4)

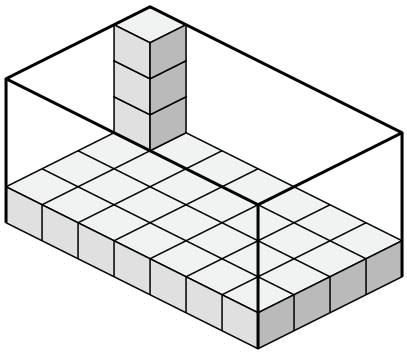

5)

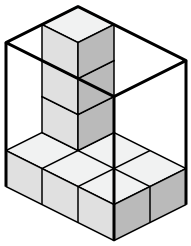

6)

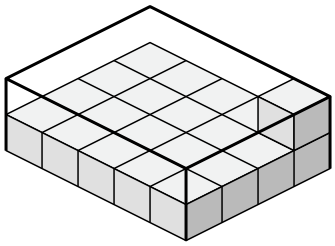

7)

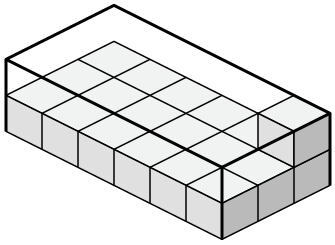

8)

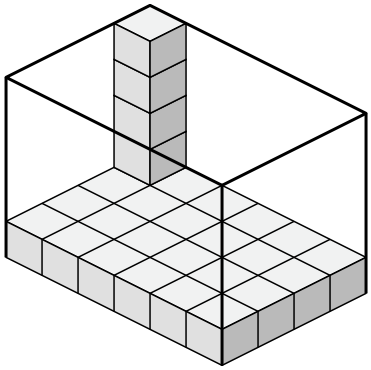

Risposte

1. **27 u^3**
2. **48 u^3**
3. **16 u^3**
4. **112 u^3**
5. **24 u^3**
6. **40 u^3**
7. **36 u^3**
8. **120 u^3**

1-8	88	75	63	50	38	25	13	0

Identificazione del volume di una scatola

Nome:

Determina il volume di ciascuna scatola. Ogni blocco è 1 unità cubica (u 3).

1)

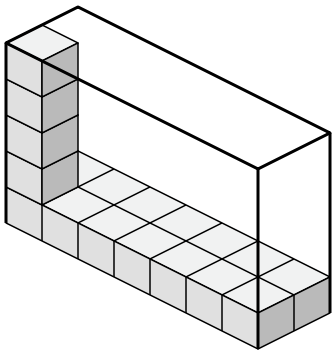

2)

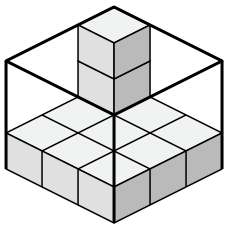

3)

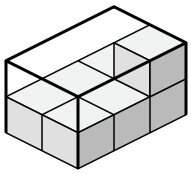

4)

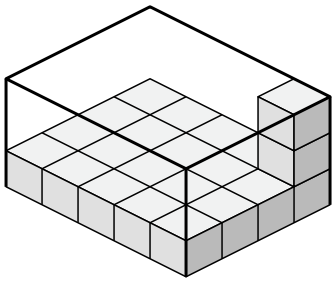

5)

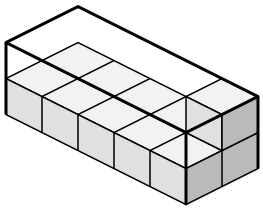

6)

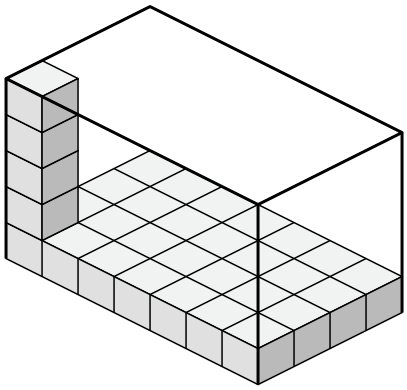

7)

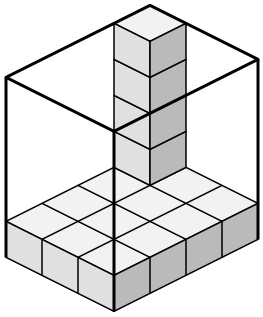

8)

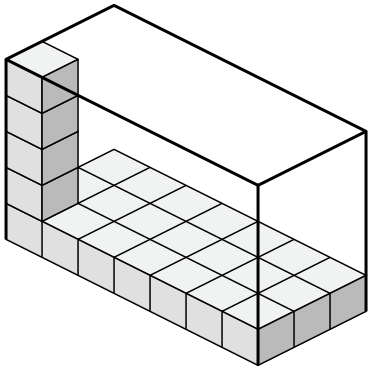

Risposte

1. _____
2. _____
3. _____
4. _____
5. _____
6. _____
7. _____
8. _____

1-8	88	75	63	50	38	25	13	0

Identificazione del volume di una scatola Nome: **Soluzioni**

Determina il volume di ciascuna scatola. Ogni blocco è 1 unità cubica (u 3).

1)

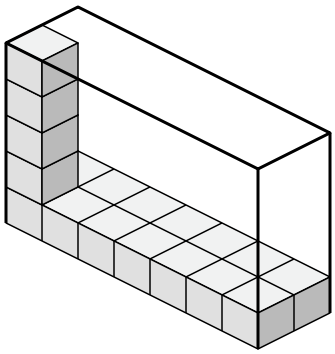

2)

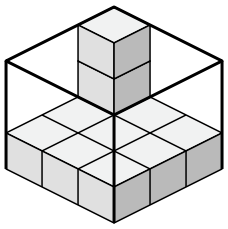

3)

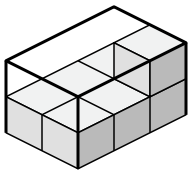

4)

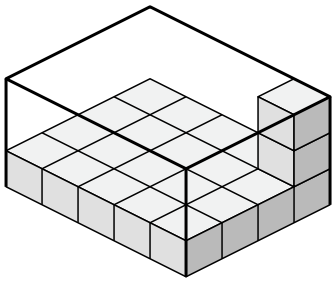

5)

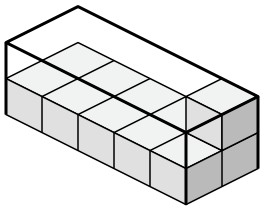

6)

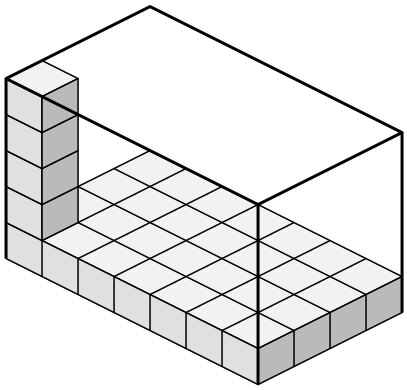

7)

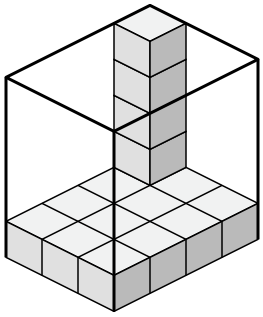

8)

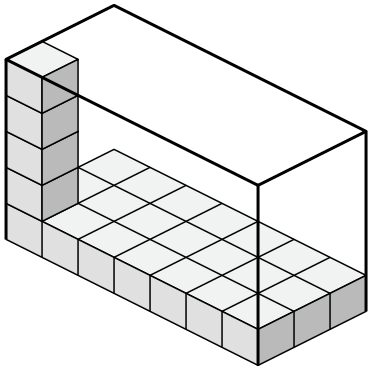

Risposte

1. **70 u^3**
2. **27 u^3**
3. **12 u^3**
4. **60 u^3**
5. **20 u^3**
6. **140 u^3**
7. **60 u^3**
8. **105 u^3**

1-8	88	75	63	50	38	25	13	0

Identificazione del volume di una scatola Nome:

Determina il volume di ciascuna scatola. Ogni blocco è 1 unità cubica (u 3).

1)

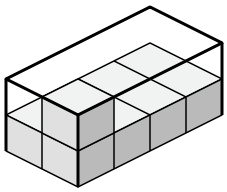

2)

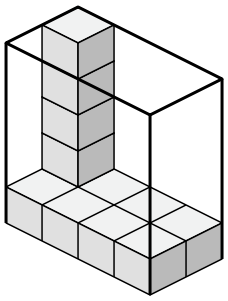

3)

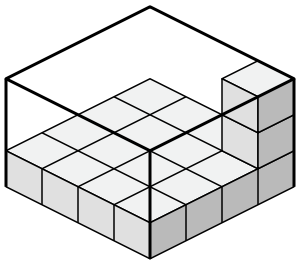

4)

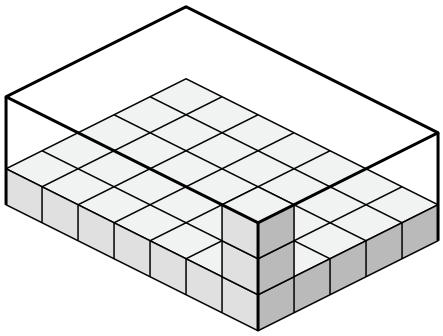

5)

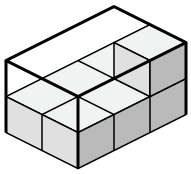

6)

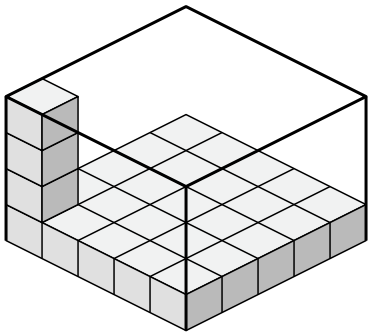

7)

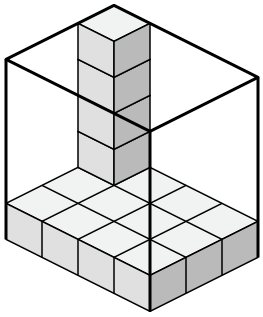

8)

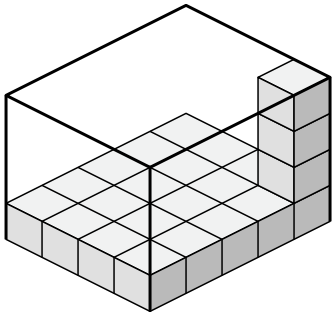

Risposte

1. _____
2. _____
3. _____
4. _____
5. _____
6. _____
7. _____
8. _____

1-8	88	75	63	50	38	25	13	0

Identificazione del volume di una scatola Nome: **Soluzioni**

Determina il volume di ciascuna scatola. Ogni blocco è 1 unità cubica (u 3).

1)

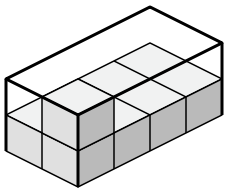

2)

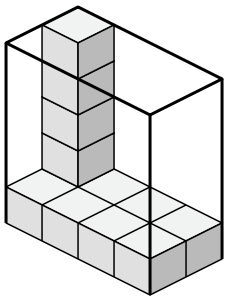

3)

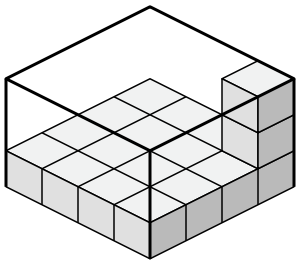

4)

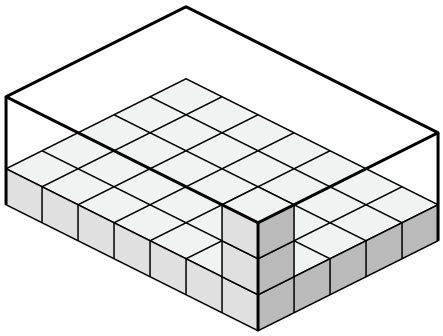

5)

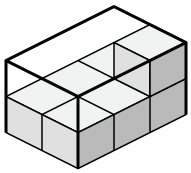

6)

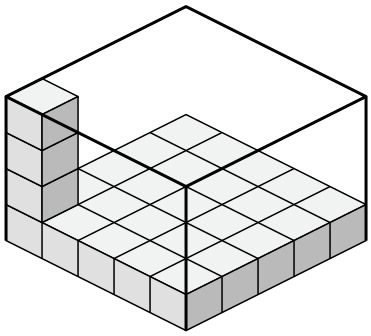

7)

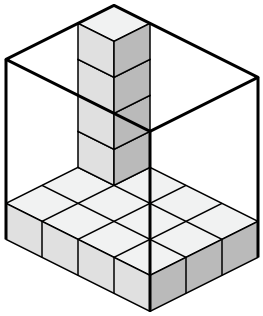

8)

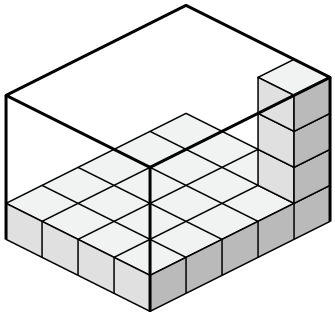

Risposte

1. **16 u^3**
2. **40 u^3**
3. **48 u^3**
4. **105 u^3**
5. **12 u^3**
6. **100 u^3**
7. **60 u^3**
8. **80 u^3**

1-8	88	75	63	50	38	25	13	0

Identificazione del volume di una scatola

Nome:

Determina il volume di ciascuna scatola. Ogni blocco è 1 unità cubica (u 3).

1)

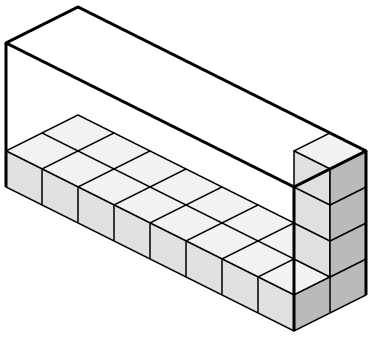

2)

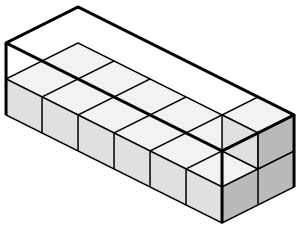

3)

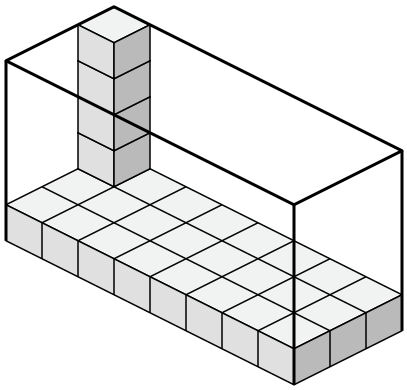

4)

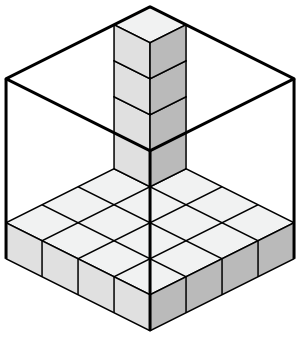

5)

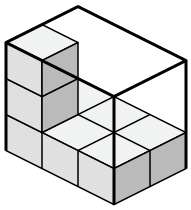

6)

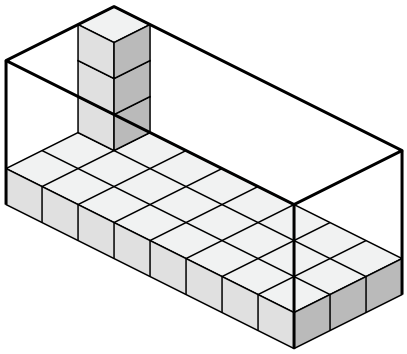

7)

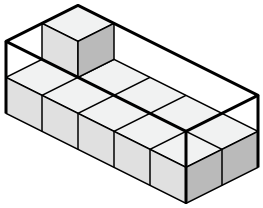

8)

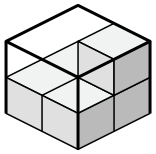

Risposte

1. _____
2. _____
3. _____
4. _____
5. _____
6. _____
7. _____
8. _____

1-8	88	75	63	50	38	25	13	0

Identificazione del volume di una scatola Nome: **Soluzioni**

Determina il volume di ciascuna scatola. Ogni blocco è 1 unità cubica (u 3).

1)

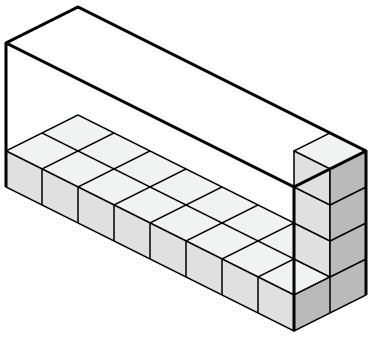

2)

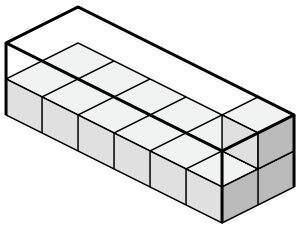

3)

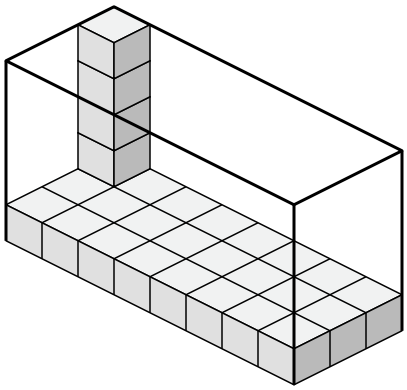

4)

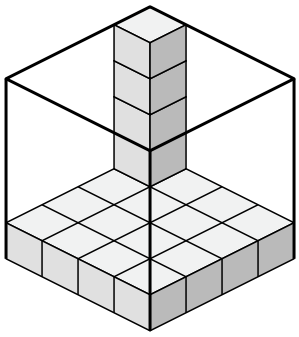

5)

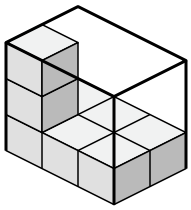

6)

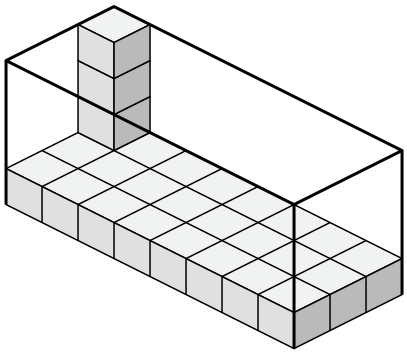

7)

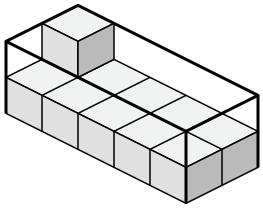

8)

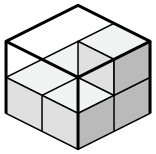

Risposte

1. **64 u^3**
2. **24 u^3**
3. **120 u^3**
4. **80 u^3**
5. **18 u^3**
6. **96 u^3**
7. **20 u^3**
8. **8 u^3**

1-8	88	75	63	50	38	25	13	0

Identificazione del volume di una scatola Nome:

Determina il volume di ciascuna scatola. Ogni blocco è 1 unità cubica (u 3).

1)

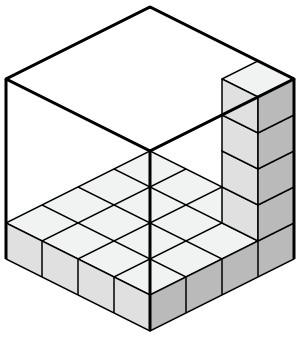

2)

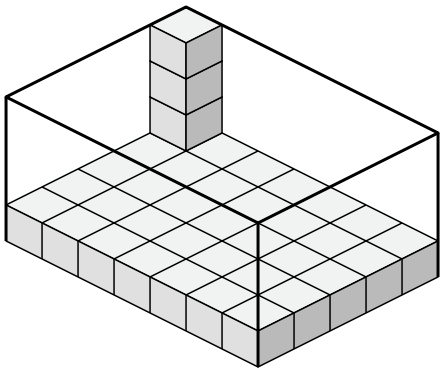

3)

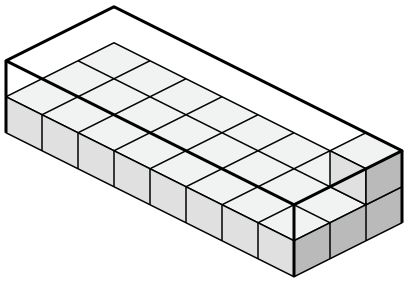

4)

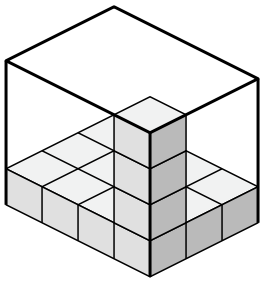

5)

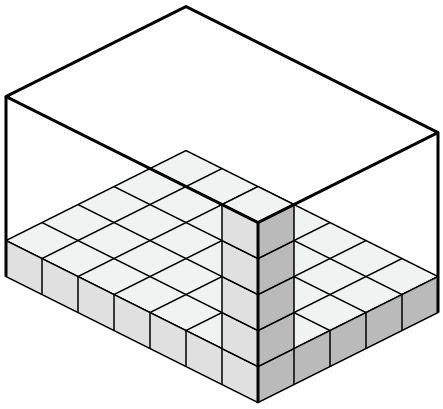

6)

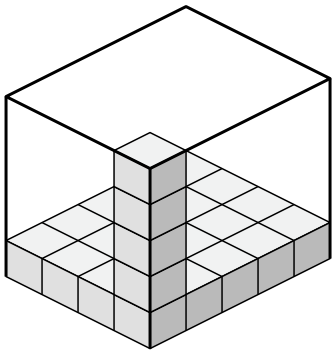

7)

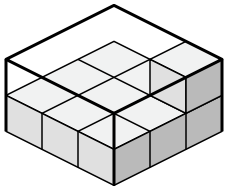

8)

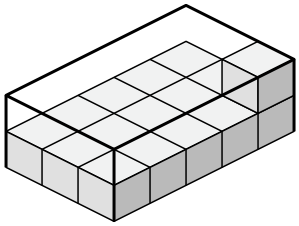

Risposte

1. _____
2. _____
3. _____
4. _____
5. _____
6. _____
7. _____
8. _____

1-8	88	75	63	50	38	25	13	0

Identificazione del volume di una scatola Nome: **Soluzioni**

Determina il volume di ciascuna scatola. Ogni blocco è 1 unità cubica (u 3).

1)

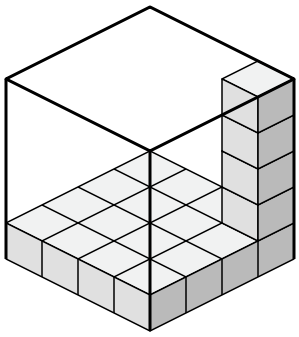

2)

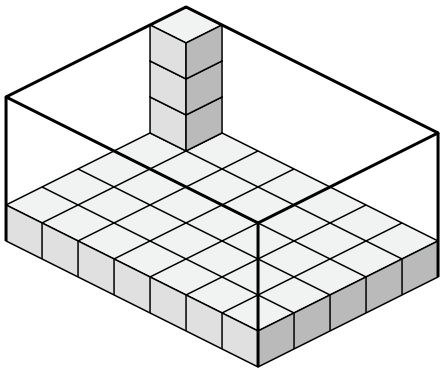

3)

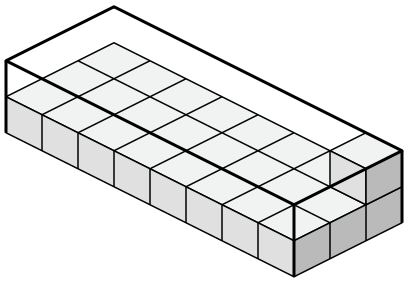

4)

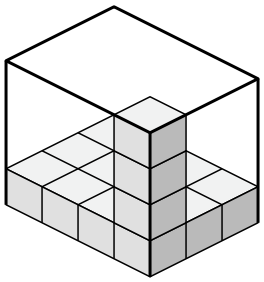

5)

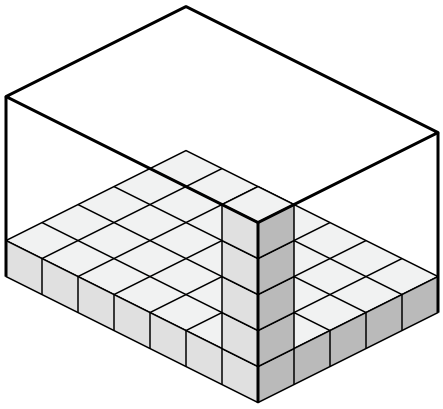

6)

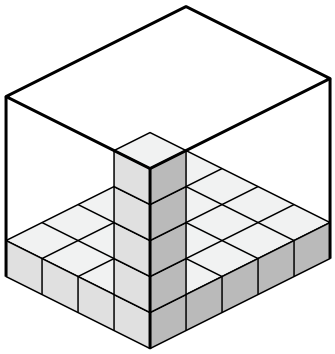

7)

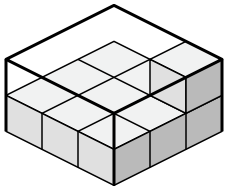

8)

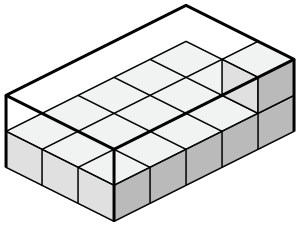

Risposte

1. **80 u^3**
2. **140 u^3**
3. **48 u^3**
4. **48 u^3**
5. **175 u^3**
6. **100 u^3**
7. **18 u^3**
8. **30 u^3**

1-8	88	75	63	50	38	25	13	0

Identificazione del volume di una scatola Nome:

Determina il volume di ciascuna scatola. Ogni blocco è 1 unità cubica (u 3).

1)

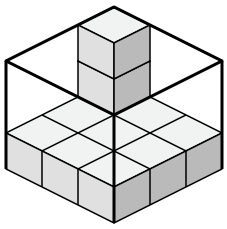

2)

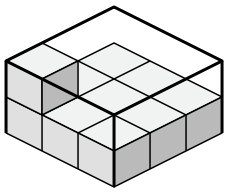

3)

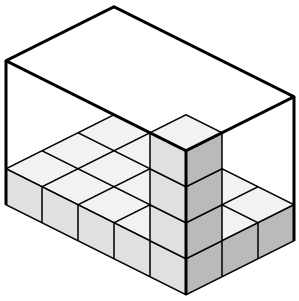

4)

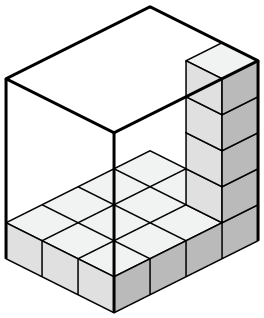

5)

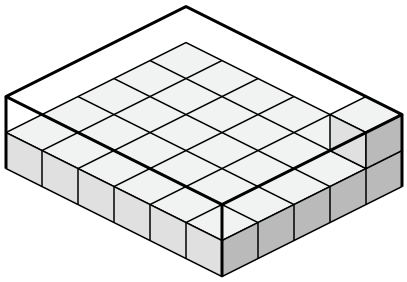

6)

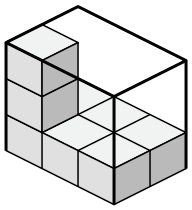

7)

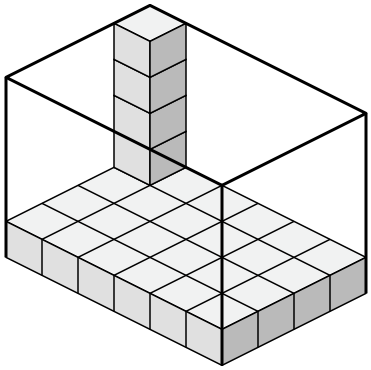

8)

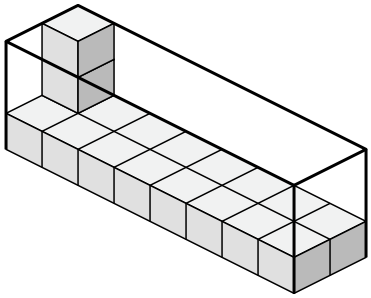

Risposte

1. _____
2. _____
3. _____
4. _____
5. _____
6. _____
7. _____
8. _____

1-8	88	75	63	50	38	25	13	0

Identificazione del volume di una scatola Nome: **Soluzioni**

Determina il volume di ciascuna scatola. Ogni blocco è 1 unità cubica (u 3).

1)

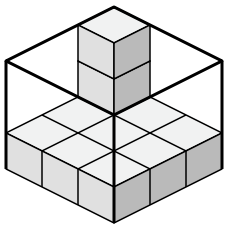

2)

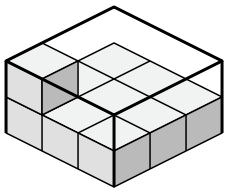

3)

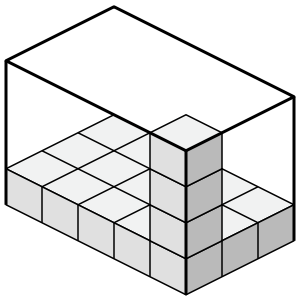

4)

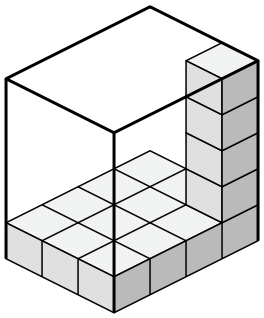

5)

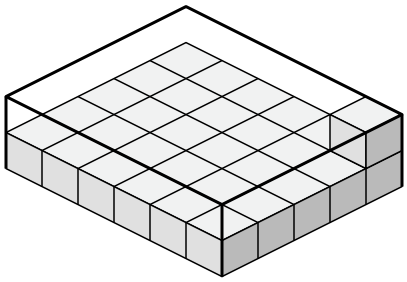

6)

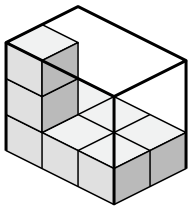

7)

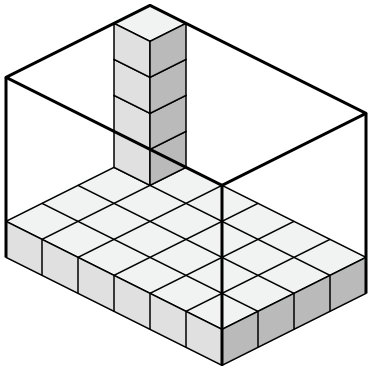

8)

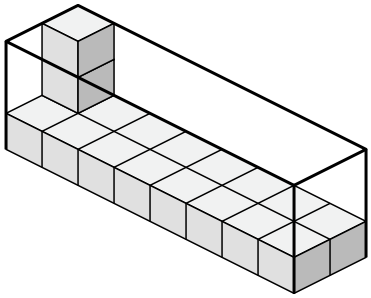

Risposte

1. **27 u^3**
2. **18 u^3**
3. **60 u^3**
4. **60 u^3**
5. **60 u^3**
6. **18 u^3**
7. **120 u^3**
8. **48 u^3**

1-8	88	75	63	50	38	25	13	0

Identificazione del volume di una scatola

Nome:

Determina il volume di ciascuna scatola. Ogni blocco è 1 unità cubica (u 3).

1)

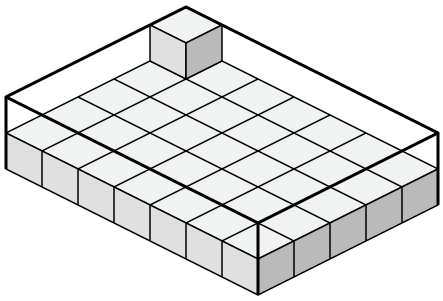

2)

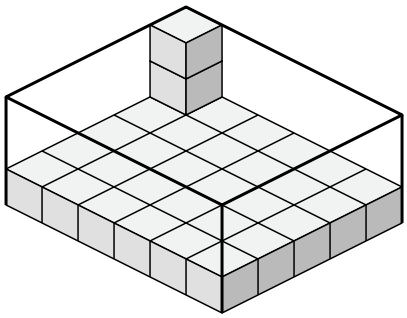

3)

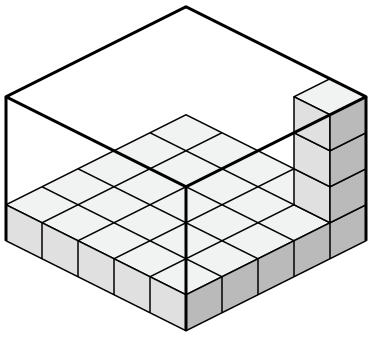

4)

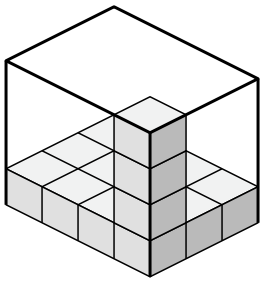

5)

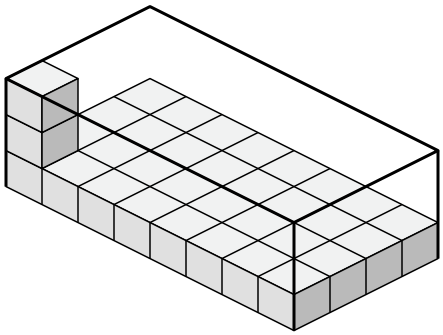

6)

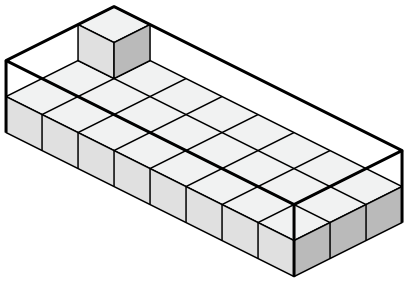

7)

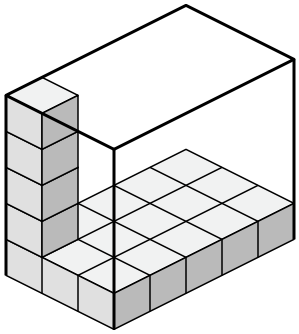

8)

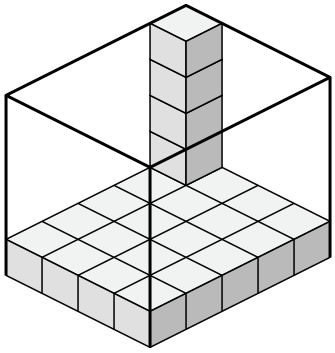

Risposte

1. _____
2. _____
3. _____
4. _____
5. _____
6. _____
7. _____
8. _____

1-8	88	75	63	50	38	25	13	0

Identificazione del volume di una scatola Nome: **Soluzioni**

Determina il volume di ciascuna scatola. Ogni blocco è 1 unità cubica (u 3).

1)

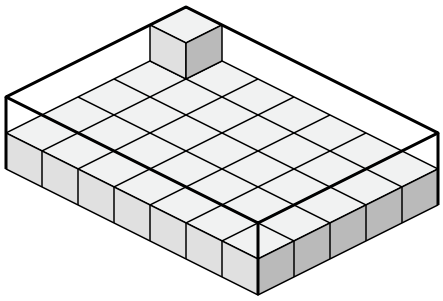

2)

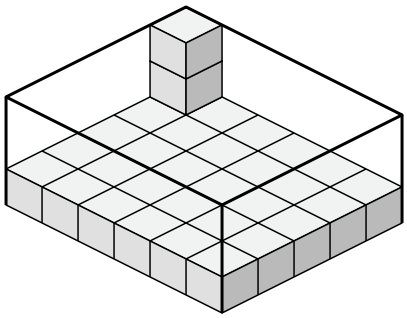

3)

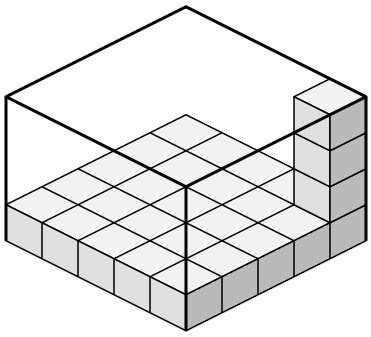

4)

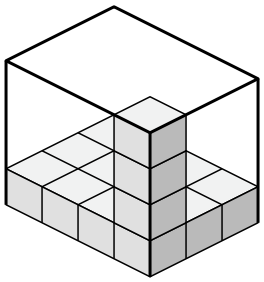

5)

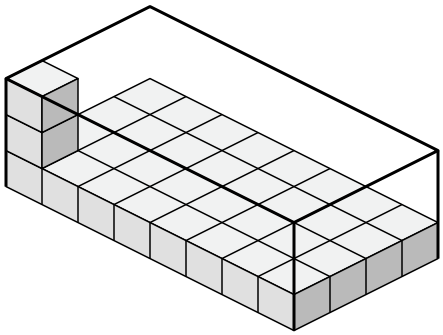

6)

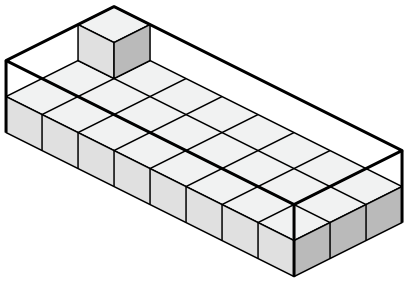

7)

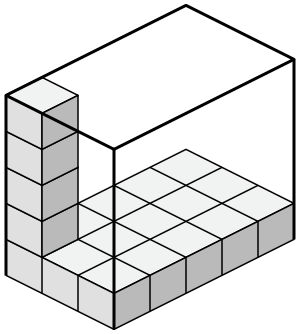

8)

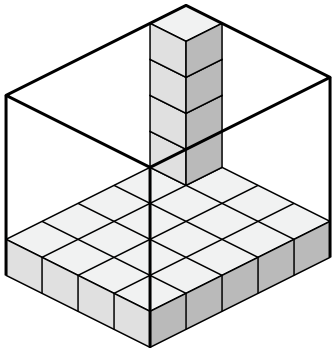

Risposte

1. **70 u^3**
2. **90 u^3**
3. **100 u^3**
4. **48 u^3**
5. **96 u^3**
6. **48 u^3**
7. **75 u^3**
8. **100 u^3**

1-8	88	75	63	50	38	25	13	0