Trovare l'angolo mancante

Nome:

Calcola il valore di 'A'.

1)

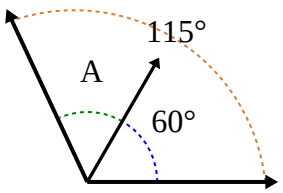

2)

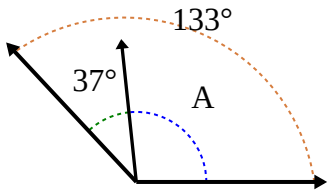

3)

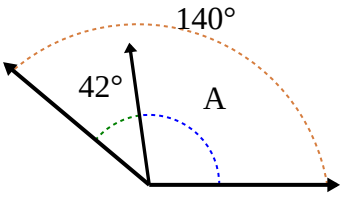

4)

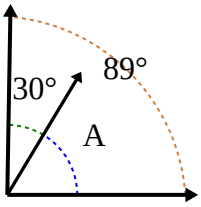

5)

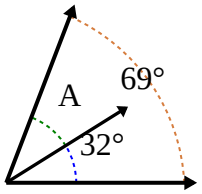

6)

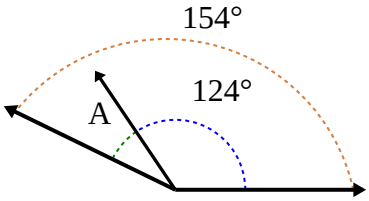

7)

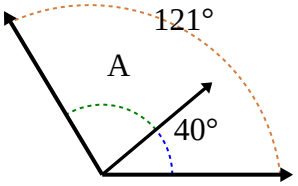

8)

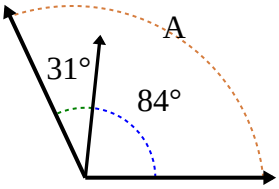

9)

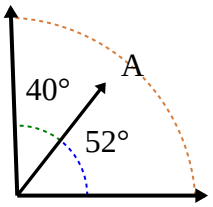

10)

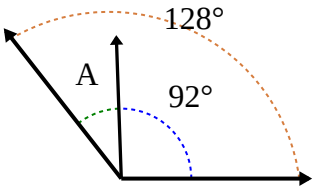

11)

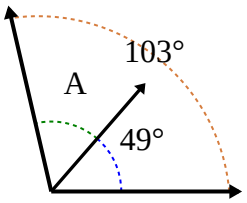

12)

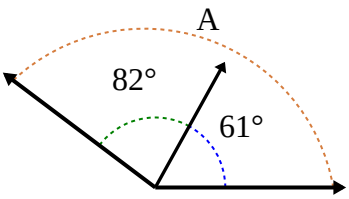

Risposte

1. _____
2. _____
3. _____
4. _____
5. _____
6. _____
7. _____
8. _____
9. _____
10. _____
11. _____
12. _____

1-10	92	83	75	67	58	50	42	33	25	17
11-12	8	0								

Trovare l'angolo mancante

Nome: **Soluzioni**

Calcola il valore di 'A'.

1)

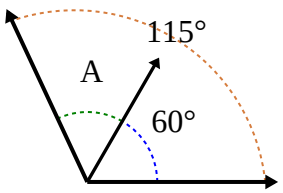

2)

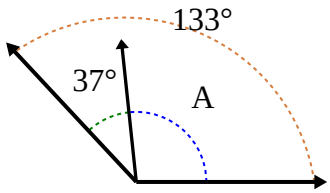

3)

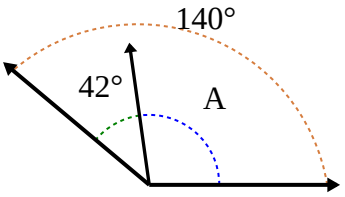

4)

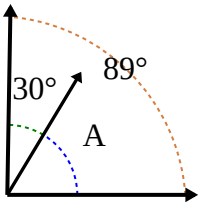

5)

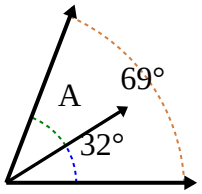

6)

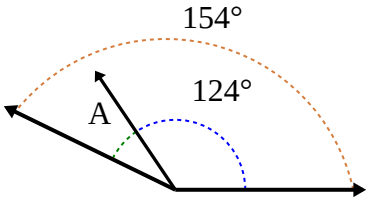

7)

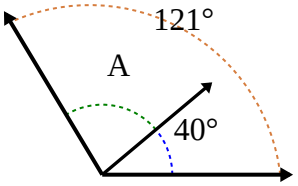

8)

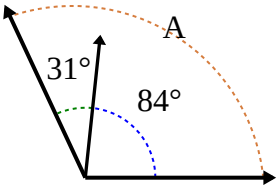

9)

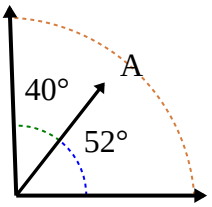

10)

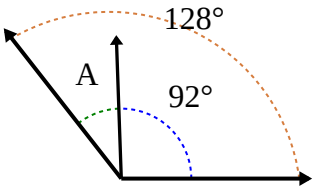

11)

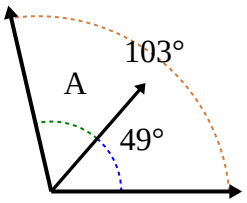

12)

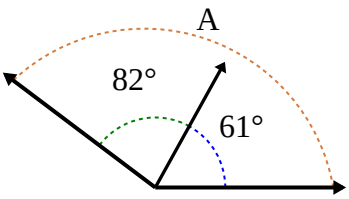

Risposte

1. **55**
2. **96**
3. **98**
4. **59**
5. **37**
6. **30**
7. **81**
8. **115**
9. **92**
10. **36**
11. **54**
12. **143**

1-10	92	83	75	67	58	50	42	33	25	17
11-12	8	0								