Trovare l'angolo mancante

Nome:

Calcola il valore di 'A'.

1)

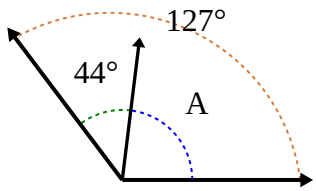

2)

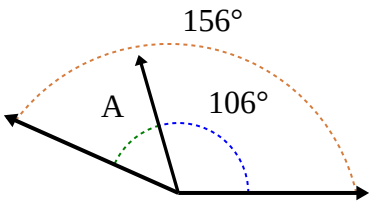

3)

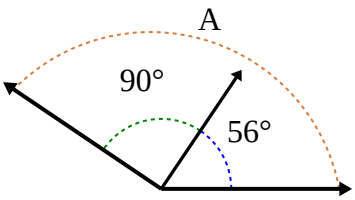

4)

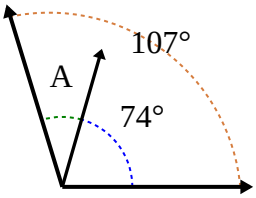

5)

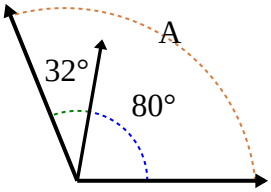

6)

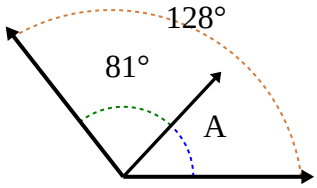

7)

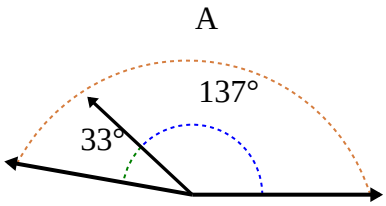

8)

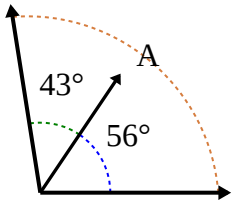

9)

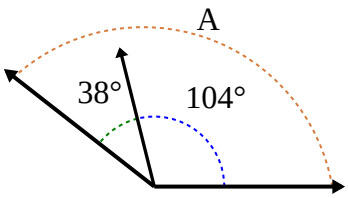

10)

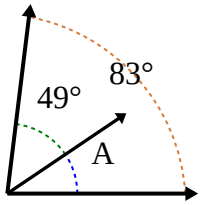

11)

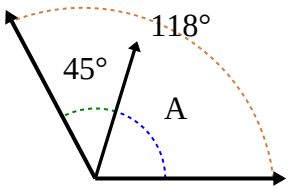

12)

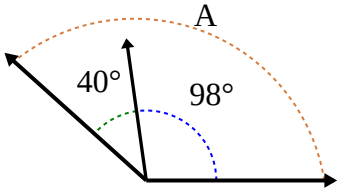

Risposte

1. _____
2. _____
3. _____
4. _____
5. _____
6. _____
7. _____
8. _____
9. _____
10. _____
11. _____
12. _____

1-10	92	83	75	67	58	50	42	33	25	17
11-12	8	0								

Trovare l'angolo mancante Nome: **Soluzioni**

Calcola il valore di 'A'.

1)

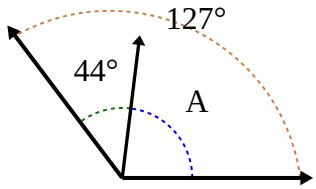

2)

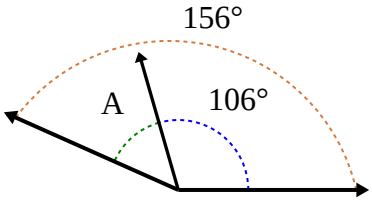

3)

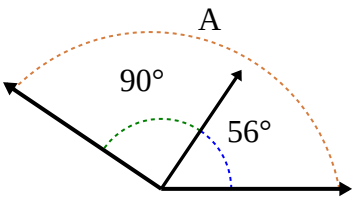

4)

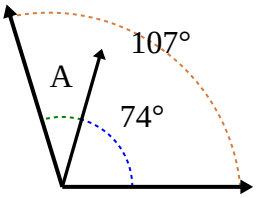

5)

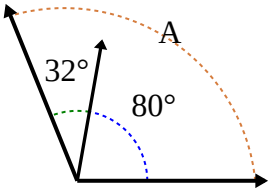

6)

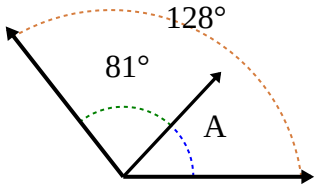

7)

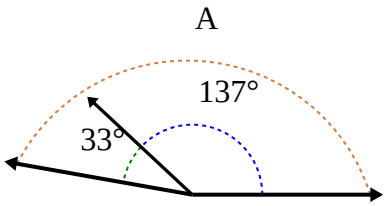

8)

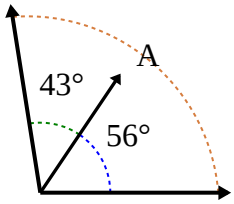

9)

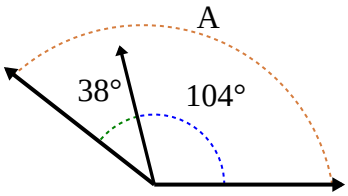

10)

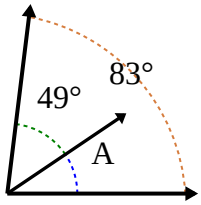

11)

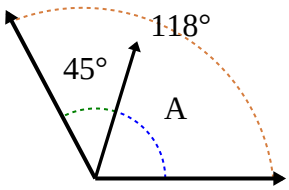

12)

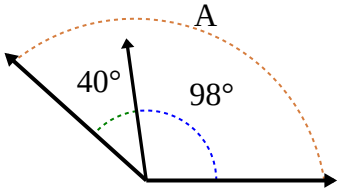

Risposte

1. **83**
2. **50**
3. **146**
4. **33**
5. **112**
6. **47**
7. **170**
8. **99**
9. **142**
10. **34**
11. **73**
12. **138**

1-10	92	83	75	67	58	50	42	33	25	17
11-12	8	0								