Esprimere le frazioni numericamente

Nome:

Scrivi la quantità ombreggiata come frazione.

1) 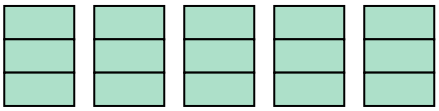

2) 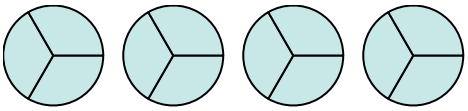

3) 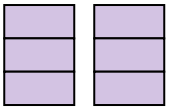

4) 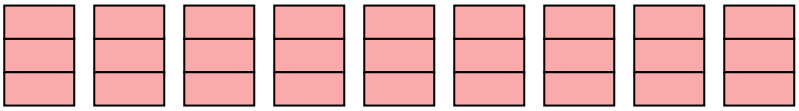

5) 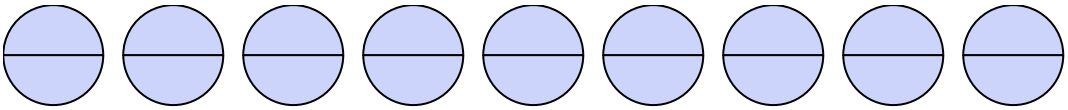

6) 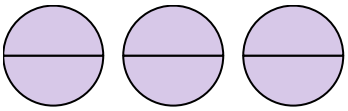

7) 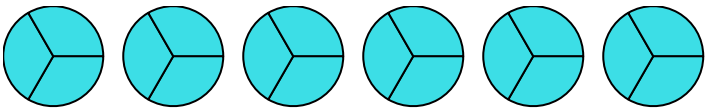

8) 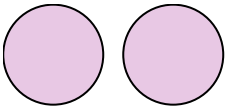

9) 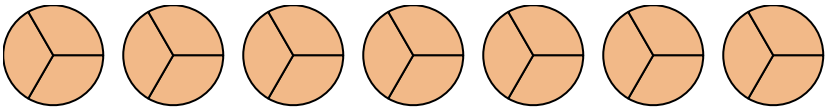

10) 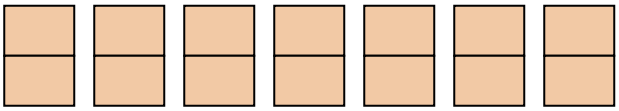

11) 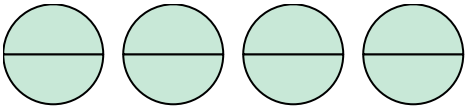

12) 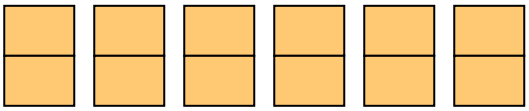

13) 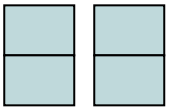

14) 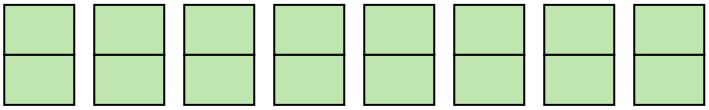

Risposte

1. _____
2. _____
3. _____
4. _____
5. _____
6. _____
7. _____
8. _____
9. _____
10. _____
11. _____
12. _____
13. _____
14. _____

1-10	93	86	79	71	64	57	50	43	36	29
11-14	21	14	7	0						

Esprimere le frazioni numericamente

Nome: **Soluzioni**

Scrivi la quantità ombreggiata come frazione.

1) 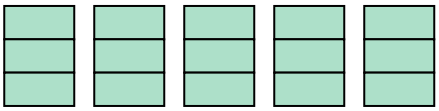

2) 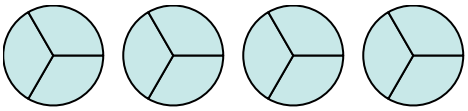

3) 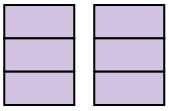

4) 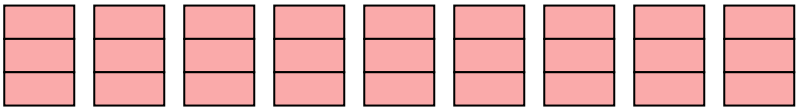

5) 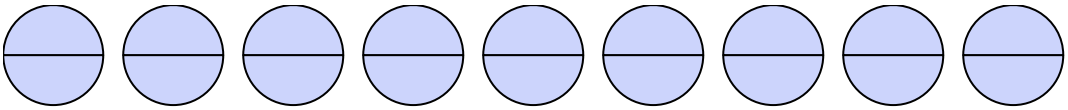

6) 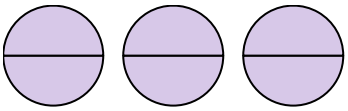

7) 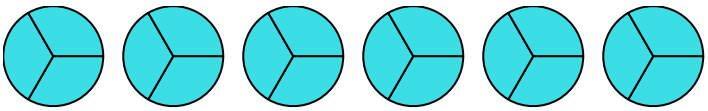

8) 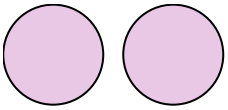

9) 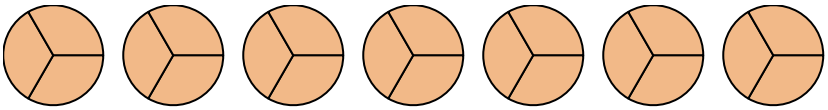

10) 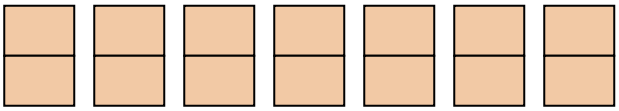

11) 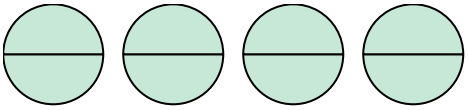

12) 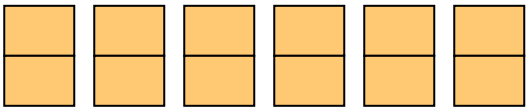

13) 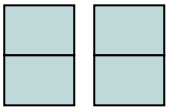

14) 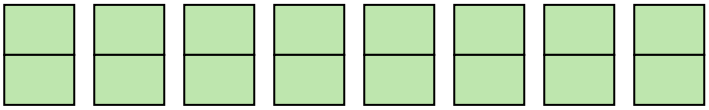

Risposte

1. $^{15}/_{3}$
2. $^{12}/_{3}$
3. $^{6}/_{3}$
4. $^{27}/_{3}$
5. $^{18}/_{2}$
6. $^{6}/_{2}$
7. $^{18}/_{3}$
8. $^{2}/_{1}$
9. $^{21}/_{3}$
10. $^{14}/_{2}$
11. $^{8}/_{2}$
12. $^{12}/_{2}$
13. $^{4}/_{2}$
14. $^{16}/_{2}$

1-10	93	86	79	71	64	57	50	43	36	29
11-14	21	14	7	0						