Determina la simmetria

Nome:

Determina se la linea che attraversa ogni figura è un linea di simmetria.

Es)

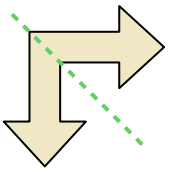

1)

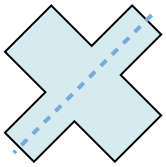

2)

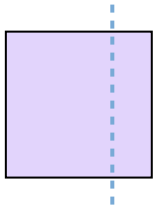

3)

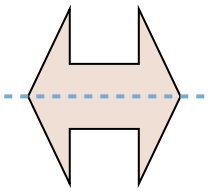

4)

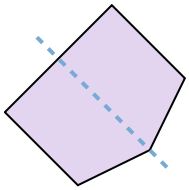

5)

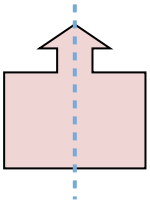

6)

7)

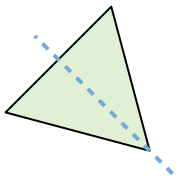

8)

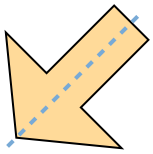

9)

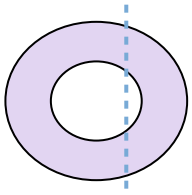

10)

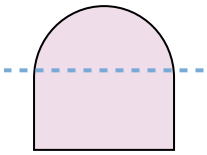

11)

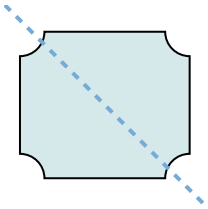

Risposte

Es. si

1. _____
2. _____
3. _____
4. _____
5. _____
6. _____
7. _____
8. _____
9. _____
10. _____
11. _____

1-10	91	82	73	64	55	45	36	27	18	9
11	0									

Determina se la linea che attraversa ogni figura è un linea di simmetria.

Es)

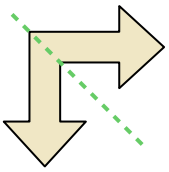

1)

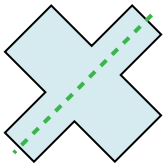

2)

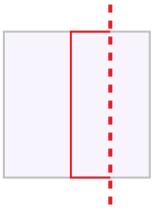

3)

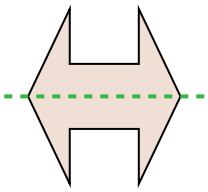

4)

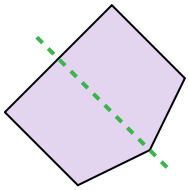

5)

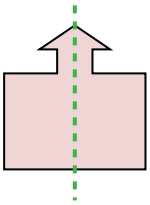

6)

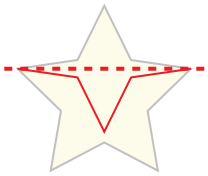

7)

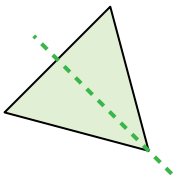

8)

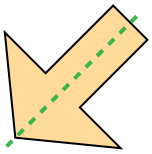

9)

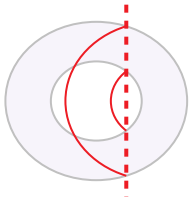

10)

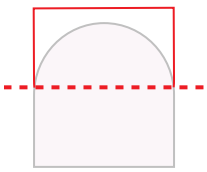

11)

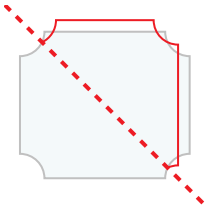

Risposte

Es.	si
1.	si
2.	no
3.	si
4.	si
5.	si
6.	no
7.	si
8.	si
9.	no
10.	no
11.	no

1-10	91	82	73	64	55	45	36	27	18	9
11	0									