Determina quale regola viene usata nelle seguenti funzioni.

Es)

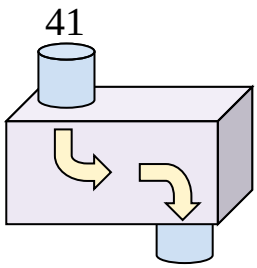

Sottrai 29

1)

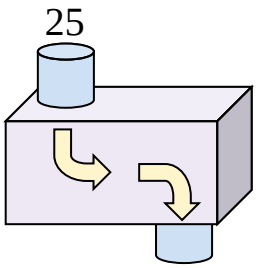

2)

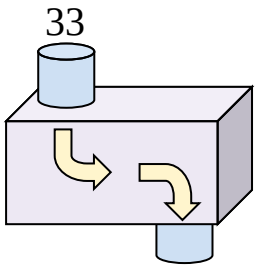

3)

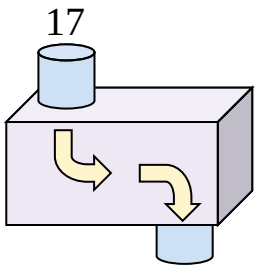

4)

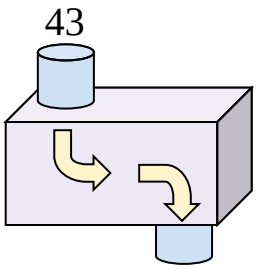

5)

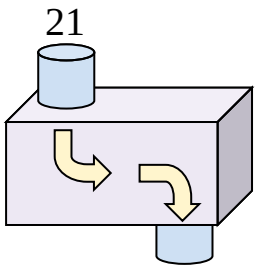

6)

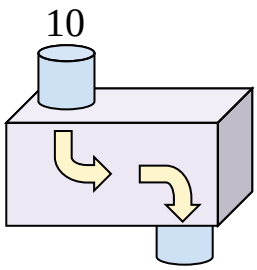

7)

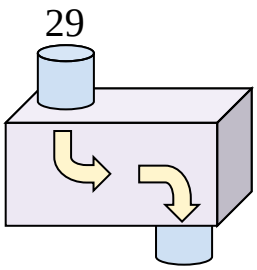

8)

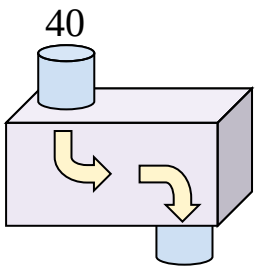

9)

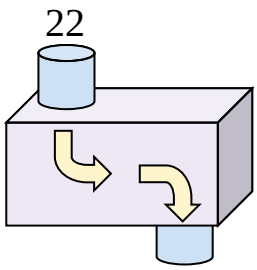

10)

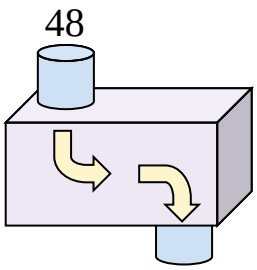

11)

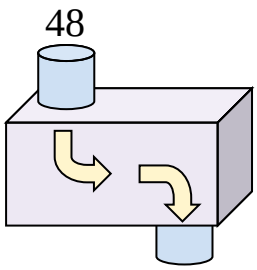

Risposte

Es. Sottrai 29

1. _____
2. _____
3. _____
4. _____
5. _____
6. _____
7. _____
8. _____
9. _____
10. _____
11. _____

1-10	91	82	73	64	55	45	36	27	18	9
11	0									

Determina quale regola viene usata nelle seguenti funzioni.

Es)

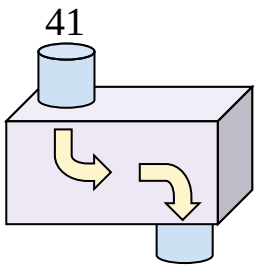

Sottrai 29

1)

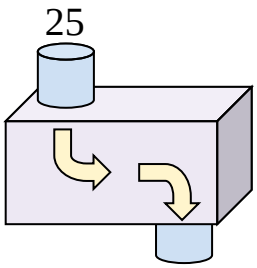

Aggiungi 12

2)

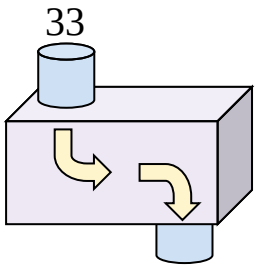

Sottrai 7

3)

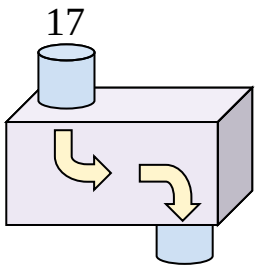

Aggiungi 20

4)

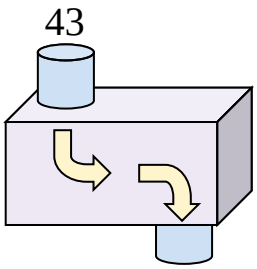

Sottrai 17

5)

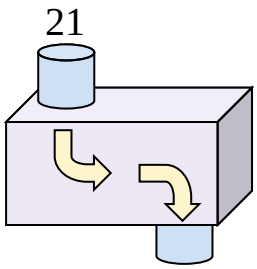

Aggiungi 26

6)

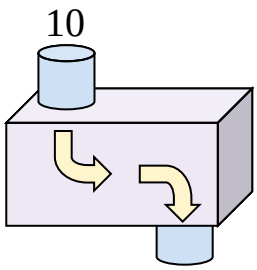

Aggiungi 32

7)

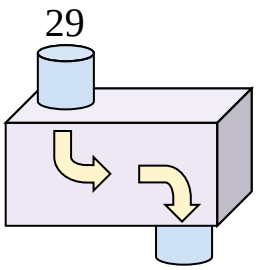

Aggiungi 17

8)

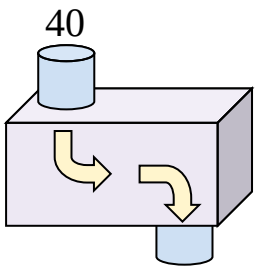

Sottrai 25

9)

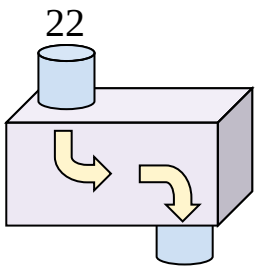

Aggiungi 27

10)

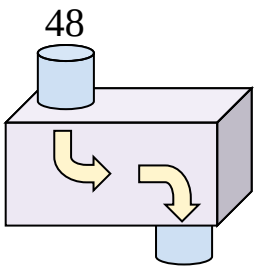

Sottrai 33

11)

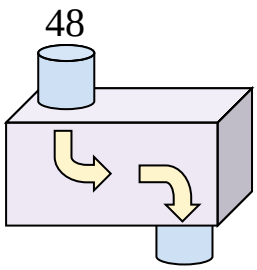

Sottrai 33

Risposte

Es. Sottrai 29
1. Aggiungi 12
2. Sottrai 7
3. Aggiungi 20
4. Sottrai 17
5. Aggiungi 26
6. Aggiungi 32
7. Aggiungi 17
8. Sottrai 25
9. Aggiungi 27
10. Sottrai 33
11. Sottrai 33

1-10	91	82	73	64	55	45	36	27	18	9
11	0									