**Determina quale regola viene usata nelle seguenti funzioni.**

**Es)**

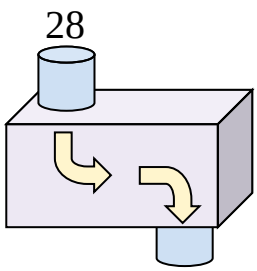


Aggiungi 18

**1)**

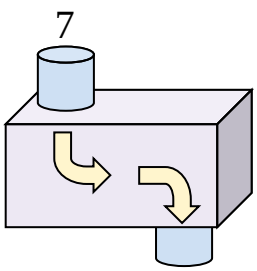


**2)**

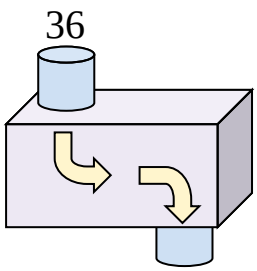


**3)**

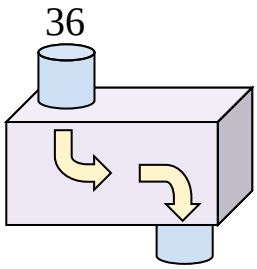


**4)**

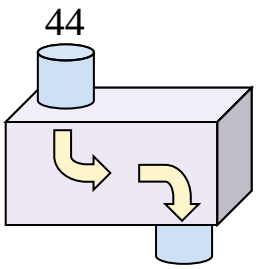


**5)**

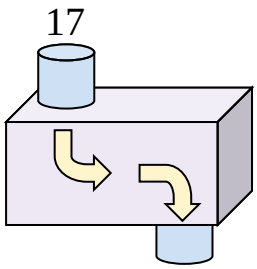


**6)**

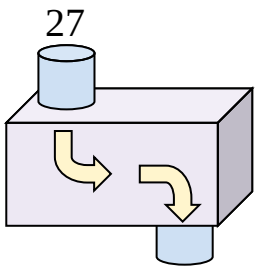


**7)**

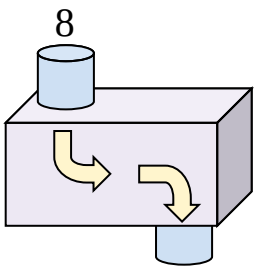


**8)**

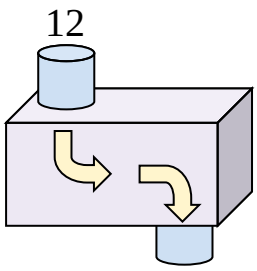


**9)**

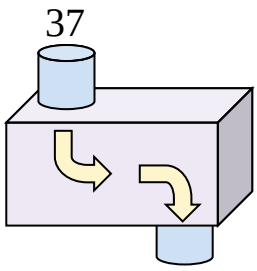


**10)**

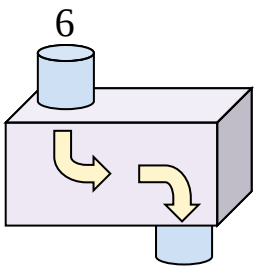


**11)**

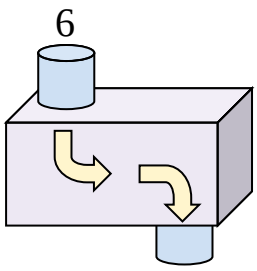


## Risposte

Es. Aggiungi 18

1. _____
2. _____
3. _____
4. _____
5. _____
6. _____
7. _____
8. _____
9. _____
10. _____
11. _____



| | | | | | | | | | | |
|---|---|---|---|---|---|---|---|---|---|---|
| 1-10 | 91 | 82 | 73 | 64 | 55 | 45 | 36 | 27 | 18 | 9 |
| 11 | 0 | | | | | | | | | |

**Determina quale regola viene usata nelle seguenti funzioni.**

**Es)**

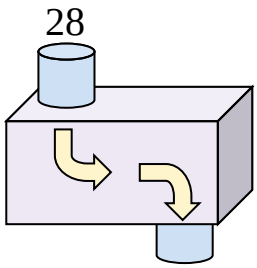


Aggiungi 18

**1)**

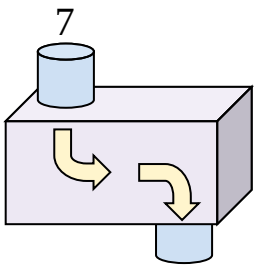


Aggiungi 8

**2)**

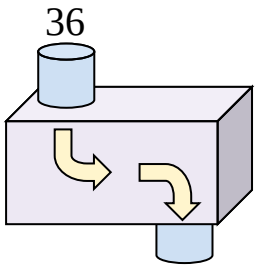


Sottrai 11

**3)**

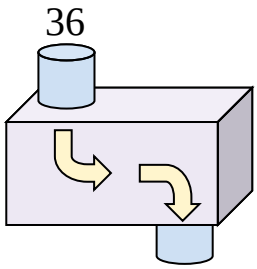


Sottrai 16

**4)**

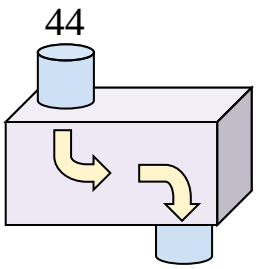


Sottrai 24

**5)**

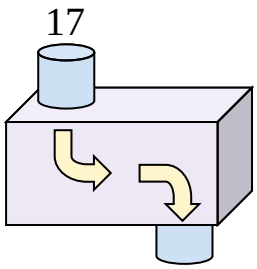


Aggiungi 24

**6)**

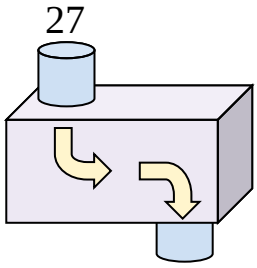


Sottrai 21

**7)**

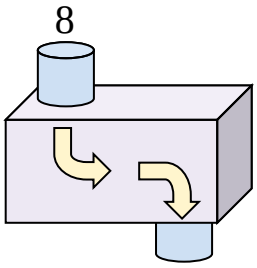


Aggiungi 36

**8)**

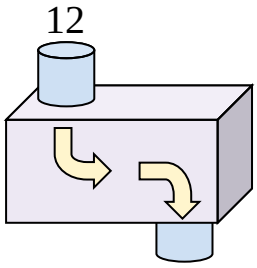


Aggiungi 9

**9)**

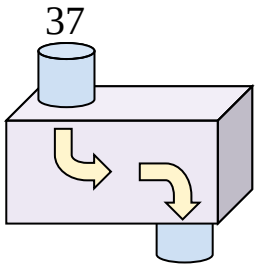


Sottrai 20

**10)**

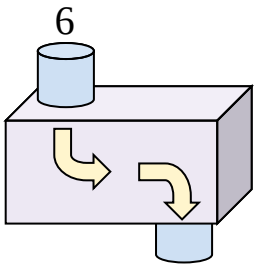


Aggiungi 13

**11)**

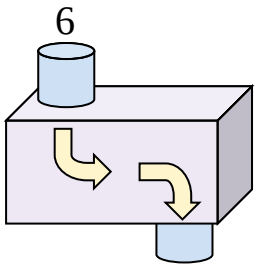


Aggiungi 13

## Risposte

Es. Aggiungi 18
1. Aggiungi 8
2. Sottrai 11
3. Sottrai 16
4. Sottrai 24
5. Aggiungi 24
6. Sottrai 21
7. Aggiungi 36
8. Aggiungi 9
9. Sottrai 20
10. Aggiungi 13
11. Aggiungi 13



| | | | | | | | | | | |
|---|---|---|---|---|---|---|---|---|---|---|
| 1-10 | 91 | 82 | 73 | 64 | 55 | 45 | 36 | 27 | 18 | 9 |
| 11 | 0 | | | | | | | | | |