Determina quale regola viene usata nelle seguenti funzioni.

Es)

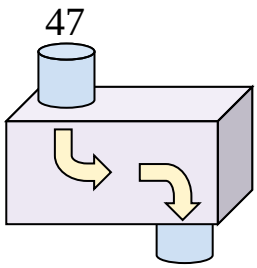

Sottrai 17

1)

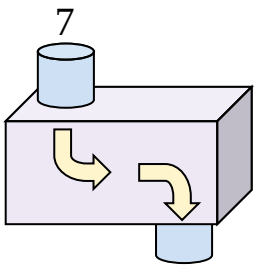

2)

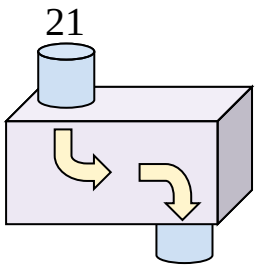

3)

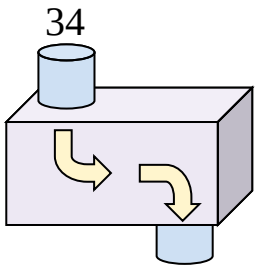

4)

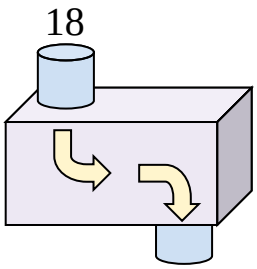

5)

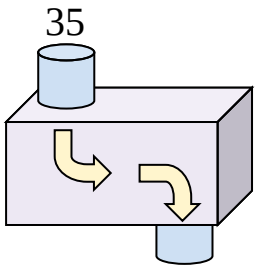

6)

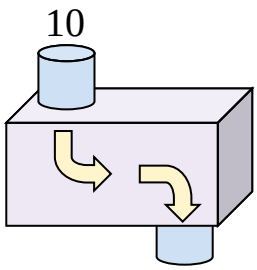

7)

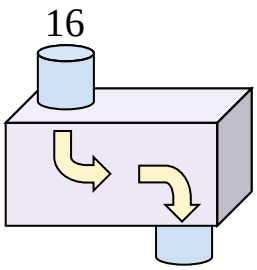

8)

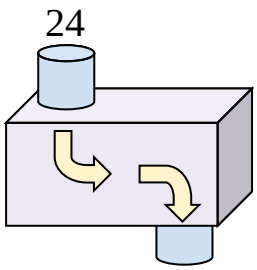

9)

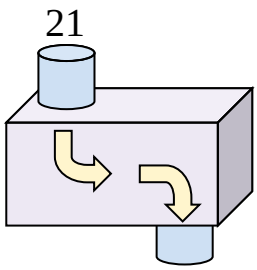

10)

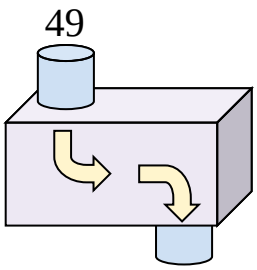

11)

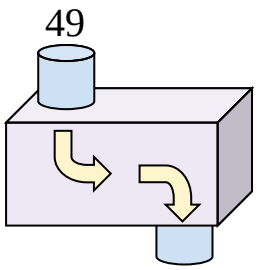

Risposte

Es. Sottrai 17

1. _____
2. _____
3. _____
4. _____
5. _____
6. _____
7. _____
8. _____
9. _____
10. _____
11. _____

1-10	91	82	73	64	55	45	36	27	18	9
11	0									

Determina quale regola viene usata nelle seguenti funzioni.

Es)

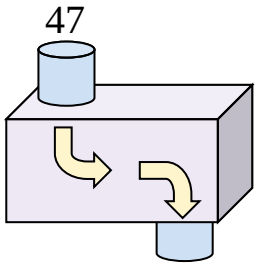

Sottrai 17

1)

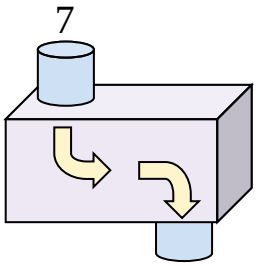

Aggiungi 20

2)

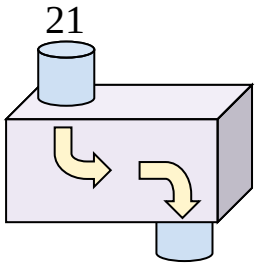

Aggiungi 15

3)

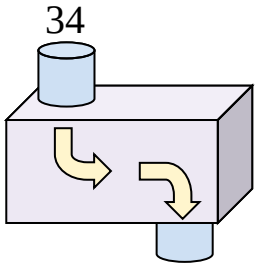

Sottrai 22

4)

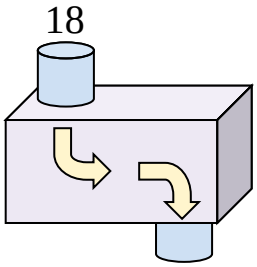

Sottrai 8

5)

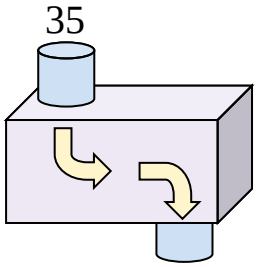

Sottrai 6

6)

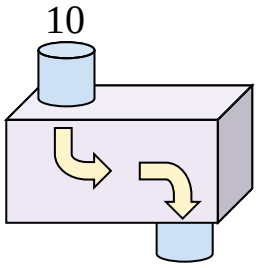

Aggiungi 23

7)

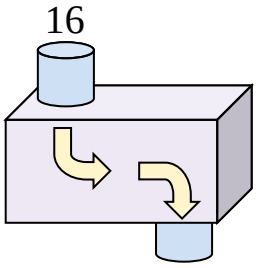

Aggiungi 20

8)

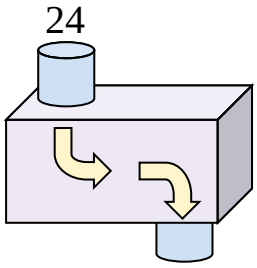

Aggiungi 24

9)

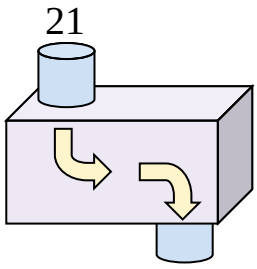

Aggiungi 26

10)

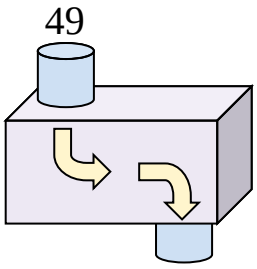

Sottrai 31

11)

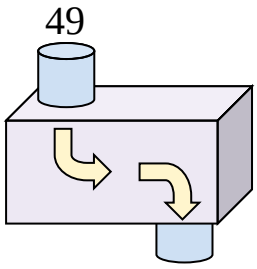

Sottrai 31

Risposte

Es. Sottrai 17
1. Aggiungi 20
2. Aggiungi 15
3. Sottrai 22
4. Sottrai 8
5. Sottrai 6
6. Aggiungi 23
7. Aggiungi 20
8. Aggiungi 24
9. Aggiungi 26
10. Sottrai 31
11. Sottrai 31

1-10	91	82	73	64	55	45	36	27	18	9
11	0									