Funzioni (Addizioni e sottrazioni) Nome:

Determina quale regola viene usata nelle seguenti funzioni.

Es)

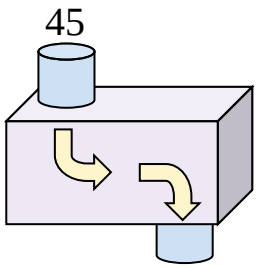

Sottrai 15

1)

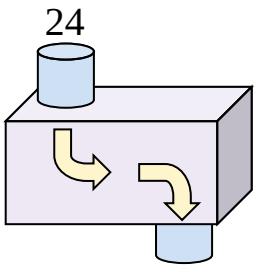

2)

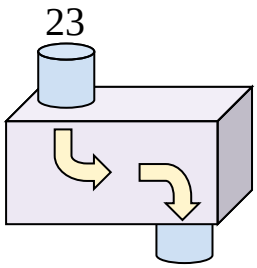

3)

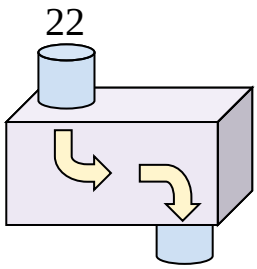

4)

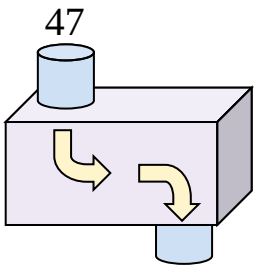

5)

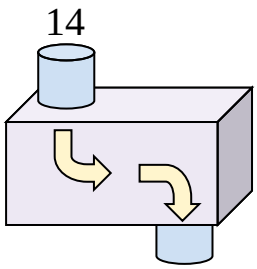

6)

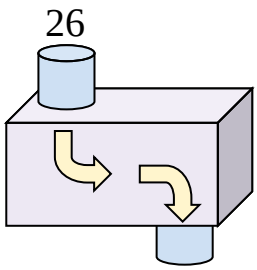

7)

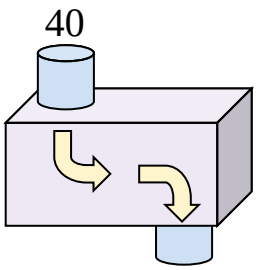

8)

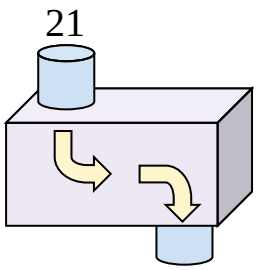

9)

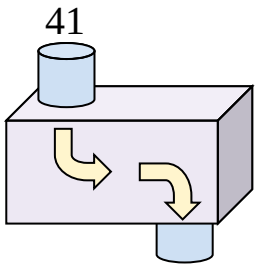

10)

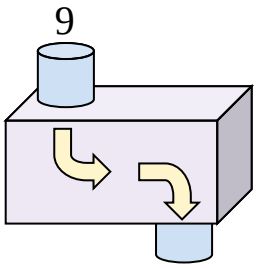

11)

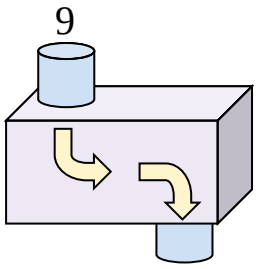

Risposte

Es. Sottrai 15

1. _____
2. _____
3. _____
4. _____
5. _____
6. _____
7. _____
8. _____
9. _____
10. _____
11. _____

1-10	91	82	73	64	55	45	36	27	18	9
11	0									

Determina quale regola viene usata nelle seguenti funzioni.

Es)

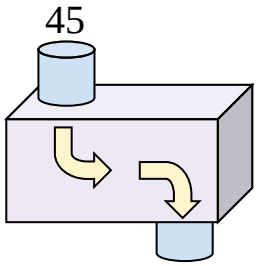

Sottrai 15

1)

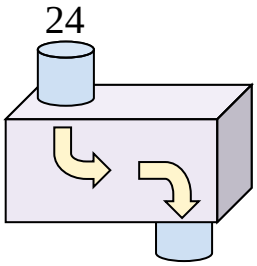

Aggiungi 20

2)

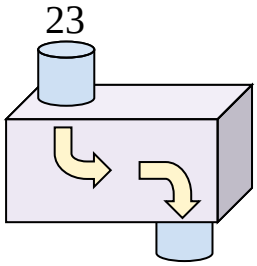

Aggiungi 15

3)

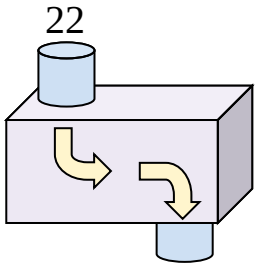

Sottrai 11

4)

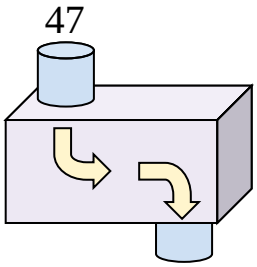

Sottrai 19

5)

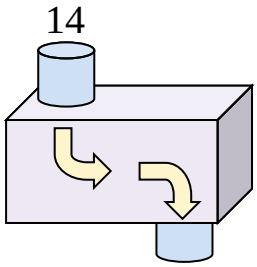

Aggiungi 36

6)

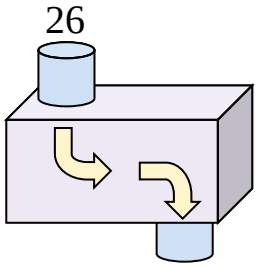

Aggiungi 17

7)

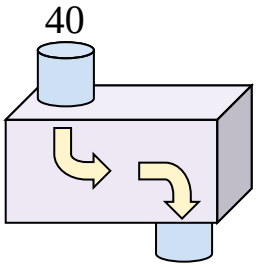

Sottrai 32

8)

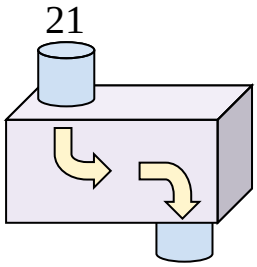

Sottrai 11

9)

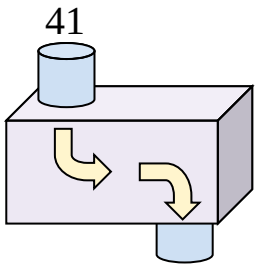

Sottrai 12

10)

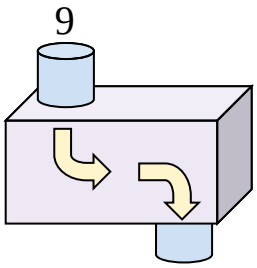

Aggiungi 17

11)

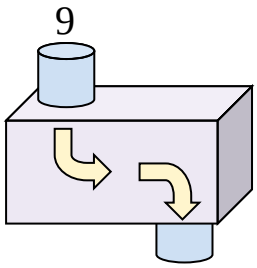

Aggiungi 17

Risposte

Es. Sottrai 15

1. Aggiungi 20
2. Aggiungi 15
3. Sottrai 11
4. Sottrai 19
5. Aggiungi 36
6. Aggiungi 17
7. Sottrai 32
8. Sottrai 11
9. Sottrai 12
10. Aggiungi 17
11. Aggiungi 17

1-10	91	82	73	64	55	45	36	27	18	9
11	0									