Funzioni (Addizioni e sottrazioni) Nome:

**Determina quale regola viene usata nelle seguenti funzioni.**

**Es)**

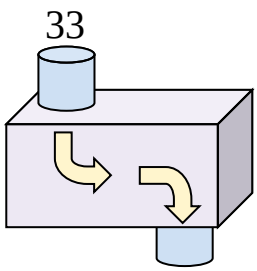


Sottrai 8

**1)**

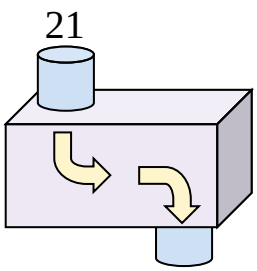


**2)**

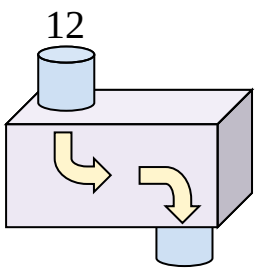


**3)**

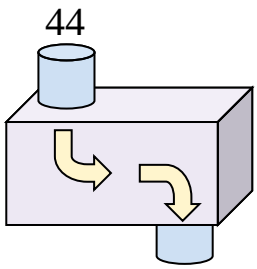


**4)**

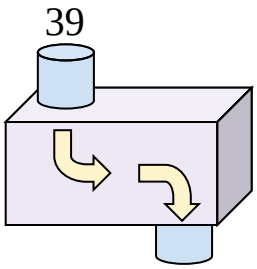


**5)**

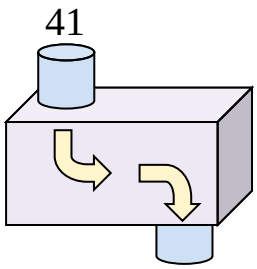


**6)**

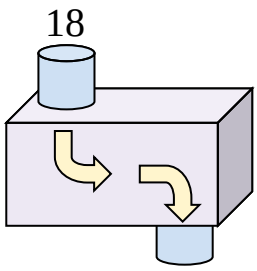


**7)**

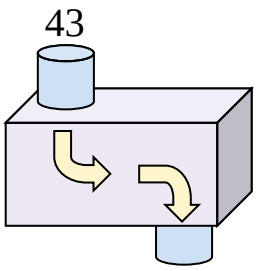


**8)**

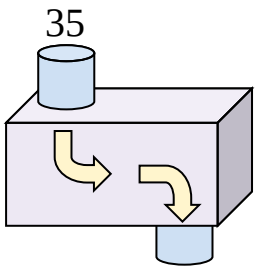


**9)**

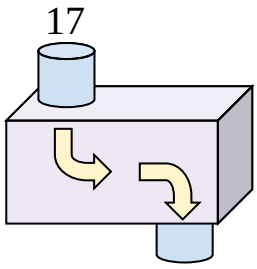


**10)**

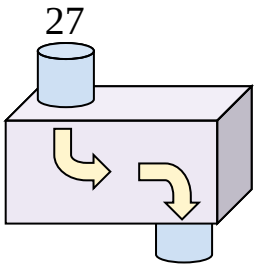


**11)**

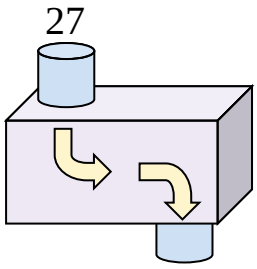


## Risposte

Es. Sottrai 8

1. _____
2. _____
3. _____
4. _____
5. _____
6. _____
7. _____
8. _____
9. _____
10. _____
11. _____



| | | | | | | | | | | |
|---|---|---|---|---|---|---|---|---|---|---|
| 1-10 | 91 | 82 | 73 | 64 | 55 | 45 | 36 | 27 | 18 | 9 |
| 11 | 0 | | | | | | | | | |

**Determina quale regola viene usata nelle seguenti funzioni.**

**Es)**

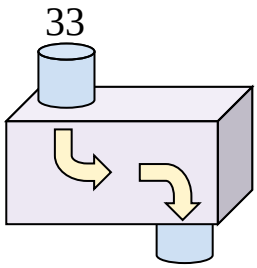


Sottrai 8

**1)**

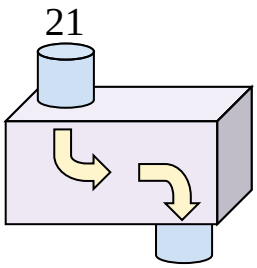


Aggiungi 14

**2)**

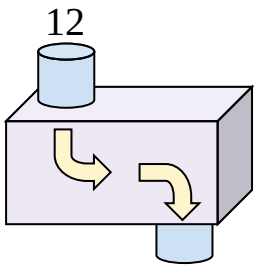


Aggiungi 26

**3)**

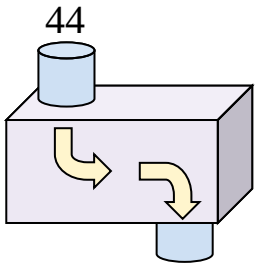


Sottrai 30

**4)**

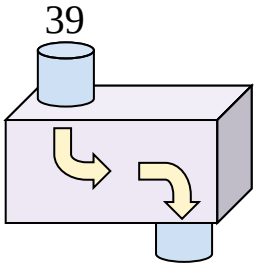


Sottrai 10

**5)**

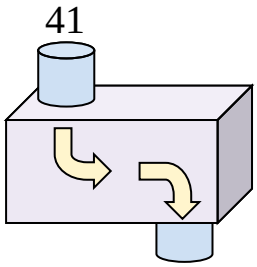


Sottrai 29

**6)**

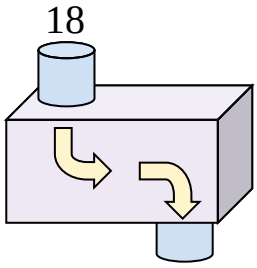


Aggiungi 13

**7)**

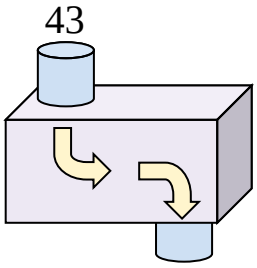


Sottrai 13

**8)**

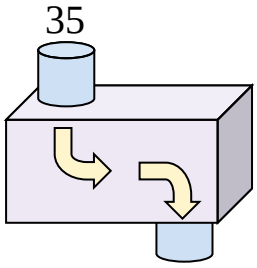


Sottrai 13

**9)**

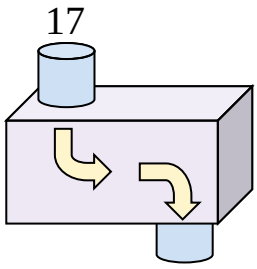


Aggiungi 22

**10)**

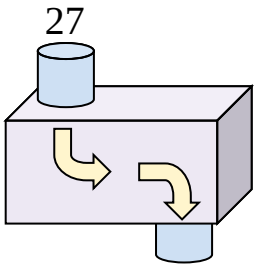


Aggiungi 23

**11)**

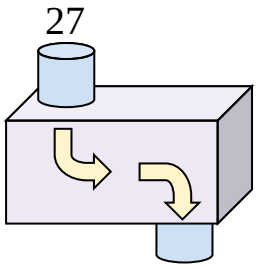


Aggiungi 23

## Risposte

Es. Sottrai 8
1. Aggiungi 14
2. Aggiungi 26
3. Sottrai 30
4. Sottrai 10
5. Sottrai 29
6. Aggiungi 13
7. Sottrai 13
8. Sottrai 13
9. Aggiungi 22
10. Aggiungi 23
11. Aggiungi 23



| | | | | | | | | | | |
|---|---|---|---|---|---|---|---|---|---|---|
| 1-10 | 91 | 82 | 73 | 64 | 55 | 45 | 36 | 27 | 18 | 9 |
| 11 | 0 | | | | | | | | | |