Riscrivi le moltiplicazioni (graficamente) Nome:

Scrivi ogni blocco sotto forma di moltiplicazione e calcola il risultato.

Es) 

1) 

2)

3) 

4) 

5)

6)

7)

8) 

9) 

10) 

11)

Risposte

Es. 7 × 2 = 14

1. _____
2. _____
3. _____
4. _____
5. _____
6. _____
7. _____
8. _____
9. _____
10. _____
11. _____

1-10	91	82	73	64	55	45	36	27	18	9
11	0									

Riscrivi le moltiplicazioni (graficamente) Nome: **Soluzioni**

Scrivi ogni blocco sotto forma di moltiplicazione e calcola il risultato.

Es) 

1) 

2)

3) 

4) 

5)

6)

7)

8) 

9) 

10) 

11)

Risposte

Es. 7 × 2 = 14

1. 4 × 5 = 20
2. 3 × 9 = 27
3. 8 × 5 = 40
4. 6 × 8 = 48
5. 8 × 4 = 32
6. 6 × 2 = 12
7. 2 × 9 = 18
8. 9 × 6 = 54
9. 8 × 10 = 80
10. 4 × 9 = 36
11. 6 × 3 = 18

1-10	91	82	73	64	55	45	36	27	18	9
11	0									