Riscrivi le moltiplicazioni (graficamente) Nome:

Scrivi ogni blocco sotto forma di moltiplicazione e calcola il risultato.

Es) 

1) 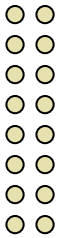

2)

3) 

4)

5) 

6)

7)

8)

9) 

10)

11)

Risposte

Es. 7 × 9 = 63

1. _____
2. _____
3. _____
4. _____
5. _____
6. _____
7. _____
8. _____
9. _____
10. _____
11. _____

1-10	91	82	73	64	55	45	36	27	18	9
11	0									

Riscrivi le moltiplicazioni (graficamente) Nome: **Soluzioni**

Scrivi ogni blocco sotto forma di moltiplicazione e calcola il risultato.

Es) 

1) 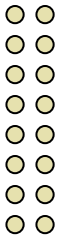

2)

3) 

4)

5) 

6)

7)

8)

9) 

10)

11)

Risposte

Es. 7 × 9 = 63

1. 8 × 2 = 16
2. 7 × 3 = 21
3. 10 × 7 = 70
4. 6 × 4 = 24
5. 9 × 8 = 72
6. 3 × 5 = 15
7. 3 × 3 = 9
8. 5 × 4 = 20
9. 5 × 7 = 35
10. 3 × 2 = 6
11. 3 × 9 = 27

1-10	91	82	73	64	55	45	36	27	18	9
11	0									