Riscrivi le moltiplicazioni (graficamente) Nome:

Scrivi ogni blocco sotto forma di moltiplicazione e calcola il risultato.

Es) 

1) 

2)

3) 

4) 

5)

6) 

7)

8)

9) 

10) 

11) 

Risposte

Es. 6 × 4 = 24

1. _____
2. _____
3. _____
4. _____
5. _____
6. _____
7. _____
8. _____
9. _____
10. _____
11. _____

1-10	91	82	73	64	55	45	36	27	18	9
11	0									

Riscrivi le moltiplicazioni (graficamente) Nome: **Soluzioni**

Scrivi ogni blocco sotto forma di moltiplicazione e calcola il risultato.

Es) 

1) 

2)

3) 

4) 

5)

6) 

7)

8)

9) 

10) 

11) 

Risposte

Es. 6 × 4 = 24

1. 3 × 10 = 30
2. 6 × 10 = 60
3. 9 × 10 = 90
4. 10 × 9 = 90
5. 2 × 4 = 8
6. 6 × 8 = 48
7. 4 × 4 = 16
8. 2 × 10 = 20
9. 5 × 2 = 10
10. 2 × 9 = 18
11. 7 × 6 = 42

1-10	91	82	73	64	55	45	36	27	18	9
11	0									