Riscrivi le moltiplicazioni (graficamente) Nome:

Scrivi ogni blocco sotto forma di moltiplicazione e calcola il risultato.

Es) 

1) 

2)

3) 

4)

5)

6)

7)

8)

9) 

10) 

11)

Risposte

Es. 8 × 3 = 24

1. _____
2. _____
3. _____
4. _____
5. _____
6. _____
7. _____
8. _____
9. _____
10. _____
11. _____

1-10	91	82	73	64	55	45	36	27	18	9
11	0									

Riscrivi le moltiplicazioni (graficamente) Nome: **Soluzioni**

Scrivi ogni blocco sotto forma di moltiplicazione e calcola il risultato.

Es) 

1) 

2)

3) 

4)

5)

6)

7)

8)

9) 

10) 

11)

Risposte

Es. 8 × 3 = 24

1. 8 × 8 = 64
2. 6 × 3 = 18
3. 7 × 4 = 28
4. 10 × 2 = 20
5. 2 × 8 = 16
6. 6 × 7 = 42
7. 7 × 5 = 35
8. 4 × 3 = 12
9. 10 × 6 = 60
10. 10 × 4 = 40
11. 6 × 4 = 24

1-10	91	82	73	64	55	45	36	27	18	9
11	0									