Riscrivi le moltiplicazioni (graficamente) Nome:

Scrivi ogni blocco sotto forma di moltiplicazione e calcola il risultato.

Es)

1) 

2) 

3) 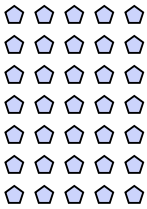

4) 

5)

6) 

7)

8)

9) 

10) 

11) 

Risposte

Es. 3 × 2 = 6

1. _____
2. _____
3. _____
4. _____
5. _____
6. _____
7. _____
8. _____
9. _____
10. _____
11. _____

1-10	91	82	73	64	55	45	36	27	18	9
11	0									

Riscrivi le moltiplicazioni (graficamente) Nome: **Soluzioni**

Scrivi ogni blocco sotto forma di moltiplicazione e calcola il risultato.

Es)

1) 

2) 

3) 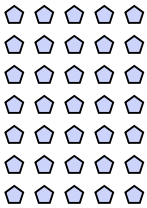

4) 

5)

6) 

7)

8)

9) 

10) 

11) 

Risposte

Es. 3 × 2 = 6

1. 6 × 2 = 12
2. 9 × 10 = 90
3. 7 × 5 = 35
4. 8 × 5 = 40
5. 10 × 6 = 60
6. 10 × 9 = 90
7. 4 × 7 = 28
8. 7 × 4 = 28
9. 6 × 7 = 42
10. 9 × 4 = 36
11. 7 × 7 = 49

1-10	91	82	73	64	55	45	36	27	18	9
11	0									