Riscrivi le moltiplicazioni (graficamente) Nome:

Scrivi ogni blocco sotto forma di moltiplicazione e calcola il risultato.

Es)



1)



2)

3)

4)

5)



6)



7)

8)

9)



10)

11)

Risposte

Es. 10 × 6 = 60

1. _____
2. _____
3. _____
4. _____
5. _____
6. _____
7. _____
8. _____
9. _____
10. _____
11. _____

1-10	91	82	73	64	55	45	36	27	18	9
11	0									

Riscrivi le moltiplicazioni (graficamente) Nome: **Soluzioni**

Scrivi ogni blocco sotto forma di moltiplicazione e calcola il risultato.

Es) 

1) 

2)

3)

4)

5) 

6) 

7)

8)

9) 

10)

11)

Risposte

Es. 10 × 6 = 60

1. 10 × 9 = 90
2. 2 × 5 = 10
3. 4 × 5 = 20
4. 2 × 6 = 12
5. 7 × 7 = 49
6. 4 × 6 = 24
7. 9 × 8 = 72
8. 6 × 3 = 18
9. 7 × 4 = 28
10. 3 × 2 = 6
11. 2 × 7 = 14

1-10	91	82	73	64	55	45	36	27	18	9
11	0									