Moltiplicazioni con la linea numerata

Nome:

Usa la linea numerata per risolvere ogni operazione.

1) 2 × 9 =
9 × 2 =

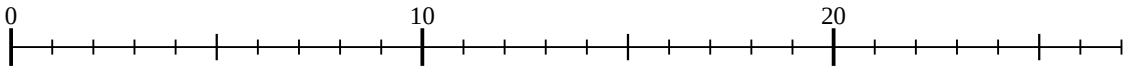

2) 3 × 4 =
4 × 3 =

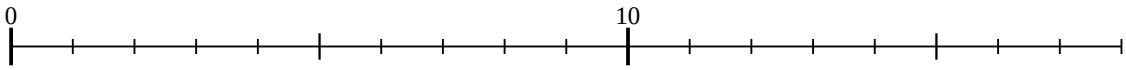

3) 3 × 8 =
8 × 3 =

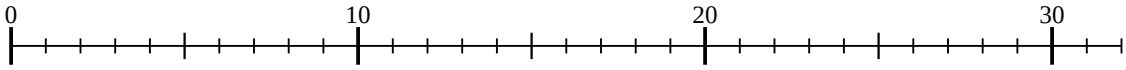

4) 2 × 8 =
8 × 2 =

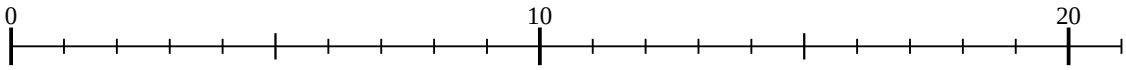

5) 5 × 4 =
4 × 5 =

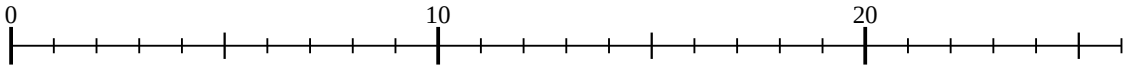

6) 3 × 9 =
9 × 3 =

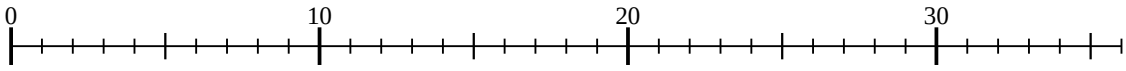

7) 3 × 2 =
2 × 3 =

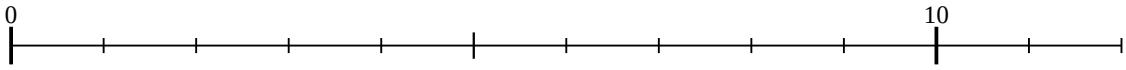

8) 2 × 4 =
4 × 2 =

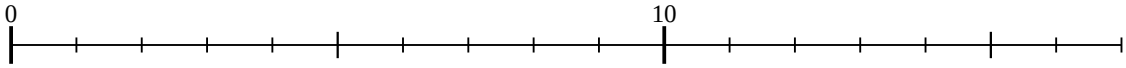

9) 5 × 9 =
9 × 5 =

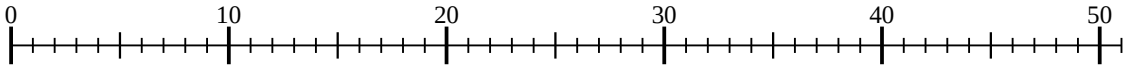

10) 3 × 5 =
5 × 3 =

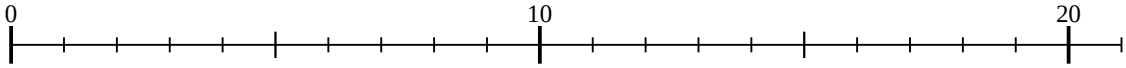

11) 2 × 2 =
2 × 2 =



Risposte

1. _____
2. _____
3. _____
4. _____
5. _____
6. _____
7. _____
8. _____
9. _____
10. _____
11. _____

Moltiplicazioni con la linea numerata Nome: **Soluzioni**

Usa la linea numerata per risolvere ogni operazione.

1) 2 × 9 =
9 × 2 =

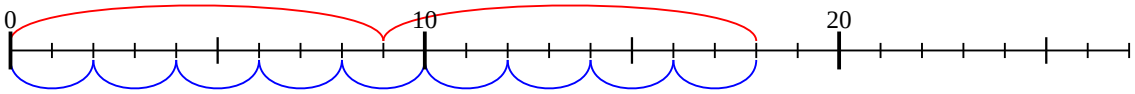

2) 3 × 4 =
4 × 3 =

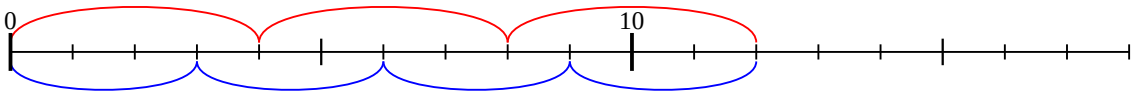

3) 3 × 8 =
8 × 3 =

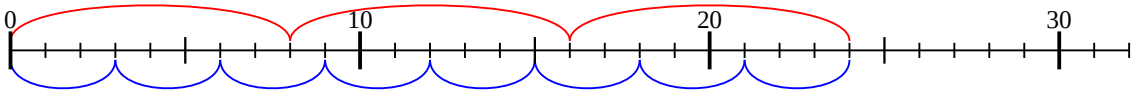

4) 2 × 8 =
8 × 2 =

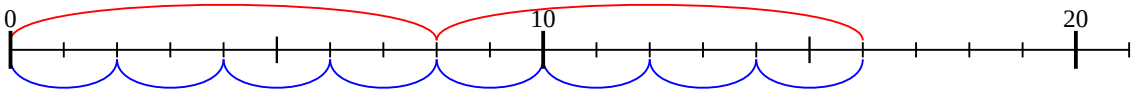

5) 5 × 4 =
4 × 5 =

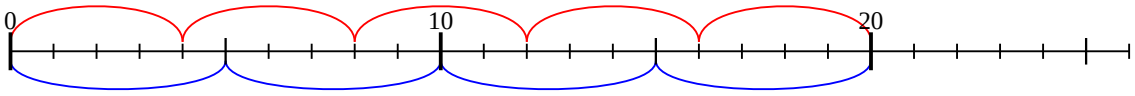

6) 3 × 9 =
9 × 3 =

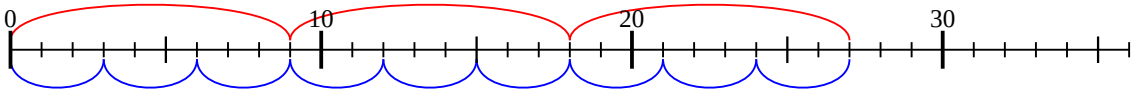

7) 3 × 2 =
2 × 3 =

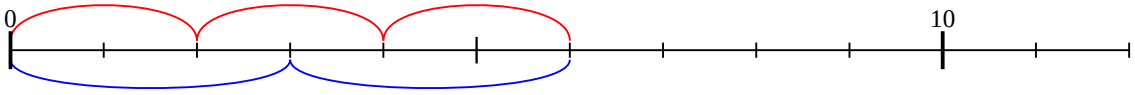

8) 2 × 4 =
4 × 2 =

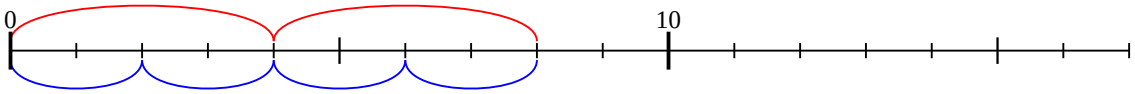

9) 5 × 9 =
9 × 5 =

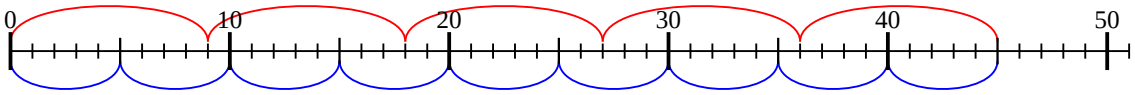

10) 3 × 5 =
5 × 3 =

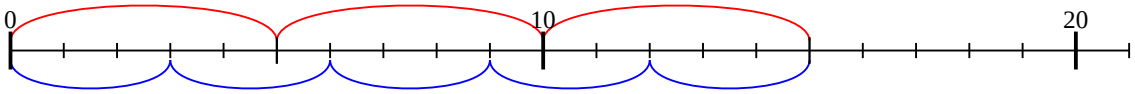

11) 2 × 2 =
2 × 2 =

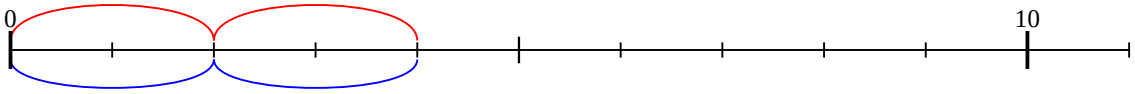

Risposte

1. **18**
2. **12**
3. **24**
4. **16**
5. **20**
6. **27**
7. **6**
8. **8**
9. **45**
10. **15**
11. **4**