Moltiplicazioni con la linea numerata

Nome:

Usa la linea numerata per risolvere ogni operazione.

1) 5 × 6 =

6 × 5 =

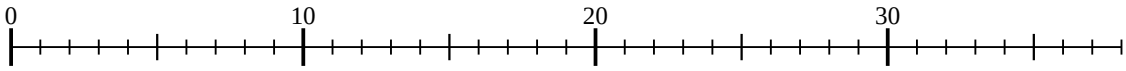

2) 2 × 4 =

4 × 2 =



3) 2 × 3 =

3 × 2 =

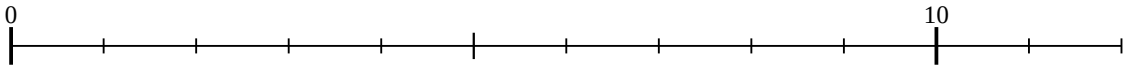

4) 4 × 5 =

5 × 4 =

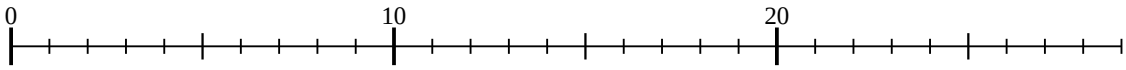

5) 3 × 4 =

4 × 3 =

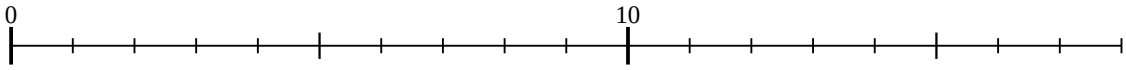

6) 2 × 8 =

8 × 2 =

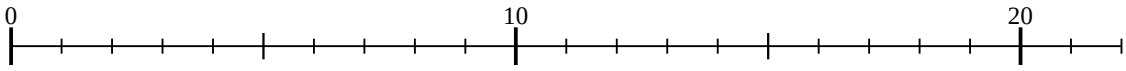

7) 2 × 7 =

7 × 2 =

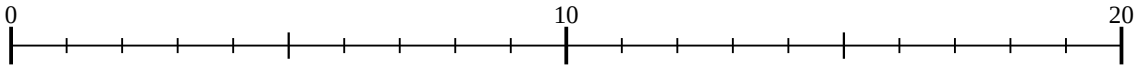

8) 4 × 2 =

2 × 4 =

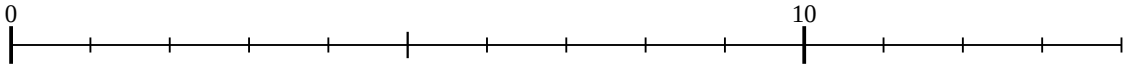

9) 3 × 8 =

8 × 3 =

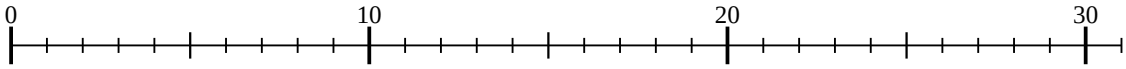

10) 2 × 6 =

6 × 2 =

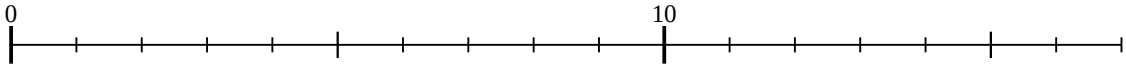

11) 3 × 5 =

5 × 3 =

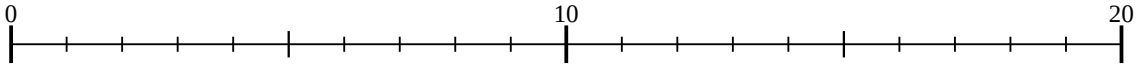

Risposte

1. _____
2. _____
3. _____
4. _____
5. _____
6. _____
7. _____
8. _____
9. _____
10. _____
11. _____

Moltiplicazioni con la linea numerata Nome: **Soluzioni**

Usa la linea numerata per risolvere ogni operazione.

1) 5 × 6 =
6 × 5 =

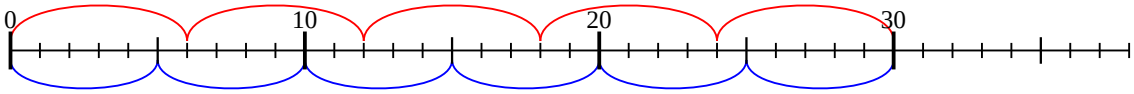

2) 2 × 4 =
4 × 2 =

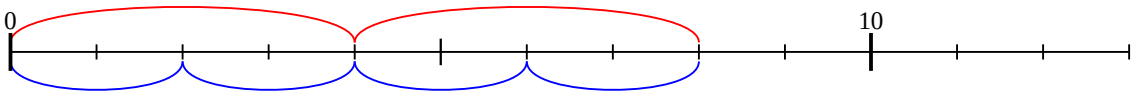

3) 2 × 3 =
3 × 2 =

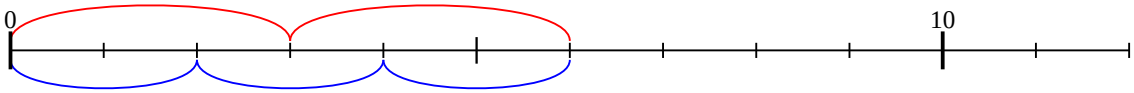

4) 4 × 5 =
5 × 4 =

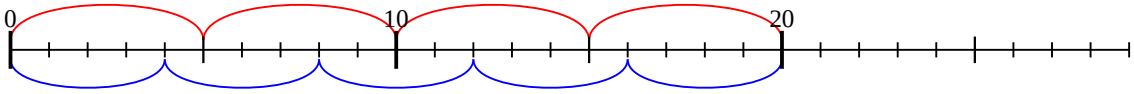

5) 3 × 4 =
4 × 3 =

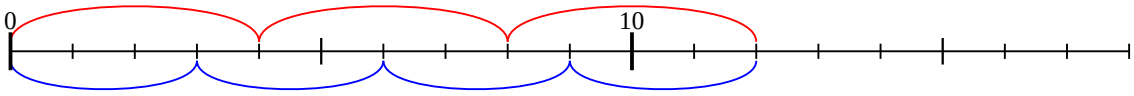

6) 2 × 8 =
8 × 2 =

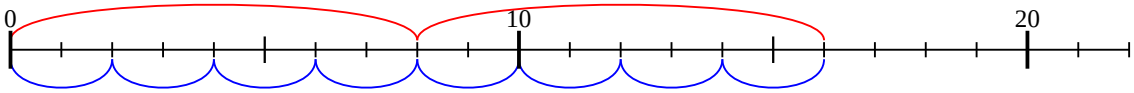

7) 2 × 7 =
7 × 2 =

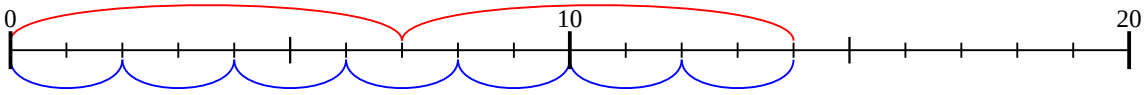

8) 4 × 2 =
2 × 4 =

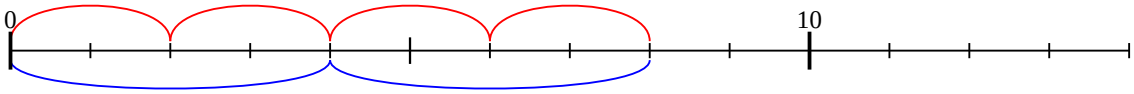

9) 3 × 8 =
8 × 3 =

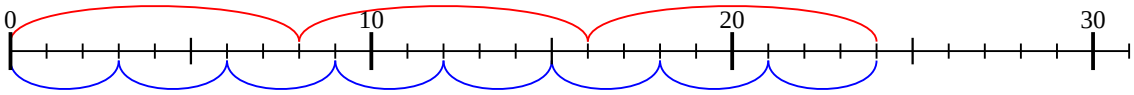

10) 2 × 6 =
6 × 2 =

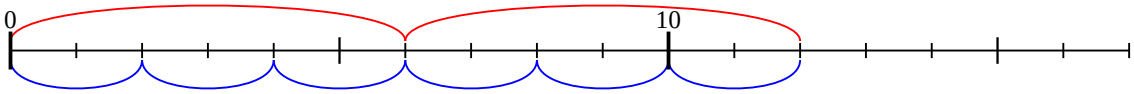

11) 3 × 5 =
5 × 3 =

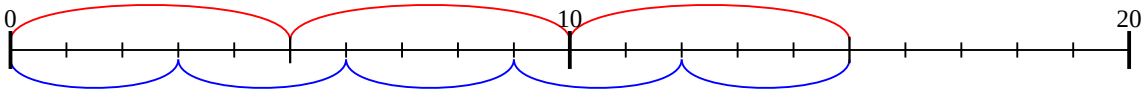

Risposte

1. **30**
2. **8**
3. **6**
4. **20**
5. **12**
6. **16**
7. **14**
8. **8**
9. **24**
10. **12**
11. **15**