Moltiplicazioni con la linea numerata

Nome:

Usa la linea numerata per risolvere ogni operazione.

1) 3 × 10 =

10 × 3 =

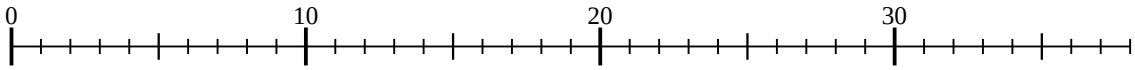

2) 3 × 6 =

6 × 3 =

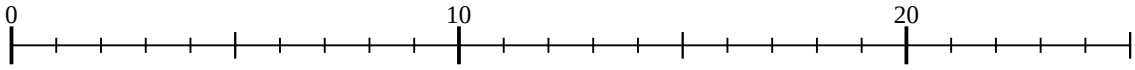

3) 5 × 9 =

9 × 5 =

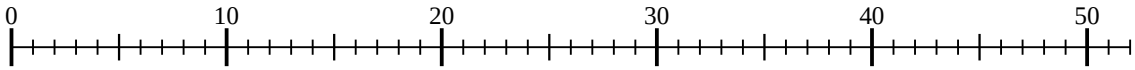

4) 2 × 5 =

5 × 2 =

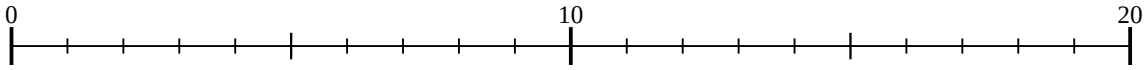

5) 4 × 5 =

5 × 4 =

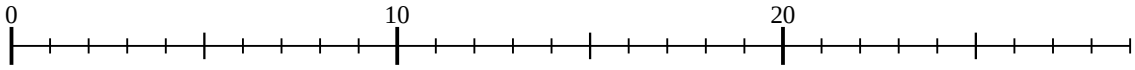

6) 2 × 7 =

7 × 2 =

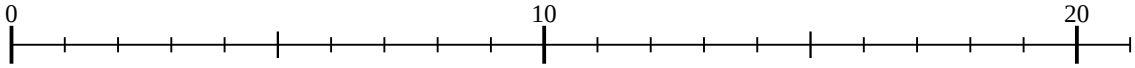

7) 3 × 9 =

9 × 3 =

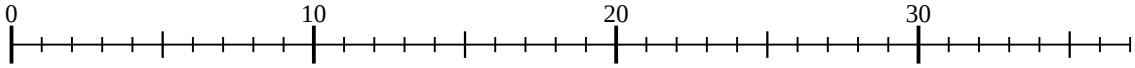

8) 2 × 2 =

2 × 2 =

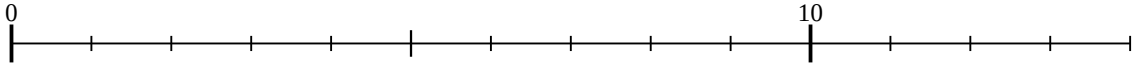

9) 4 × 6 =

6 × 4 =

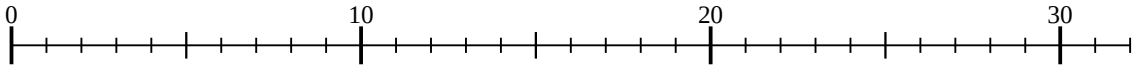

10) 4 × 4 =

4 × 4 =

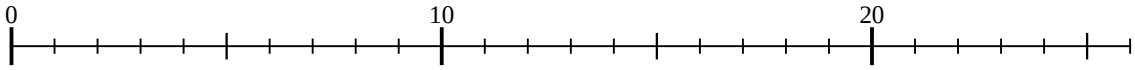

11) 5 × 4 =

4 × 5 =

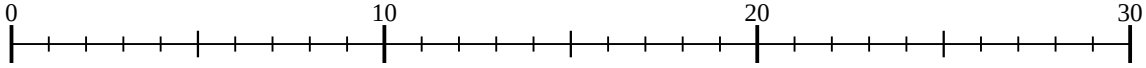

Risposte

1. _____
2. _____
3. _____
4. _____
5. _____
6. _____
7. _____
8. _____
9. _____
10. _____
11. _____

1-10	91	82	73	64	55	45	36	27	18	9
11	0									

Moltiplicazioni con la linea numerata

Nome: **Soluzioni**

Usa la linea numerata per risolvere ogni operazione.

1) 3 × 10 =
10 × 3 =

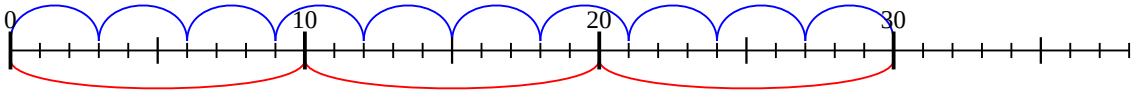

2) 3 × 6 =
6 × 3 =

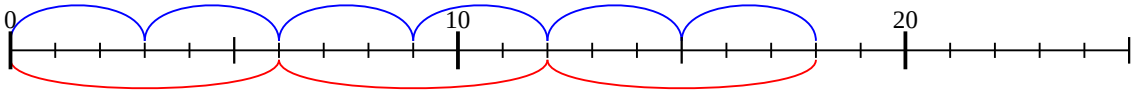

3) 5 × 9 =
9 × 5 =

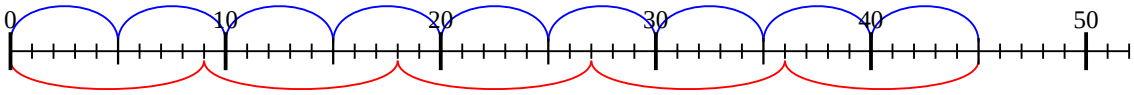

4) 2 × 5 =
5 × 2 =

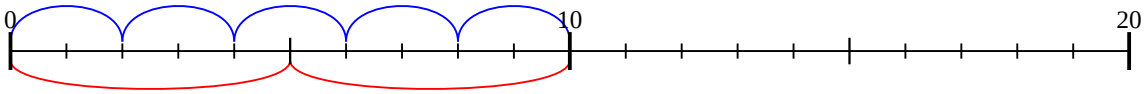

5) 4 × 5 =
5 × 4 =

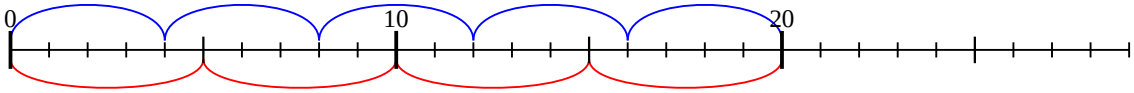

6) 2 × 7 =
7 × 2 =

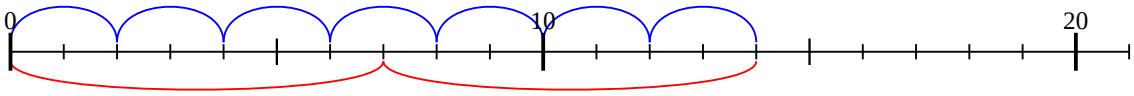

7) 3 × 9 =
9 × 3 =

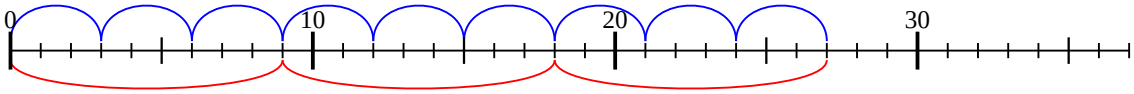

8) 2 × 2 =
2 × 2 =

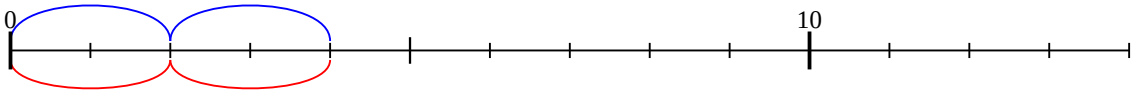

9) 4 × 6 =
6 × 4 =

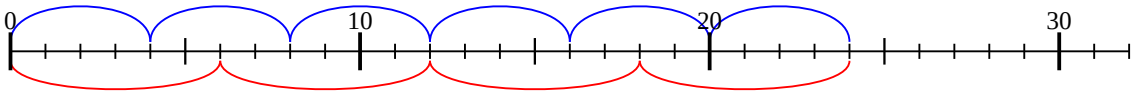

10) 4 × 4 =
4 × 4 =

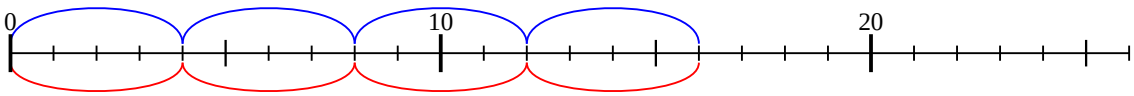

11) 5 × 4 =
4 × 5 =

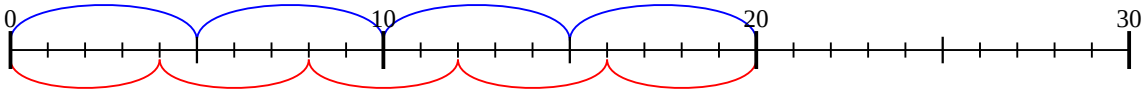

Risposte

1. **30**
2. **18**
3. **45**
4. **10**
5. **20**
6. **14**
7. **27**
8. **4**
9. **24**
10. **16**
11. **20**

1-10	91	82	73	64	55	45	36	27	18	9
11	0									